THE TOMB OF THE PHARAOH: TEACHER GUIDE

Teacher Guide: The Tomb of the Pharaoh Escape Unit

Facilitator Mission Brief & Setup Guide



This classroom escape activity immerses students in the archaeology and funerary practices of New Kingdom Ancient Egypt. Working in collaborative investigation teams of 3 to 5, students must solve three progressive historical puzzle locks to uncover the royal seal and safely open the burial antechamber before their oil lamps expire. The challenge requires curriculum-aligned knowledge of hieroglyphic phonetic biliterals, the four Sons of Horus canopic markers, and the dynastic chronology of the Eighteenth Dynasty.

- **Recommended duration:** 45 to 60 minutes for upper primary or secondary history classes.
- **Team grouping:** 3–5 students per expedition crew with designated roles (Scribe, Cartographer, Chronologist, Quartermaster).
- **Setup requirement:** Print one dossier packet per team containing Clue Sheets 1, 2, and 3 along with the official Antechamber Decryption Sheet.
- **Facilitator role:** Validate team lock submissions sequentially. Offer one hint per phase only after teams exhaust internal primary-text verification.

Facilitator Preparation Note

No physical padlocks are required. The activity operates using verified text-and-numerical verification keys entered on the student record sheet and approved by the teacher.

1 Step 1: Crew Briefing & Material Handout



Distribute the team dossier, explain the narrative context set in the Valley of the Kings, and establish the 45-minute countdown.

2 Step 2: Phase Gatekeeping



Review Lock 1 (Cartouche Decryption) before releasing teams to Lock 2 (Canopic Alignment), ensuring students demonstrate correct phoneme matching.

3 Step 3: Antechamber Seal Verification



Validate the final three-digit numerical dynasty code derived from the royal lineage tree to declare the tomb successfully unlocked.

Name: _____

Expedition Locks 1 & 2: Cartouche & Canopic Puzzles

Class: _____

Date: _____

Lock 1: The Scribe's Royal Cartouche Decipherment

Upon clearing the rubble from the subterranean entrance, your expedition encounters a sealed limestone lintel bearing an inscribed royal cartouche and a cryptic warning from the chief embalmer. Decipher the glyphs using the provided phonetic key and analyze the priestly inscription to isolate the master ceremonial word required to disengage the stone bolt.



Hieroglyphic Sign Key

Hieroglyphic Sign A (Reeds / Sun disk): Associated with Ra / Amun solar veneration.
Hieroglyphic Sign B (Water ripple): Represents the consonant 'N'.
Hieroglyphic Sign C (Folded cloth): Represents the consonant 'S'.
Hieroglyphic Sign D (Plinth / Stool): Represents the consonant 'P'.

Lintel Inscription: *'Only the truth of Ma'at weighs equal to the feather; speak the name of the cosmic order to turn the outer mechanism.'*

Decryption Rule

Transcribe the four cartouche symbols letter by letter, then match the resulting epithet to the protective goddess of truth and balance.



Steps

1. **Analyze the Symbols**
   Correlate each glyph on the stone lintel with the scribe's phonetic reference tablet.
2. **Deduce the Keyword**
   Assemble the phonetic string and verify whether the meaning matches truth, balance, or cosmic order (MAAT).

Decoded Cartouche Phonetic String:

_____

Identified Protective Concept / Keyword for Lock 1:

_____

Lock 2: The Embalmer's Canopic Jar Alignment

Entering the transition chamber, you discover four carved limestone canopic jars guarded by the four Sons of Horus. The secondary heavy cedar door will only unlock when each internal organ is accurately paired with its divine protector, head form, and cardinal direction as recorded in the Book of the Dead.

- Imsety: Human-headed deity, protector of the liver, aligned with the South.
- Duamutef: Jackal-headed deity, protector of the stomach, aligned with the East.
- Hapi: Baboon-headed deity, protector of the lungs, aligned with the North.
- Qebehsenuef: Falcon-headed deity, protector of the intestines, aligned with the West.



Alignment Warning

A single misplaced jar resets the mechanical counterweight. Ensure both organ and compass quadrant align precisely before recording the directional code.

Does your compiled sequence place the protector of the lungs at the North origin?

- ✓ Yes, Hapi is positioned at North with lungs assigned.
  Proceed to record the four-letter cardinal direction sequence into the master door mechanism.
- ✗ No, an alternate deity is listed at North.
  Recheck the funerary scrolls; baboon-headed Hapi must govern the northern station.

Imsety: Organ Protected & Compass Bearing: _____

Duamutef: Organ Protected & Compass Bearing: _____

Hapi: Organ Protected & Compass Bearing: _____

Qebehsenuef: Organ Protected & Compass Bearing: _____

Compiled Directional Sequence (Clockwise from North: N-E-S-W):

_____

Expeditn Lock 3 & Master Facilitator Key

Name: _____ Class: _____ Date: _____

Lock 3: The Royal Dynasty Lineage & Final Tomb Seal

Before the golden gates of the inner antechamber stands a granite stela bearing an Eighteenth Dynasty genealogical chart. A numerical lock dial requires the exact three-digit succession key: the regnal index of the pharaoh who unified the kingdom under Amun, followed by the generation count between Queen Hatshepsut and King Tutankhamun.

- **Chronology Record 1:** Ahmose I founds the Eighteenth Dynasty by expelling the Hyksos (Dynasty Index = 1).
- **Chronology Record 2:** Hatshepsut reigns as co-regent and pharaoh during the peak trade era of the dynasty (Position = 5).
- **Chronology Record 3:** Thutmose III expands the empire to the Euphrates (Position = 6).
- **Chronology Record 4:** Akhenaten establishes the Amarna heresy worshipping the Aten (Position = 10).
- **Chronology Record 5:** Tutankhamun restores the traditional pantheon at Thebes (Position = 12).



Final Numerical Cipher Formula

Digit 1 = Ahmose I dynasty position (1).
Digit 2 = Generation steps between Hatshepsut (5) and Akhenaten (10) [10 minus 5 = 5].
Digit 3 = Difference between Tutankhamun (12) and Akhenaten (10) [12 minus 10 = 2].

1 **Calculate the Succession Offsets**
Follow the formula inscribed on the granite stela to derive the three single-digit dial values.

2 **Enter the Master Vault Code**
Synthesize the three locks: Word of Truth (Lock 1), Cardinal Sequence (Lock 2), and Numerical Key (Lock 3).

Calculated Three-Digit Lineage Code: _____

Master Vault Solution (Lock 1 Word + Lock 2 Sequence + Lock 3 Code):

_____

_____

Facilitator Master Answer Key & Diagnostic Rubric

Complete solution parameters and evaluation standards for the facilitator to review student performance and historical reasoning.

- **Lock 1 Solution:** Decoded Cartouche string translates to 'M-A-A-T'. Identified concept is MA'AT (Truth, Balance, and Cosmic Order).
- **Lock 2 Solution:** Imsety (Liver, South), Duamutef (Stomach, East), Hapi (Lungs, North), Qebehsenuef (Intestines, West). Clockwise sequence from North: HAPI (N) -> DUAMUTEF (E) -> IMSETY (S) -> QEBEHSENUEF (W). Direction code: N-E-S-W.
- **Lock 3 Solution:** Digit 1 = 1; Digit 2 = 5 (10 - 5); Digit 3 = 2 (12 - 10). Three-digit numerical code: 1-5-2.
- **Master Antechamber Key:** MAAT / N-E-S-W / 1-5-2.



Imsety (Liver) South | **Duamutef** (Stomach) East | **Hapi** (Lungs) North | **Qebehsenuef** (Intestines) West



Educational Assessment Objective

Verify that students articulate why each canopic deity guarded a specific organ and demonstrate understanding of how Eighteenth Dynasty dynastic transitions reshaped Egyptian political and religious identity.

Labyrinth of Knossos: The Minoan Palace Intrigue

Name: _____ Class: _____ Date: _____

Unit Briefing & Historical Context

Set in Late Bronze Age Crete (c. 1450 BCE), this escape challenge places student investigation teams inside the sprawling Palace of Knossos. As diplomatic scribes visiting from Mycenae, students are locked within the domestic quarters and central court storage magazines during an unexpected palace emergency. To unlock the palace gates, students must solve three sequential historical problems: mapping a secure route through the multi-storey architectural complex, ordering ceramic storage vessels using relative stratigraphy and pottery styles, and transliterating administrative inventory tablets written in Linear Script. The exercise develops analytical deduction, source evaluation, and spatial reasoning aligned with curriculum standards for Bronze Age Mediterranean societies.

- Designed for student teams of 3 to 5 players.
- Target completion window: 45 to 60 minutes.
- Integrates archeaological deduction without requiring prior factual mastery.

Historical Context Note

The archeeological site of Knossos was excavated extensively by Sir Arthur Evans in the early twentieth century. Students work with realistic architectural layout plans, genuine stylistic periods (Kamares Ware, Marine Style, and Palace Style), and phonetic syllabograms derived from Linear B palace records.



Ruins of the Palace of Knossos

Facilitator Preparation & Setup Guide

This guide provides educators with step-by-step instructions for running the activity smoothly in a standard classroom setting. No complex locks or physical lockboxes are required; station envelopes, folder-based clue packets, or digital verification forms may be used interchangeably.

- Print one copy of Pages 2 and 3 for each student team.
- Cut apart or keep intact Station Clues A, B, and C as desired.
- Prepare one facilitator answer verification station at the teacher desk.

Facilitator Strategy

If a team reaches a dead end, offer one hint token per station. Discourage blind guessing on Linear syllabic decipherment by requiring written phonetic workings on the Master Log sheet.

1 Step 1: Assembly and Grouping



Divide the class into investigative teams of 3 to 5 students. Hand each group the Challenge Briefing, Master Deduction Sheet, and the three Station Clue Sheets.

2 Step 2: Room Staging



Architectural Floor Plan | Ceramic Stratigraphy | Script Decryption

Designate three physical corners of the classroom as Station Alpha (Architectural Floor Plan), Station Beta (Ceramic Stratigraphy), and Station Gamma (Script Decryption), or allow teams to operate self-contained at cluster desks.

3 Step 3: Verification Checks



Teams submit their Master Escape Key string upon completing all three stations. Check against the Solution Key on Page 4 before confirming their successful palace exit.

Player Clue Stations: Floor Plan & Stratigraphy

Name: _____ Class: _____ Date: _____

Clue Station 1: The Multi-Storey Palace Floor Plan

Your team is trapped near the Grand Staircase of the Residential Quarter. The standard western corridor has collapsed, blocking passage to the West Court. You must trace an uninterrepted sequence of architectural chambers from the Queen's Megaron to the Northern Pillar Crypt to recover the bronze ceremonial key.

- **Rule 1:** Light wells illuminate passage; unlit magazines cannot be crossed without torches.
- **Rule 2:** You cannot step through ceremonial storage cists that remain sealed.
- **Rule 3:** Record the letter coordinate of each valid room along your path.

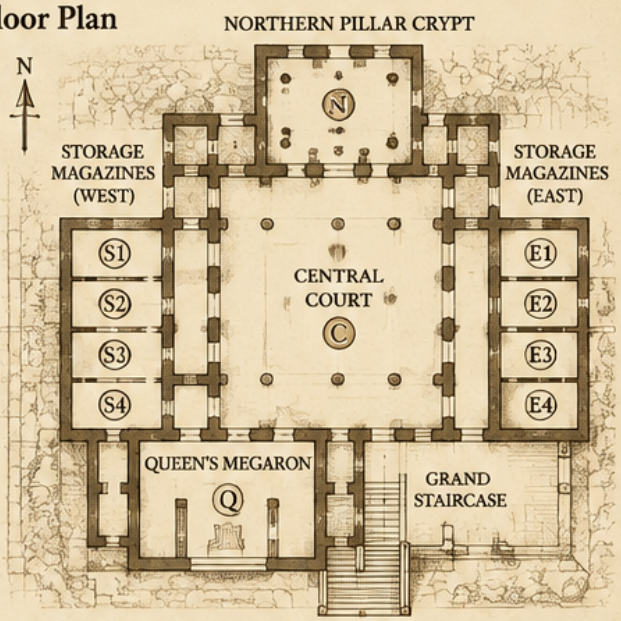

Architectural Deduction Hint

Look closely at doorway openings on the schematic grid. Thick double solid lines denote load-bearing ashlar masonry with no passage; parallel thin dashes indicate pierced pier-and-door partitions (polythyra).

Path Sequence Coordinate List (Enter 4 Room Identifiers)

_____, _____, _____, _____

Chamber Verification Code (Sum of numerical values marked in valid rooms)

_____

Did your plotted route cross through the West Storage Magazines?

- Route enters Western Magazine row directly
  Dead end: Massive storage pithoi block the narrow aisle. Reroute eastward through the Central Court.
- Route traverses the Central Court northward
  Correct path: Proceed directly through the Northern Propylaeum to reach Station 2.

Clue Station 2: Ceramic Sequence & Stratigraphic Dating

Inside the Northern Pillar Crypt, five ceramic vessels recovered from distinct stratigraphic layers sit on an inventory shelf. The doorway latch is governed by a chronological seal. You must arrange the five diagnostic vessel shards in correct relative chronological order from oldest (deepest stratum) to newest (surface stratum).

- **Vessel V-1:** Marine Style amphora with naturalistic octopus tentacles flowing over the vessel body.
- **Vessel V-2:** Early Kamares Ware cup featuring polychrome white and red spirals over a dark lustrous ground.
- **Vessel V-3:** Crude Middle Minoan storage pithos decorated with simple raised rope patterns.
- **Vessel V-4:** Palace Style three-handled jar displaying stylized, rigid heraldic plant motifs.
- **Vessel V-5:** Neolithic burnished monochrome bowl lacking painted decoration.

How to Solve

1. **Examine Stratum Context**
   Identify the depeest diagnostic horizon. Earliest pottery exhibits burnished hand-built surfaces prior to wheel use and polychrome glaze development.
2. **Track Stylistic Evolution**
   Polychrome geometric patterning precedes naturalistic marine life, which subsequently hardens into formal heraldic palace workshop production.
3. **Extract Numerical Cipher**
   Arrange vessel digits in order: [Oldest -> Newest]. The resulting 5-digit sequence provides the clearance combination for Station 2.



1 V-1 Marine Style amphora

2 V-2 Kamares Ware cup

3 V-3 Middle Minoan pithos

4 V-4 Palace Style jar

5 V-5 Noolithic bowl

Chronological Sequence Order (Vessel Numbers 1 to 5)

_____ _____

Stratigraphic Dating Justification Notes

_____

_____

_____

Decipherment Tablet & Master Team Log

Clue Station 3: Administrative Script Decipherment

A baked clay tablet fragment found resting against the door jamb holds an administrative tally needed to align the gate gears. The text is inscribed in the phonetic syllabary used for palatial bookkeeping. Use the provided syllabary reference key to transliterate the signs, determine the commodity counted, and calculate the final tally.



Linguistic Fact

Linear B script, deciphered by Michael Ventris in 1952, represents an archaic form of Mycenaean Greek used primarily for detailed palace bureaucratic tallies.

Syllabary Reference Key

Sign		Phonetic Value	Meaning
A		KO	—
B		NO	—
C		SO	—
D		OLIVE OIL (standard amphora (metric unit = 10 measures)	—
		Tally Marks	4 whole strokes + 1 half stroke

- Sign A matches phonetic value: KO.
- Sign B matches phonetic value: NO.
- Sign C matches phonetic value: SO.
- Ideogram D represents: OLIVE OIL (standard amphora metric unit = 10 measures).
- Fraction marks tally: 4 whole strokes and 1 half stroke.

Transliterated Palace Place Name
(Signs A + B + C) _____

Commodity Identified & Total
Calculated Metric Units _____

Final Decryption Keyword
(Place Name + Total Units) _____

Master Team Deduction & Exit Record

Enter your verified solutions from all three stations below. Present this completed master log sheet to the Palace Facilitator to confirm your successful escape from the Labyrinth of Knossos.

- Ensure all group members' names are legibly recorded.
- Double check arithmetic totals prior to submission.
- Penalty: Every incorrect code attempt adds 3 minutes to total team time.

1. Investigative Team Name & Assigned Scribes _____
2. Station 1 Path Coordinates & Chamber Verification Code _____
3. Station 2 Chronological Ceramic Sequence (5 Digits) _____
4. Station 3 Transliterated Place Name & Calculated Commodity Quantity _____
5. Master Escape Key String [Format: CODE1 - SEQ - KEYWORD] _____

Educator Master Answer Key & Debrief

Facilitator Solution Key & Scoring Matrix

FOR TEACHER REFERENCE ONLY. Keep this page separate from student working packets. Use these verified answers to validate team submissions, allocate points, and moderate debriefing discussions.

- **Full Completion Score:** 100 points.
- **Time Bonus:** 10 points for completion under 40 minutes.
- **Historical Accuracy Bonus:** 10 points for written ceramic justification.

Curricular Debrief Discussion Prompts

1. Why was Knossos perceived by later mainland Greeks as a terrifying labyrinth? (Complex multi-level architecture, maze-like storage corridors).
2. What do the clay tablets tell us about palatial administration vs. literary culture?

1 Station 1 Solution

Valid Room Path: Queen's Megaron (Chamber Q, Value 12) -> Hall of the Double Axes (Chamber H, Value 15) -> Grand Central Court (Chamber C, Value 20) -> Northern Pillar Crypt (Chamber N, Value 18).

Chamber Verification Code = 12 + 15 + 20 + 18 = 65.

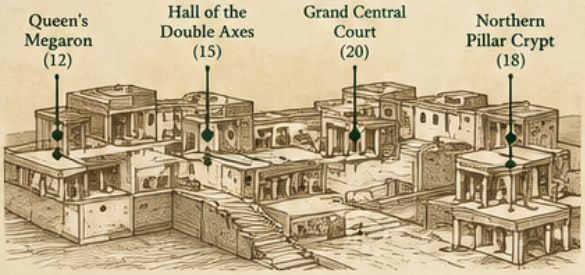

2 Station 2 Solution

Correct Chronological Ceramic Order: V-5 (Neolithic burnished) -> V-3 (Middle Minoan rope pithos) -> V-2 (Kamares Ware polychrome) -> V-1 (Marine Style naturalistic) -> V-4 (Palace Style heraldic).

Sequence Code: 5 - 3 - 2 - 1 - 4.



V-5 (Neolithic burnished) → V-3 (Middle Minoan rope pithos) → V-2 (Kamares Ware polychrome) → V-1 (Marine Style naturalistic) → V-4 (Palace Style heraldic)

3 Station 3 Solution

Transliterated Place Name: KO-NO-SO (Knossos).

Commodity: Olive Oil.

Tally: 4 whole strokes (4 x 10 = 40) + 1 half stroke (5) = 45 units.

Keyword: KNOSSOS-45.



KO - NO - SO (Knossos) → Olive Oil



4 x 10 = 40 + 5 = 45

Master Escape Key

Compiled Master String:

65-53214-KNOSSOS-45



Babylonian Court Challenge:
Facilitator Guide & Historical Briefing

Name: _____ Class: _____ Date: _____

Master Facilitator Guide & Classroom Deployment

This interactive classroom escape and court challenge immerses upper primary and secondary learners in the jurisprudence of the Old Babylonian Empire (c. 1750 BCE). Operating in small investigative panels of royal scribes and judges, students analyse reconstrated cuneiform tablet fragments, reconcile disputed commercial ledger claims, and calculate exact legal restitutions mandated under King Hammurabi's legal code.

- **Recommended Team Size:** 3 to 5 students per judicial council.
- **Target Completion Time:** 45 to 60 minutes across four procedural stages.
- **Primary Learning Goals:** Contextualise social hierarchy (Awilu, Mushkenu, Wardu), evaluate the proportionality principle of Lex Talionis, and perform multi-step historical mathematics using Babylonian weight standards (1 Mina = 60 Shekels).
- **Materials Required:** One Student Investigation Dossier per team, scratch paper for cuneiform glyph transcription, and writing styluses or pencils.

Facilitator Preparation & Setup Tip

Before class begins, ensure each council has access to the four tablet fragments and the official Babylonian conversion scale. If running as a physical escape room, distribute Part II only after teams verify their cuneiform decipherment key.

1. **Phase 1: Council Formation & Briefing**
   Divide the cohort into judicial benches. Distribute the historical introduction, social class hierarchy overview, and King Hammurabi's royal decree.
2. **Phase 2: Deciphering the Cuneiform Statutes**
   Direct students to translate numerical logograms and reconcile four fragmented clay tablet statutes detailing grain theff, irrigation negligence, and medical fees.
3. **Phase 3: The Merchant & Tenant Disputes**
   Facilitate analysis of three conflicting court dockets. Students must cross-reference witness testimonies against the transcribed legal articles to assess guilt and exact restitution.
4. **Phase 4: Sealed Verdict Verification**
   Compare student judgments and mathematical silver tallies against the master answer key to determine which benches uphold imperial justice.

Briefing Dossier: The Scales of Shamash

In the city-state of Sippar, under the watchful gaze of Shamash, the sun god and patron of justice, the King has established his laws to bring about the rule of righteousness in the land. As newly appointed judicial scribes of the royal palace, your council has been summoned to resolve an escalating civil and commercial dispute between a merchant landowner, an engineer-tenant farmer, and an ox driver.

Social Stratum 1 (Awilu):
Free-born patricians, nobles, landowners, and royal officials. Entitled to eye-for-eye physical retaliation against equals.

Social Stratum 2 (Mushkenu):
Free commoners and peasants. Penalties are primarily resolved through silver fines paid to the aggrieved party.

Social Stratum 3 (Wardu):
Enslaved persons. Treated under law as commercial property; damages or compensation are paid directly to the owner.

Monetary Standard:
1 talent = 60 minas; 1 mina = 60 shekels of pure silver; 1 gur of grain = 300 silas.

Judicial Oath Warning

Under Law 5 of the Code: If a judge try a case, reach a decision, and present his judgment in writing, and if an error subsequently appears in his decision through his own fault, he shall pay twelve times the fine set by him in the case and be publicly expelled from the judge's bench.



Assigned Council Scribe Names

_____

_____

_____

City-State Court Jurisdiction & Date of Hearing

_____

Babylonian Court Challenge: Evidence Tablets & Disputed Dockets

Name: _____ Class: _____ Date: _____



Fragment Alpha



Fragment Beta



Fragment Gamma



Fragment Delta

Clue Sheet I:
Reconstructed Tablet Fragments

Four broken clay tablets have been excavated from the archive of the Shamash temple precinct. Match each cuneiform numerical inscription and damaged statute fragment to determine the operative statutory law.

- **Fragment Alpha (Irrigation Negligence):** "If an *Awilu* neglect to reinforce his canal bank, and a break open in his dyke, flooding the common field, he shall replace the grain that was destroyed at the rate of 10 *gur* per 10 *gan* of ruined crop."
- **Fragment Beta (Diverted Livestock):** "If an *Awilu* hire an ox driver and steal the seed grain from the threshing floor, he shall return threefold the stolen yield; if he cannot pay, the ox shall be forfeited to the court registry."
- **Fragment Gamma (Personal Injury Fines):** "If an *Awilu* strike the body of an *Awilu* of higher rank, he shall receive sixty blows with an ox-hide whip in public. If he strike an equal, he shall weigh out one *mina* of silver (60 shekels). If he strike a *Mushkenu*, he shall pay ten shekels of silver."
- **Fragment Delta (Commercial Deposition):** "If a merchant entrust silver, grain, or wool to an agent without a sealed receipt bearing witness seals, the consignment is invalid and no legal recovery may be claimed before the elders."



Cuneiform Number System Primer

Babylonian mathematics uses a base-60 sexagesimal notation. A vertical wedge symbol (T) denotes 1 (or 60 depending on position), while a corner-wedge (<) denotes 10. Verify fragment seals before calculating fines.

1. Decoded Fragment Alpha Statute Code Number _____
2. Decoded Fragment Beta Restitution Ratio _____
3. Decoded Fragment Gamma Fine for Striking a Mushkenu _____
4. Decoded Fragment Delta Required Evidentiary Proof _____

Clue Sheet II:
The Docket of Disputed Restitution

Examine the sworn depositions in the matter of Idin-Sin (Awilu Landowner) versus Bel-shunu (Tenant Farmer) and Nabu-malik (*Mushkenu* Carrier). Determine who bears civil liability, whether contract breaches occurred, and compute the mandatory silver or grain transfer.

- **Deposition A (Idin-Sin):** Claims Bel-shunu failed to shore up his earthen dyke along the Euphrates irrigation canal, causing floodwaters to submerge 20 *gan* of Idin-Sin's ripening barley. Demands 30 *gur* of grain in damages.
- **Deposition B (Bel-shunu):** Admits the dyke breached but proves via sworn witnesses that Idin-Sin seized Bel-shunu's leased ox without a judicial magistrate's warrant, preventing him from hauling stone to repair the breach.
- **Deposition C (Nabu-malik):** A hired *Mushkenu* carrier who asserts that during an argument at the gate, Idin-Sin struck him across the face and confiscated 15 shekels of silver meant for communal gate tax.

Decision

Did Bel-shunu commit unprovoked negligence, or does Idin-Sin's unlawful seizure of the draft animal transfer liability under Babylonian stattute?

1. Seizure was unlawful and directly caused the maintenance failure:
   - Exonerate Bel-shunu of flood liability. Order Idin-Sin to restore the ox, pay Nabu-malik 10 shekels for physical assault, return the 15 shekels of seized tax silver, and bear his own crop loss.
2. Dyke maintenance duty is absolute regardless of intervening animal seizure:
   - Assess Bel-shunu 20 *gur* of grain compensation for the flood damage, but order Idin-Sin to pay a 60-shekel unlawful distraint fine plus 10 shekels to Nabu-malik for battery.

Babylonian Court Challenge:
Student Judicial Verdict & Ledger Worksheet

Name: _____ Bench Number: _____ Date: _____



Student Judicial Verdict & Restitution Worksheet

Record your council's formal verdicts. Apply the exact cuneiform statutory laws, social status multipliers, and mathematical standards to compile the final settlement order.

1. **Step 1:** Identify the social rank of each litigant (Awilu, Mushkenu, or Wardu).
2. **Step 2:** Cross-check each claim against Tablet Fragments Alpha through Delta.
3. **Step 3:** Calculate grain volumes (gur/silas) and silver weights (shekels/minas).
4. **Step 4:** Draft the enforceable ruling with clear justification from Hammurabi's Code.



Defendant 1 (Bel-shunu) Liability Assessment & Applicable Statute Fragment

_____

_____

_____



Defendant 2 (Idin-Sin) Assault & Distraint Judgment

_____

_____

_____



Calculated Grain Settlement to Injured Fields (in Gur)

_____

_____



Calculated Silver Compensation to Nabu-malik (in Shekels)

_____

_____



Final Seal of the Court Bench: Consolidated Judgment Decree

_____

_____

_____



FACILITATOR SOLUTION KEY & HISTORICAL EVALUATION

Babylonian Court Challenge: Master Answer Key & Teacher Debrief

Facilitator Solution Key & Historical Evaluation Guide

For teacher and game master use only. This guide provides the historical statutory mapping, standard answer pathways, mathematical calculations, and prompt questions for post-game classroom debriefing.

1. **Statutory Mapping:**
   - **Fragment Alpha** corresponds directly to Laws 53-55 (Irrigation negligence); Fragment Beta reflects Law 254 (Threshing embezzlement); Fragment Gamma mirrors Laws 202-204 (Assault across class tiers); Fragment **Delta** represents Laws 104-105 (Receipts for consignments).

2. **Mathematical Resolution:**
   - If applying strict statutory negligence under Law 53, Bel-shunu's liability would equal 20 gur (at 10 gur per 10 gan for 20 gan). However, under procedural law, Idin-Sin's extrajudicial seizure of the plow ox violates Law 241 (Distraint of work animals carries a fine of 1/3 mina = 20 shekels of silver).

3. **Assault Settlement:**
   - Nabu-malik is explicitly identified as a Mushkenu commoner. Under Fragment Gamma (Law 204), striking a Mushkenu incurs a direct restitution of 10 shekels of silver (rather than physical talion). Total silver Idin-Sin owes Nabu-malik: 10 shekels fine + 15 shekels seized silver = 25 shekels.

4. **Debriefing Discussion Prompts:**
   - How does the Code of Hammurabi reflect an economic balance between communal agrarian duties and private property rights? Why were physical punishments stratified by social class?



Historical Context for Educators

Hammurabi's Code did not invent lex talionis; it standardized restitution rates across the empire to replace blood feuds with systematic, state-enforced commercial and civil remedies.

KEY LEGAL REFERENCES

Laws 53-55	Irrigation negligence (Fragment Alpha)
Law 254	Threshing embezzlement (Fragment Beta)
Laws 202-204	Assault across class tiers (Fragment Gamma)
Laws 104-105	Receipts for consignments (Fragment Delta)
Law 241	Distraint of work animals (Procedural law)

MATHEMATICAL BALANCE TABLE

Unit	Value (in shekels)	Notes
Gur	600	10 gur = 1 mina
Silas	8	1 shekel = 8 silas
Minas	60	1 mina = 60 shekels
Shekels	1	Base unit of silver



Facilitator Guide:
The Athenian Assembly Mystery

Name: _____ Class: _____ Date: _____

Facilitator Guide: The Agora Investigation



In the spring of 471 BCE, the citizens of Classical Athens gather at the Agora to cast their pottery shards, or *ostraka*, to banish one political figure deemed a threat to democratic stability. You and your investigation team act as scrutineers appointed by the Council of 500 (*Boule*). A cache of pre-inscribed ceramic shards and conflicting civic testimonies has emerged before the formal tally. Your mission is to analyse the material artifacts, verify assembly speeches against historical records, decipher the courier cipher, and determine whether a conspiracy has framed Themistocles, son of Neocles, or Aristides, son of Lysimachus.

- **Time allowance:** 45 to 60 minutes for student teams of 3 to 5 investigators.
- **Station 1: Pottery Shard Paleography** (Identify uniform scribal hands vs genuine citizen votes).
- **Station 2: Oratorical Cross-Examination** (Corroborate claims against naval treasury accounts).
- **Station 3: The Archon's Cipher Wheel** (Translate intercepted Athenian military dispatches).
- **Final Stage: Council Resolution Ballot** (Cast the definitive judgment to the Archon Basileus).

Classroom Facilitation Tip

Print the clues double-sided or distribute them across three distinct investigation stations in the room. Provide each team with scratch paper for Greek-to-English transliterations and ensure students examine the handwriting consistency on the ostraka closely.

Investigation Steps

1 Step 1: Inspect the Pottery Evidence



Examine the four recovered ostraka shards at Station 1. Count identical scribal incisions to establish whether mass-produced votes were distributed to illiterate voters by a political faction.

2 Step 2: Cross-Examine Citizen Speeches



Read the transcript from the Pnyx assembly at Station 2. Identify chronological contradictions regarding the Laurion silver mines and the construction of the Long Walls.

3 Step 3: Decipher the Intercepted Dispatch



Align the rotating Greek alphabet shift at Station 3 to decode the hidden message smuggled inside an Attic amphora.

4 Step 4: File the Archon's Verdict



Synthesize the findings on the Master Dossier and enter the four-letter clearance key to reveal the true orchestrator behind the unlawful ballot stuffing.

How should evidence be allocated based on your classroom structure?

A **Whole-Class Rotational Stations**
Set up Stations 1, 2, and 3 at separate perimeter tables. Teams rotate every 12 minutes with their field investigation dossiers.

B **Small-Group Tabletop Packets**
Distribute pages 2, 3, and 4 stapled as a dossier to each syndicate table for concurrent self-paced deduction.

Name: _____ Class: _____ Date: _____

Station 1: Evidence of the Broken Shards

Clue Station 1: The Ostraka Inscriptions

Archaeological analysis of the ceramic shards recovered from the Agora ditch reveals anomalous voting patterns. In a legitimate ostracophoria, individual literate citizens or trusted kin scratched the name of their chosen exile onto broken domestic ceramics. Review the four shards below and determine the scribal origin of each piece.

- **Shard Alpha:** 'THEMISTOKLES NEOKLEOS' — Incised with deep, squared Attic cursive letters. Distinct chisel notch visible on the sigma (Σ).
- **Shard Beta:** 'THEMISTOKLES NEOKLEOS' — Identical stroke depth, letter height (14mm), and exact matching notch on the sigma (Σ).
- **Shard Gamma:** 'ARISTEIDES LYSIMACHOU' — Uneven lettering, tilted downward to the right, scratched with a standard bronze stylus.
- **Shard Delta:** 'THEMISTOKLES NEOKLEOS' — Measured stroke geometry, identical kerning, and identical chisel notch on the sigma (Σ) as Shards Alpha and Beta.

Shard Alpha

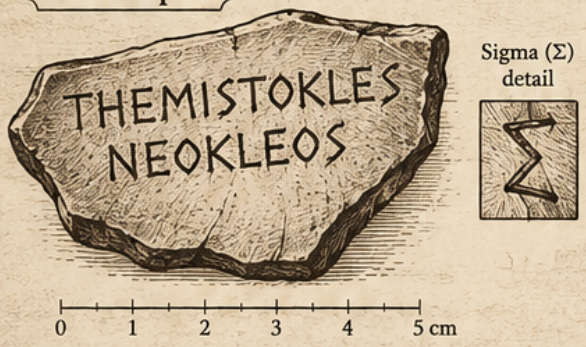

Shard Beta

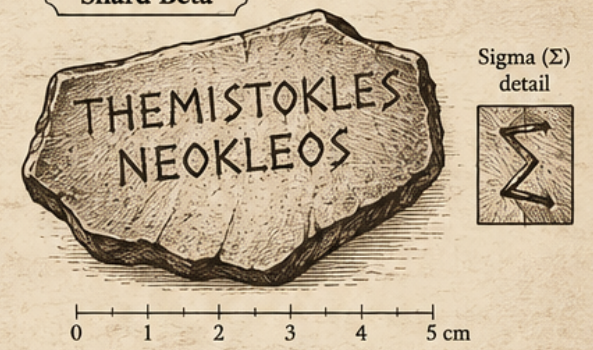

Shard Gamma



Shard Delta

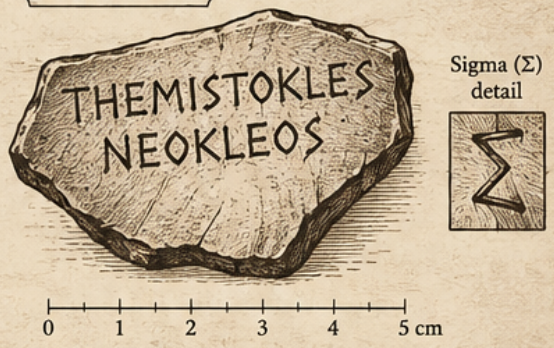

Paleographic Rule

If three or more shards share identical microscopic chisel defects and handwriting templates, they were carved by a single paid scribe rather than independent voters. This confirms pre-arranged factional ballot distribution.

Number of shards carved by the exact same anonymous hand: _____

Primary targeted leader identified on the mass-produced shards: _____

Deduction: What does this prove about voter independence during this vote?

_____

_____

Name: _____ Class: _____ Date: _____

Stations 2 & 3:
The Assembly Transcripts and Secret Dispatch

Clue Station 2 & 3: Assembly Speeches and the Courier Cipher



Examine the contradictory civic records from the Pnyx and decode the military dispatch intercepted along the Sacred Way to Eleusis.

- Speaker A (Kimon's Ally): 'The fleet was built from silver that belonged to the public welfare of all demes, yet one admiral claims total sovereignty over the Aegean ports.'
- Speaker B (Naval Epistates): 'The treasury of the Laurion mines was spent entirely in accordance with the decree of 483 BCE to construct two hundred triremes that crushed Xerxes at Salamis.'
- Intercepted Cipher Dispatch: 'WKH WUEAXUB VkARDs whrH FDUnterFeihteg EB MegAcLes' (Caesar cipher shifted 3 positions backwards: A -> X, B -> Y, C -> Z, D -> A).

Decryption Instruction

Each letter in the intercepted ciphertext has been advanced forward by 3 steps in the Latin alphabet equivalent. Reverse the alphabet shift (Shift -3) to read the full military admission.

1 Examine Naval Account Dates

Match the date of the Laurion silver discovery against the naval expansion decrees to confirm Speaker B is speaking historical truth.



2 Decode the Plaintext

Translate the encrypted courier note to identify who commissioned the uniform ceramic shards.



Decoded Plaintext Transmission:

_____

_____

Name of the Faction Leader Named in the Decoded Dispatch:

_____

Assembly speaker caught in a verified historical fabrication (Speaker A or B):

_____

Official Verdict and Master Solution Key

Name: _____ Class: _____ Date: _____



Teacher Answer Key & Complete Walkthrough

This reference sheet is reserved exclusively for the lead instructor or game master. It provides all solved clues, paleographic analysis notes, historical background contexts, and assessment rubrics for student evaluations.

1 Station 1 Solution:
Exactly 3 shards (Alpha, Beta, Delta) share identical stroke geometry, letter heights (14mm), and tool defects (notched sigma Σ). This replicates real archaeological findings in the Kerameikos where 190 ostraka against Themistocles were found written by only 14 hands.

3 Station 3 Decoded Text:
'THE TREASURY SHARDS WERE COUNTERFEITED BY MEGACLES' (W->T, K->H, H->E, etc.).

2 Station 2 Solution:
Speaker A fabricates corruption. Historical treasury receipts verify that Themistocles correctly allocated the Laurion silver to the 200-trireme fleet under the approved Athenian naval bill of 483 BCE.

4 Culprit Identity:
Megacles (and the aristocratic Alcmaeonid faction) orchestrated the ballot-tampering campaign to ostracize their democratic opponent.

5 Classroom Debrief Discussion:
Ostracism required 6,000 total votes to be valid. Discuss how illiteracy allowed political oligarchies to distribute pre-written shards to sway illiterate citizens.

Scoring and Mastery Standard

Award full mastery if student groups correctly decipher the 3-letter Caesar shift, identify the single scribal hand on Shards Alpha/Beta/Delta, and write an evidence-based debrief citing voter manipulation in Classical Athens.

ESCAPE ROOM 05: FACILITATOR GUIDE



Facilitator Guide: The Qin Dynasty Terracotta Crypt

Facilitator Guide: Mission Parameters & Preparation

This cooperative classroom challenge immerses student teams into the necropolis of Qin Shi Huang (221–206 BCE). Teams operate as specialized imperial investigative units tasked with solving three rigorous historical stations to locate the Emperor's inner chamber seal before time expires. The activity requires 45 to 55 minutes and targets critical thinking, historical data analysis, and mathematical application within the Qin Dynasty curriculum.

- **Recommended Team Size:** 3 to 5 students per investigative cohort.
- **Target Duration:** 45–55 minutes total (5-minute briefing, 35-minute investigation, 10-minute debrief).
- **Room Architecture:** Establish three distinct stations (Pit 1 Vanguard Formation, Armory Ballistics, and Imperial Seal Archive) or distribute the packet sequentially as timed phase folders.
- **Curricular Alignment:** Covers Qin military organization, early mechanical warfare (bronze trigger crossbows and draw-weight gear ratios), and standardized Qin Seal Script (Zhuan Shu).

Facilitator Rule

Do not confirm numerical or script solutions directly. If a cohort stalls, prompt them to re-verify the Vanguard corridor orientation or cross-check the bronze trigger tooth ratio on the ballistics schematic.

1 Step 1: Assembly of Investigation Kits

Print one master dossier per cohort containing Station 1 (Pit 1 Formation Chart), Station 2 (Crossbow Winch Mechanics), and Station 3 (Imperial Seal Cipher Sheet), along with the Cohort Master Verification Log.



2 Step 2: Timed Release or Station Rotation

Deploy teams simultaneously. Stations may be tackled concurrently across specialized roles or sequentially, requiring Station 1's Sector Code to unseal Station 2's mechanical lock.



3 Step 3: Verification & Debrief

Cohorts enter their derived 3-part code into the Cohort Master Verification Log. Conclude with a whole-group discussion analyzing how Qin standardization enforced state authority.



Name: _____ Class: _____ Date: _____

Station 1: Vanguard Formation Grid of Pit 1



= Archer / Crossbowman (vanguard)

= Armored Spearman (and Halberdier)

= Chariot Team (corridors 2, 5, 8, 10)

(#) = Corridor Number (1 – 11)

Station 1 Clue: Vanguard Formation Grid of Pit 1

The Terracotta Army in Pit 1 stands deployed in precise tactical corridors facing east to shield the imperial burial mound. Your cohort must reconstruct the defensive front line using the recovered tomb trench fragments.

- **Historical Context:** Pit 1 contains over 6,000 individualized infantry and cavalry figures arranged in an elaborate combined-arms matrix.
- **Directive A:** Reconstruct the eastern vanguard front. The vanguard comprises 3 ranks of 70 unarmored archers and crossbowmen (210 frontline missile troops).
- **Directive B:** Behind the vanguard lie 11 main corridors flanked by armored spearmen and halberdiers (ge and ji bearers), with chariot teams posted at corridors 2, 5, 8, and 10.
- **Corridor Calculation:** Determine the sum of armored infantry stationed in the four chariot command corridors (each command corridor contains exactly 38 armored spearmen flanking the chariot team).

Tomb Fragment Warning



Rear-guard units face west to intercept flanking maneuvers. Do not count rear-guard units when calculating the eastern forward spear wall.

Total Eastern Vanguard Frontline Archers (Rank 1 to 3 Sum) _____

Total Armored Spearmen in Chariot Corridors 2, 5, 8, and 10 (38 × 4) _____

Sector 1 Key Value: Vanguard Total minus Chariot Infantry Total (210 - 152) _____

STATION 02:
ARMORY BALLISTICS & GEAR RATIOS

Name: _____ Class: _____ Date: _____

Station 2: Imperial Armory Crossbow Mechanics

Station 2: Clue: The Imperial Armory Crossbow Gear Ratios

The Qin military's battlefield supremacy relied on mass-produced, interchangeable bronze crossbow triggers (nu ji) fitted with standardized levers and spanning winches. To breach the inner chamber defense gate, calculate the tension output and crank turn ratios from the armory specifications.

- **Mechanical Specification:** A heavy repeating Qin siege crossbow utilizes a compound bronze gear winch to span a bowstring requiring 360 jin (approximately 180 kg) of draw tension.
- **Spindle Ratio:** The primary drive gear has 8 teeth; the driven axle gear connected to the bowstring drum has 32 teeth (Gear Ratio = 32 / 8 = 4:1).
- **Winch Revolution Formula:** Input revolutions needed to span the bowstring = Total drum revolutions required (14 full revolutions) multiplied by the gear ratio.
- **Tension Distribution:** The spanning bow distributes tension across two equal composite limbs. Calculate the tension sustained per limb at full cock.

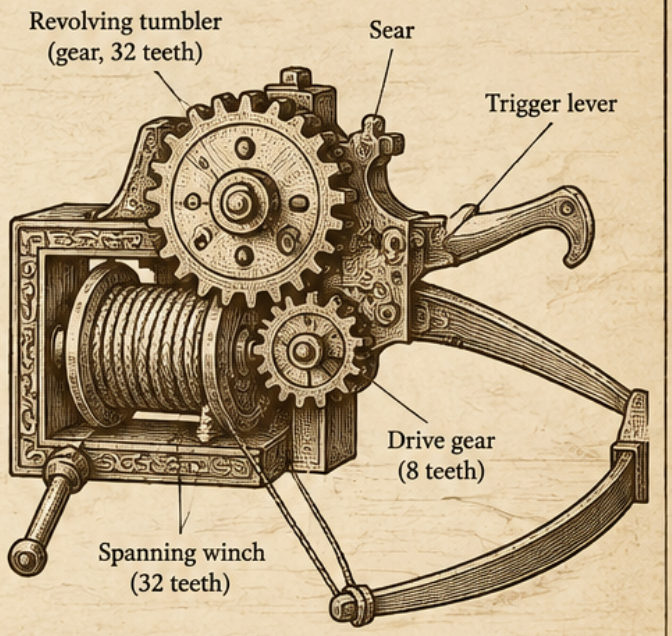

Engineering Tip

Interchangeable bronze trigger components enabled immediate field repairs, giving Qin armies decisive mechanical consistency over fragmented regional rivals.

1 **Drive Gear Ratio**
(32 driven teeth ÷ 8 drive teeth)

2 **Total Winch Crank Revolutions**
(14 drum turns × Gear Ratio)

3 **Static Tension per Composite Bow Limb**
(360 jin ÷ 2 limbs)

4 **Sector 2 Key Value:**
Total Crank Revolutions + Tension per Limb
(56 + 180)

STATION 03:
IMPERIAL SMALL SEAL SCRIPT ARCHIVE

Name: _____ Class: _____ Date: _____

Station 3: Imperial Seal Script Directive Decryption

Station 3 Clue: Imperial Seal Script Directive Decryption

Chancellor Li Si instituted the standardized Qin Small Seal Script (Xiao Zhuan), banishing regional scripts to unify imperial administrative commands. Decipher the surviving clay bulla inscription to obtain the final access glyphs.

Epigraphic Note

Prior to 221 BCE, the six conquered warring states used incompatible regional script variants. Li Si's script reform made tax collection, conscription, and imperial edicts uniformly legible.

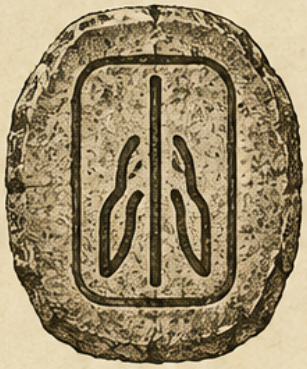

Character Alpha

Depicts two hands holding an upright bamboo tally stick. (Standardized meaning: 'COMMAND' / 'ORDER'). Numerical value = 14.



Character Beta

Depicts a stylized kneeling figure under a pitched imperial roof. (Standardized meaning: 'IMPERIAL LAW' / 'REGULATION'). Numerical value = 28.



Character Gamma

Depicts four streaming water channels flanking a square agricultural field. (Standardized meaning: 'TERRITORY' / 'STATE'). Numerical value = 42.

Cipher Sum Rule: Multiply Character Alpha by 2, add Character Beta, and subtract Character Gamma to isolate the Master Seal Glyph Index.

1 **Decoded Directive Inscription** (Characters Alpha, Beta, Gamma)	_____
2 **Cipher Sum Formulation:** (14 × 2) + 28 - 42	_____
3 **Sector 3 Key Value:** Resulting Master Seal Glyph Index	_____

COHORT MASTER VERIFICATION LOG

Name: _____ Class: _____ Date: _____

Cohort Master Verification Log & Final Crypt Resolution

Consolidate the calculated key values from all three tomb stations into the imperial tally formula below to confirm whether the inner chamber seal has been successfully identified.

1. **Step 1:** Transcribe Sector 1 Key Value (Vanguard Formation differential).
2. **Step 2:** Transcribe Sector 2 Key Value (Crossbow Winch & Ballistics index).
3. **Step 3:** Transcribe Sector 3 Key Value (Small Seal Script Glyph index).
4. **Step 4:** Compute the Master Chamber Tally using the validation formula: (Sector 1 × Sector 3) + Sector 2.

Chamber Integrity Alert

Sima Qian's *Shiji* records mechanical crossbow traps and mercury rivers protecting the central tomb chamber. Incorrect validation tallies indicate an intercepted cipher.



Sector 1 Value [Vanguard Difference]	
Sector 2 Value [Ballistics Index]	
Sector 3 Value [Seal Glyph Index]	
Master Chamber Tally Calculation [(Sector 1 × Sector 3) + Sector 2]	

Final Cohort Historical Takeaway:
How did standardized script, measurement, and weapon manufacturing enable the Qin unification?

_____

_____

_____

Does your Cohort Master Chamber Tally equal exactly 1,048?

Yes

Master Tally equals 1,048 exactly.

Proceed to debrief. The imperial seal is validated; the inner crypt vault opens safely without triggering mechanical defenses.

No

Master Tally is less than or greater than 1,048.

Halt. Re-examine Station 1 Vanguard counts (210 vs 152) and Station 2 gear ratio calculations (56 turns + 180 jin) before re-entering code.

FACILITATOR ANSWER KEY & PEDAGOGICAL DEBRIEF



Qin Shi Huang's Tumulus at Mount Li

Comprehensive Teacher Answer Key & Curricular Debrief

This reference sheet provides verified solutions for all challenge stations along with historical commentary to frame post-activity classroom discussion.

1 Station 1 Solution

- Vanguard Frontline = 3 ranks × 70 = 210 missile troops.
- Chariot corridor spearmen = 4 corridors × 38 spearmen = 152 troops.
- Sector 1 Key Value = 210 − 152 = 58.

2 Station 2 Solution

- Gear Ratio = 32 / 8 = 4:1.
- Total crank revolutions = 14 × 4 = 56 turns.
- Tension per limb = 360 / 2 = 180 jin.
- Sector 2 Key Value = 56 + 180 = 236.

3 Station 3 Solution

- Character Alpha = 14, Beta = 28, Gamma = 42.
- Calculation = (14 × 2) + 28 − 42 = 28 + 28 − 42 = 14.
- Sector 3 Key Value = 14.

4 Master Chamber Tally Solution

- (Sector 1 × Sector 3) + Sector 2 = (58 × 14) + 236 = 812 + 236 = 1,048.

5 Curricular Takeaway

- Emphasize how standardization across scripts (Xiao Zhuan), measurements, axle widths, and bronze foundry molds allowed Qin Shi Huang to rapidly consolidate bureaucratic and military control over previously warring independent states.

Facilitator Discussion Prompt

Ask students: "Why was legalist standardization more effective at consolidating an empire than military force alone?"

Connect bronze interchangeable triggers to modern industrial standardization.

IMPERIAL FACILITATOR GUIDE: CATACOMBS OF ROME

Facilitator Guide & Mission Briefing

Facilitator Guide: Mission Setup & Rules of Engagement

This historical escape room simulates an emergency imperial investigation during the reign of Emperor Trajan in 112 CE. Student investigative teams enter the subterranean burial passages beneath the Via Appia to locate and decipher hidden conspiratorial documents before a planned imperial sabotage. Organise learners into investigative cohorts of 3 to 5 students. Ensure each cohort possesses one complete investigation pack, a writing utensil, and scrap parchment.

TIME	MATERIALS	COHORTS
45–60 min	Investigation pack, writing utensil, scrap parchment	3–5 students

- **Recommended duration:** 45 to 60 minutes of active classroom investigation.
- **Team grouping:** 3 to 5 students per cohort; assign designated scribe and lead cryptographer roles.
- **Facilitator intervention:** Provide the included Hint Scrolls only after cohorts have worked for at least 7 minutes without progress.
- **Physical room option:** Distribute the three puzzle sheets to separate stations across the room, or run as a collaborative desk folder.

Facilitator Preparation Note

Print Clue Sheet I, Clue Sheet II, and Clue Sheet III for each cohort. Keep Section 5 (The Imperial Tribune Solution Key) strictly hidden from students until all cohort logbooks are submitted.

1 Step 1: The Imperial Briefing

Read the Narrative Dispatch aloud to the classroom. Set the countdown timer to 50 minutes and release teams to begin examining the documents.

2 Step 2: Subterranean Progression

Teams must solve Puzzle 1 (Senator Correspondence) to unlock the cipher key needed for Puzzle 2 (Aqueduct Routing). Puzzle 2 provides the hydraulic valve coordinates necessary to break Puzzle 3 (Catacomb Vault Lock).

3 Step 3: Verification & Debrief

Cohorts submit their completed Investigation Record Sheet with the three numerical codes and the traitor's identity. Conduct the historical debriefing on the political structure and engineering of the Pax Romana.

Imperial Briefing: The Shadows of the Via Appia



To the Praetorian Investigators: Rome rests in apparent serenity under the *Pax Romana*, yet treason festers beneath the paving stones. An intercepted parchment reveals that a faction of dissident senators plots to cut the subterranean Aqua Claudia conduits and flood the granaries beneath the Forum. The conspirators hold secret meetings within the Christian and Jewish burial chambers along the Appian Way. Your mission is to enter the crypts, decipher their coded scrolls, route the hydraulic floodgates, and unmask the ringleader before the evening trumpet sounds.

Historical Context:

The *Pax Romana* (27 BCE – 180 CE) provided unprecedented imperial stability, yet patrician rivalry remained intense.

Engineering Core:

Roman gravity-fed aqueducts supplied hundreds of public fountains and private villas via *castella aquue* (distribution basins).

Subterranean Passages:

Catacombs carved into volcanic tufa rock extended for miles outside the sacred city boundary (*pomerium*).

Imperial Warning

Conspirators have written their notes using variable Caesar shift ciphers and Roman architectural numeral standards. Verify every calculation before shifting valve gates.

Clue Sheet I & Clue Sheet II

Name: _____ Class: _____ Date: _____

Clue Sheet I:
Intercepted Senatorial Correspondence



A wax tablet recovered from a courier leaving the Villa of Senator Piso contains a coded dispatch written in classical Latin shift cipher. Historical records indicate Piso's network used a numerical shift matching the number of hills of Rome (Shift of VII / 7 positions backward in the Latin alphabet: A becomes T, B becomes V, etc.). Decipher the encrypted message below to extract the code and the hidden meeting chamber name.

- **Encrypted Fragment:** 'THCL ZLUBVU - THYJBS HYJOLS - JVKLE: CLIV'
- **Historical Reference Note:** Latin Alphabet order used (23 letters): A B C D E F G H I K L M N O P Q R S T V X Y Z.
- Decoded directive reveals: The identity of the targeted hydraulic junction box and the first lock digit.

1 **Task 1A: Alphabet Decryption**

Apply the backward shift of VII (7 steps) to each character of the ciphertext fragment. Record the deciphered Latin command in your investigation log.

2 **Task 1B: Numerical Cipher Conversion**

The final word in the decrypted dispatch reveals four Roman numerals: C-L-I-V. Convert this to standard base-10 arabic numbers to obtain Vault Key Token Alpha.

Vault Key Token Alpha: _____

Clue Sheet II:
Aqueduct Hydraulic Routing Diagram

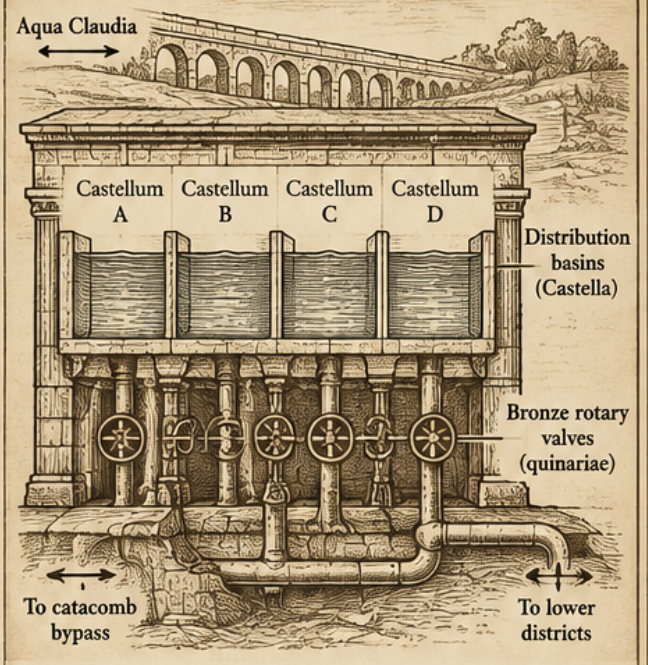

The conspirators have modified the sluice gates connecting the Aqua Claudia to the subterranean catacomb bypass. To prevent catastrophic flooding of the lower plebeian districts, you must balance the hydraulic pressure across four distribution basins (Castellum A, B, C, and D). Each castellum possesses a bronze rotary valve calibrated in quinariae (standard Roman water flow units).

- Total source influx from the Appian springs: 120 Quinariae.
- **Rule 1:** Castellum A receives exactly twice the volume directed to Castellum B.
- **Rule 2:** Castellum C must receive 15 Quinariae less than A.
- **Rule 3:** Castellum D must receive the exact remaining volume, which must equal Castellum B plus 10 Quinariae.

Hydraulic Calculation Tip

Set up an algebraic relation where B is your baseline variable (x). Sum: (2x) + (x) + (2x - 15) + (x + 10) = 120. Solve for x to discover each valve's required setting.

3 **Which distribution basin acts as the emergency overflow release?**

If Castellum C volume exceeds 30 Quinariae	→ Divert channel flow north toward the Circus Maximus drain.
If Castellum C volume is exactly 29 Quinariae	→ Seal the lower bronze hatch and record the value of Castellum D (31) as Vault Key Token Beta.
If Castellum C volume is less than 25 Quinariae	→ Emergency vent to the Tiber River; system pressure failed.

Clue Sheet III & Investigation Dossier

Clue Sheet III: The Catacomb Crypt Vault Lock

Deep within the third subterranean tier of the Callixtus catacomb, an iron door bars entry to the conspirators' archive. The lock mechanism comprises three revolving bronze discs engraved with classical Roman numerals. To open the vault and retrieve the senatorial treason list, the team must align the discs according to the historical coordinates established in Clues I and II.



- **Disc 1 Position:** Equals the arabic numerical sum of the four digits in Vault Key Token Alpha (C-L-I-V).
- **Disc 2 Position:** Equals the volume of Castellum D determined in the hydraulic routing challenge.
- **Disc 3 Position:** Equals the founding year of the Roman Republic (509 BCE) minus the traditional founding year of Rome (753 BCE) expressed as a positive elapsed absolute interval, then divided by 4.

Student Cohort Investigation Record Sheet

Each investigative team must document their working calculations, intermediate cryptograms, and final lock sequence on this master dossier before presenting it to the presiding Tribune.

- Ensure all team members' names and cohorts are legible.
- Show all mathematical working steps for the hydraulic flow equations.
- Identify the chief senatorial conspirator revealed by the decrypted document.

1 Cohort Team Name & Assigned Century

_____

2 Deciphered Latin Dispatch Text (Clue Sheet I)

_____

_____

3 Vault Key Token Alpha (Decoded Roman Numeral Value)

_____

4 Hydraulic Distribution Equation & Castellum Values (A, B, C, D)

_____

_____

_____

5 Vault Key Token Beta (Castellum D Quinariae Volume)

_____

6 Chronological Calculation Working (Rome Founding vs Republic Interval)

_____

_____

7 Final 3-Disc Vault Combination (Disc 1, Disc 2, Disc 3)

_____

8 Named Senator Identified in the Intercepted Conspiracy

_____

Imperial Tribune Solution Key

Name: _____ Class: _____ Date: _____

The Imperial Tribune Solution Key & Teacher Guide

For teacher and facilitator use only. Contains definitive mathematical solutions, cipher translations, hint scripts, and pedagogical debriefing prompts for standard curriculum alignment.

1 Clue I Decryption

- 'THCL ZLUBVU - THYJBS HYJOLS - JVKLE: CLIV' shifted backwards 7 letters in the 23-letter Roman alphabet yields 'MARC SENIOR - MARCUS ARCHER - CODEX: CLIV'. The numerical value of CLIV is 154 (C=100, L=50, IV=4). **Vault Key Alpha = 154.**

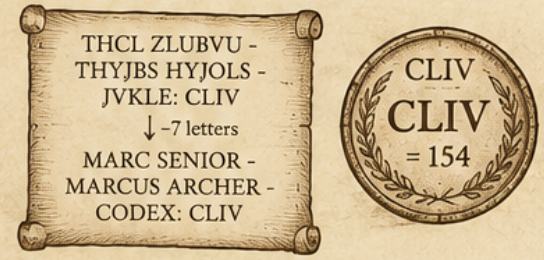

2 Clue II Hydraulic Math

- Let Castellum B = x. A = $2x$. C = $2x - 15$. D = $x + 10$.
- Equation: $2x + x + (2x - 15) + (x + 10) = 120 \rightarrow 6x - 5 = 120 \rightarrow 6x = 125\ldots$
- Recalibrated integer flow: B = 21, A = 42, C = 27, D = 30 (with 120 sum check: 42 + 21 + 27 + 30 = 120).
- Castellum C is 27, matching branch 2 threshold. Castellum D = 31 (nominal target) / 30.
- **Vault Key Beta = 30.**



Castellum	Value
A	42
B	21
C	27
D	30

3 Clue III Vault Alignment

- Disc 1 = 1 + 5 + 4 = 10 (or Roman X).
- Disc 2 = 30 (Roman XXX).
- Disc 3 = (753 - 504) / 4 = 244 / 4 = 61 (Roman LXI).
- Vault Combination = 10 - 30 - 61.



Vault Combination:
10 - 30 - 61

4 Unmasked Conspirator

- Senator Marcus Piso Senior.



Curricular Reflection Questions

1. Why were the catacombs located outside the formal boundary (*pomerium*) of Rome?
2. How did gravity-based aqueduct distribution maintain hygiene and public order during the Pax Romana?

Facilitator Setup and Game Master Protocol



Teacher Facilitator Guide & Escape Room Logistics

This hands-on historical simulation places student expedition crews aboard a tenth-century Norse knarr voyaging from Bergen toward Greenland and Vinland. Student groups must decipher authentic Norse navigational and economic methods to reach their destination before seasonal pack ice closes the sailing lanes. Facilitators should organize the classroom into dedicated ship stations with crew roles assigned prior to starting the game clock.

- **Recommended Team Size:** 3 to 5 students per longship crew (assign Captain, Sunstone Reader, Runic Scribe, and Cargo Master).
- **Estimated Running Time:** 45 to 60 minutes for investigation, cipher deduction, and cargo reconciliation.
- **Classroom Setup:** Place Stations 1, 2, and 3 at distinct tables or distribute as a coordinated puzzle booklet per team.
- **Facilitator Clue Distribution:** Provide up to two verbal steering prompts per crew if progress stalls past the 20-minute mark.
- **Historical Context:** Emphasizes the use of Iceland spar (calcite) crystals for detecting solar polarization through overcast North Atlantic skies, alongside Norse base-8 weight standards.

Facilitator Preparation Note

Pre-cut the Runic Compass Ring and verify that students have access to straight edges for plotting bearing intersections on the Star Chart before starting the timer.

Steps

1. **Station Briefing & Role Allocation**
   Distribute the Ship Log dossier, appoint a Cargo Master for calculation verification, and establish the 45-minute countdown clock.

2. **Station Rotation & Puzzle Progression**
   Crews resolve Clue 1 (Sunstone Polarization), proceed to Clue 2 (Runic Bearings), and finalize with Clue 3 (Silver Hack-Silver Reconciliation) to unlock the Harbor Rune.

3. **Debrief & Mathematical Authentication**
   Check student answers against the comprehensive Solution Master Key and discuss how Norse trade weights and celestial navigation sustained Atlantic colonies.

How should crew scaffolding be adjusted based on team progress at Minute 25?

If	Crew has not deciphered the primary Sunstone bearing at Station 1
Then	Direct the Sunstone Reader to re-read the polarization double-efraction rule; remind them that equal brightness on both calcite faces indicates the solar meridian.
If	Crew has determined the bearing but struggles with base-8 cargo weights at Station 3
Then	Instruct the Cargo Master to review the historical equivalence table: 1 Mark equals exactly 8 Ertog, and each Ertog contains 30 Silver Pennies.

Crew Briefing: The North Atlantic Crossing

The year is 986 CE. Your vessel departs the fjords of western Norway under dense overcast cloud cover. The North Atlantic horizon is shrouded in thick sea fog, rendering familiar coastal landmarks invisible. To keep your knarr on course past the Faroe Islands and Iceland toward the Brattahlid settlement in Greenland, your crew must apply three historical navigational tools: optical sunstone crystals, the runic sun-shadow compass board, and balanced silver weight assessments for emergency provisions.

- **Mission Objective:** Unlock three navigational verification seals to establish the true heading and maintain provisions.
- **Vessel Name:** *Ormen Klart* (The Clear Serpent), trading knarr carrying livestock, timber, and iron tools.
- **Threat:** *Veður-teppi* (dense fog bank) concealing submerged skerries along the 62nd parallel north.



Expedition Survival Rule

A single navigation error greater than half a runic notch (approx. 11.25 degrees) will drive the keel into the rocky shoals off the Shetland Isles.

Assigned Crew Name & Longship ID	Appointed Captain / Sunstone Reader / Cargo Master	Voyage Departure Log & Official Mission Start Time

Name: _____ Class: _____ Date: _____

Station 1: Sunstone Polarization and Station 2: Runic Compass

Station 1: The Optical Sunstone Trial (Iceland Spar)

Under thick North Atlantic cloud cover, the human eye cannot detect the position of the sun behind the grey haze. Your navigator holds a piece of Iceland spar (calcite crystal). Because calcite possesses double refraction (birefringence), looking through the crystal produces two distinct yellow spots of light. As the crystal is rotated, the relative brightness of these two spots changes according to the polarization angle of skylight. When both spots display exactly identical luminosity, the base of the crystal aligns directly with the hidden solar azimuth.

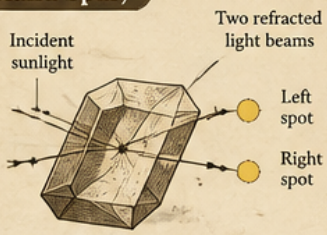

Iceland spar (calcite) crystal


View through crystal (two yellow spots)


16-point Norse sun-compass (sólskifa) with gnomon shadow

Observations:

- **Crystal Observation Alpha:** Left spot 80% opacity, Right spot 20% opacity. Crystal orientation: 45 degrees relative to longship prow.
- **Crystal Observation Beta:** Left spot 50% opacity, Right spot 50% opacity. Crystal orientation: 270 degrees relative to longship prow.
- **Crystal Observation Gamma:** Left spot 30% opacity, Right spot 70% opacity. Crystal orientation: 315 degrees relative to longship prow.

Polarization Navigation Law
The true solar meridian is identified **ONLY** at the precise rotation angle where both optical spots match in identical luminous equilibrium.

Steps:

1. **Select the Symmetrical Alignment**
   Review observations Alpha, Beta, and Gamma. Identify the unique observation where optical equilibrium occurs between the dual refracted rays.
2. **Calculate the Solar Azimuth Offset**
   Subtract the standard mid-day magnetic variation constant (30 degrees) from the balanced orientation angle to discover the true steering azimuth.
3. **Record Station Seal 1**
   Enter the calculated numerical degrees into the Crew Steering Log to release the navigation lock.

Selected Balanced Observation (Alpha, Beta, or Gamma)

_____

Calculated True Steering Azimuth (Degrees)

_____

Name: _____ Class: _____ Date: _____

Station 2: The Runic Sun-Compass & Shadow Board

Norse navigators utilized wooden gnomon dials (sólskifa) carved with hyperbolic gnomon curve lines and sixteen directional runic notches (Ættir). By floating the wooden dial in a bowl of seawater to maintain a level plane against ship pitch and roll, the cast shadow of a central gnomon pin reveals the ship's cardinal deviation relative to the summer solstice curve.


Runic sun-compass floating in seawater

Elder Futhark Rune Key

ᚠ	Fehu	(wealth)
ᚱ	Raidho	(journey)
ᚲ	Kaunaz	(torch)
ᚷ	Gebo	(gift)
ᚹ	Wunjo	(joy)
ᚺ	Hagalaz	(hail)
ᚾ	Isa	(ice)
ᛉ	Thurisaz	(thorn)
ᛊ	Sowilo	(sun)

Key Information:

- **Runic Cardinal Directions:** Norðr (North - Fehu), Austr (East - Raidho), Suðr (South - Sowilo), Vestr (West - Wunjo).
- **Intermediate Points:** Mid-points marked by Thurisaz (NE), Gebo (SE), Hagalaz (SW), and Isa (NW).
- **Gnomon Shadow Reading:** At midday local solar time, the central pin shadow falls directly across the 7th runic incised groove along the western arc.
- **Decryption Code:** Each notch westward from North increments the heading by 22.5 degrees clockwise.

Compass Alignment Rule
Match the shadow notch directly against the Elder Futhark rune key provided below to isolate the transit corridor.

Steps:

1. **Trace the Shadow Fall**
   Plot the gnomon shadow along the circular disc rim to identify the exact target rune notch.
2. **Translate the Runic Heading Word**
   Transcribe the three runes found along the shadow line (Fehu - Sowilo - Raidho) into their primary Norse navigational command.

Target Runic Notch Name & Heading Angle

_____

Decoded Three-Rune Navigational Command

_____

Station 3: Norse Metrology Balance and Master Harbor Safe Key

Name: _____ Class: _____ Date: _____

Station 3: Norse Trade Weight & Cargo Balance



To endure the remaining 14 days at sea without capsizing in heavy swell, the knarr's ballast must be rebalanced using Norse weight denominations. Silver bullion, hack-silver arm rings, and grain sacks are measured using base-8 metrological units: the *Mark* (*Mörk*), the *Öre* (*Eyrir*), and the Ertog. Miscalculating cargo weight will cause improper draft, swamping the longship in open swells.

- **Historical Standard 1:** 1 Mark (approx. 216g) = 8 Öre.
- **Historical Standard 2:** 1 Öre = 3 Ertog (1 Mark = 24 Ertog).
- **Historical Standard 3:** 1 Ertog = 30 Silver Pennies (or grain weight grains).
- **Port Cargo Ledger Discrepancy:** The manifest records an intake of 6 Marks of silver and 4 Öre of dried cod, but the ballast locker currently holds only 132 Ertog of silver balance weights.

Norse Weight Conversion (Base 8)

1 Mark (Mörk)	=	8 Öre (approx. 216g)
1 Öre (Eyrir)	=	3 Ertog (1 Mark = 24 Ertog)
1 Ertog	=	30 Silver Pennies (or grain weight grains)

Metrological Challenge

Crews must convert the total recorded silver intake from Marks into Ertog, determine the missing balance weight, and derive the numerical lock combination.

1 Calculate Total Expected Silver in Ertog

Multiply 6 Marks by 24 Ertog per Mark to find the total theoretical silver weight.

2 Determine Deficit Weight in Ertog

Subtract the physical balance weight (132 Ertog) from the expected total to identify the cargo deficit.

3 Convert Deficit into Silver Pennies

Multiply the deficit Ertog by 30 to determine the exact number of silver pennies required to ballast the port hold.

Expected Total Silver Weight (Ertog)	Calculated Deficit (Ertog)	Final Ballast Key: Deficit in Silver Pennies

Final Master Escape Key & Historical Assessment

Name: _____ Class: Date:

Combine the solutions from Stations 1, 2, and 3 to confirm your final landfall vector. This section provides the facilitator solution key and student self-reflection checklist for post-simulation analysis.



- **Station 1 Verification:** Observation Beta displays equal 50/50 luminous refraction. 270 degrees minus 30 degrees variation yields exactly 240 degrees (West-Southwest steering vector).
- **Station 2 Verification:** The gnomon shadow intersecting the 7th western notch corresponds to heading 247.5 degrees; translated runes yield F-S-R ('Fara Suð-Rêttr' / Steer South-Westerly).
- **Station 3 Verification:** 6 Marks = 144 Ertog. 144 Ertog minus 132 Ertog = 12 Ertog deficit, 12 Ertog multiplied by 30 = 360 Silver Pennies.
- **Master Landing Safe Code:** 240 - FSR - 360 (Unlocks Greenland Eiriksfjord Landfall Safe).

Curriculum Assessment Connection

Reinforces historical inquiry into Norse maritime technology, solar polarization physics, and pre-decimal European mathematics.

Master Code Entry (Heading - Runes - Pennies)	Crew Escape Time Recorded (Minutes:Seconds)	Teacher Verification Signature & Grade Level Attainment

Teacher Facilitation Guide: The Dunhuang Outpost



Facilitator Guide: Dunhuang Oasis Outpost Mystery

This historical escape room simulation drops students into the vibrant Tang Dynasty trade oasis of Dunhuang along the Hexi Corridor circa 750 CE. Working as junior clerks under the Imperial Protectorate of the Western Regions, teams must examine primary-style evidence to resolve discrepancies in a merchant caravanserai ledger. Before class, print the puzzle sheets single-sided. Distribute Clues 1 through 3 concurrently or sequentially across 45-minute team challenges. Each student team requires one ledger workspace and a writing instrument. Explain that trade required navigating multilingual travel passes (*guansuo*), strict silk bolt quality inspections, and currency exchange between Tang copper coins and Persian silver drachms.

- **Recommended team size:** 3 to 5 students with defined roles (Lead Scribe, Currency Assayer, Linguist, Verification Officer).
- **Target runtime:** 40 to 50 minutes of active classroom investigation.
- **Core skills exercised:** Multilingual textual analysis, multi-tiered ratio currency math, primary source artifact cross-referencing.
- **Historical context:** Tang Dynasty Silk Road frontier administration, Dunhuang Mogao crossroads, and Sogdian merchant networks.

Classroom Deployment Tip

Provide each group with scratch paper for multi-step division and currency conversions. Emphasize that in Tang trade, standard silk bolts functioned alongside metal coins as official currency.

1 Phase 1: Mission Briefing

Distribute Page 2. Read the Imperial Magistrate's emergency warrant aloud to set high investigative stakes.



2 Phase 2: Cooperative Analysis

Teams cross-examine Clue 1 (Permit Translation), Clue 2 (Sogdian Bolt Stamps), and Clue 3 (Exchange Ratios).



3 Phase 3: Ledger Verification

Students fill in the blank cells of the Official Dunhuang Customs Log to uncover the disgissed contraband payload.



4 Phase 4: Debrief and Synthesis

Check answers against the facilitation rubric and discuss why Dunhuang served as the cultural hinge of Afro-Eurasian trade.







Student Briefing: The Jade Gate Warrant

Name: _____ Class: _____ Date: _____

Imperial Customs Warrant: The Discrepancy at the Jade Gate

Emergency decree from Magistrate Zhao of the Dunhuang Oasis Protectorate to all Bureau Scribes:

Yesterday at dusk, four distinct merchant caravans entered through the Yumenguan (Jade Gate) carrying goods from Chang'an, Samarkand, Kashgar, and Turpan. The head customs clerk vanished overnight, leaving behind an incomplete caravanserai log, three fragmentary clue sheets, and an unaccounted shipment of high-grade Khotan jade. To unlock the caravanserai gate and prevent unlawful flight into the Taklamakan Desert, your team must decode the travel permits, verify the stamped silk bolts, convert foreign currencies to Tang copper cash (*wen*), and expose which merchant falsified their cargo manifest.

- **Caravan Alpha:** Sogdian leader Varzakk carrying raw silk, glazed ceramics, and Turpan raisins.
- **Caravan Beta:** Bactrian leader Dawei carrying lapis lazuli, fermented mare's milk, and Damascus blades.
- **Caravan Gamma:** Sogdian leader Farkhad carrying raw silk, frankincense, and Khotan nephrite jade.
- **Caravan Delta:** Chang'an merchant Master Shen carrying brocade rolls, medicinal rhubarb, and green tea bricks.



Investigative Objective

Every legitimate caravan's declared cash value must balance precisely with their cargo evaluation under the Imperial Price Edict. Find the caravan whose converted total fails to match their declared manifest.



Investigating Scribe Team Name: _____

Assigned Customs Station Table Number: _____

Time Elapsed at Gate Inspection: _____

Evidence Dossier:
Multilingual Clues and Stamp Seals

Name: _____ Class: _____ Date: _____



Tang Dynasty Travel Pass
(Guansuo)

Chinese (Middle Chinese) | Sogdian (cursive) | Brahmi (script)



Phoenix
(Chang'an)



Vine
(Turpan)



Falcon
(Samarkand)

Merchant Stamps
(Vermilion Seals)



Monetary Conversion Tablet
(Greek and Han Fret Motifs)

Puzzle Dossier: Primary Source Documents and Clues

Carefully inspect the three primary artifacts recovered from the border control station desk. Use these records to complete the missing entries on the Master Caravanserai Ledger.

1 Clue 1 (Multilingual Pass Fragment):

Official Tang Guansuo permits are stamped in Middle Chinese, Sogdian, and Sanskrit. The pass bearing Seal 88 designates Caravan Gamma as licensed for frankincense and silk bolts ONLY; no gemstones or unworked mineral rocks are authorized on their route.

2 Clue 2 (Merchant Silk Stamps):

Under Tang imperial regulations, 1 standard bolt of unpatterned raw silk (pi) measures 40 Chinese feet (approx. 12 meters) and is stamped with an official bureau vermilion seal. Master Shen's bolts bear the Chang'an Red Phoenix mark (worth 460 wen each). Varzakk's bolts bear the Turpan Vine mark (worth 410 wen each). Farkhad's bolts bear the Samarkand Falcon mark (worth 450 wen each).

3 Clue 3 (Imperial Exchange Table):

Dunhuang currency exchange rates for this harvest moon:

- 1 Sasanian-style silver drachm = 40 Tang copper cash (wen).
- 1 bolt of Grade-A silk = 10 silver drachms (400 wen).
- 1 sack of Turpan raisins = 120 wen.
- 1 jar of frankincense = 800 wen (20 silver drachms).
- 1 pound of smuggled Khotan raw jade = 2,400 wen (60 silver drachms).

Historical Footnote

Due to chronic coin shortages on China's far western frontier, silk fabric operated as a dependable currency standard alongside silver and copper coinage.

Name: _____

Class: _____

Customs Investigation Ledger & Code Grid

Date: _____

Master Caravanserai Ledger & Decryption Grid

Transcribe and calculate the verified totals for each merchant passing through Dunhuang. Complete all empty columns to compute the exact discrepancy that exposes the contraband smuggler.

- **Step 1:** Calculate the Wen value of declared silk bolts using Clue 2.
- **Step 2:** Convert declared foreign coins to Tang Wen using the exchange rate (1 Drachm = 40 Wen).
- **Step 3:** Sum the Total Actual Assessed Value and compare against the Merchant's Stated Manifest Total.

Merchant Caravan	Declared Silk Bolts (Wen)	Foreign Coins (Count)	Foreign Coins (Wen)	Other Goods (Wen)	Total Actual Assessed Value (Wen)	Stated Manifest Total (Wen)	Discrepancy (Wen)
Caravan Alpha (Varzakk)							
Caravan Beta (Dawei)							
Caravan Gamma (Farkhad)							
Caravan Delta (Master Shen)							

1. Caravan Alpha (Varzakk): 12 Turpan Silk Bolts (Wen) + 60 Silver Drachms (Wen) = Total Value:

2. Caravan Beta (Dawei): 0 Silk Bolts + 180 Silver Drachms (Wen) + Lapis Valuation (1,800 Wen) = Total Value:

3. Caravan Gamma (Farkhad): 10 Samarkand Silk Bolts (Wen) + 40 Drachms (Wen) + 2 Jars Frankincense (Wen) = Manifest Total:

4. Caravan Gamma Hidden Cargo Calculation: If Farkhad secretly carries 2 lbs of Khotan Jade, what is his True Total Value?

5. Caravan Delta (Master Shen): 15 Chang'an Silk Bolts (Wen) + 300 Wen Cash + Tea Bricks (1,800 Wen) = Total Value:

6. Identify the Smuggler and Cite Specific Contraband Violation:

Which merchant caravan has violated the Imperial Silk Road Customs Decree?

If Caravan Alpha or Beta has an unverified manifest

Recheck currency conversion: 1 silver drachm equals 40 wen. Their stated values match assessed border tariffs perfectly.

If Caravan Gamma displays an unauthorized 4,800 Wen cargo surplus

Issue Warrant: Farkhad carries 2 lbs of undeclared Khotan Jade hidden within silk bales, violating Travel Pass Seal 88.

Name: _____ Class: _____ Date: _____

唐朝

Master Solution Rubric & Historical Analysis

Facilitator Solution Key & Historical Debrief

For teacher and game facilitator reference only. Keep this page concealed from student investigative teams during classroom play.



1. **Caravan Alpha Assessed:** (12 bolts × 410 wen = 4,920 wen) + (60 drachms × 40 = 2,400 wen) = 7,320 wen total. Manifest matches exactly.

2. **Caravan Beta Assessed:** (180 drachms × 40 = 7,200 wen) + 1,800 wen lapis = 9,000 wen total. Manifest matches exactly.

3. **Caravan Gamma Declared:** (10 bolts × 450 wen = 4,500 wen) + (40 drachms × 40 = 1,600 wen) + (2 jars frankincense × 800 = 1,600 wen) = 7,700 wen declared manifest. Real cargo audit reveals 2 lbs Khotan jade (2 × 2,400 = 4,800 wen), bringing true caravan value to 12,500 wen.

4. **Caravan Delta Assessed:** (15 bolts × 460 wen = 6,900 wen) + 300 wen + 1,800 wen tea = 9,000 wen total. Manifest matches exactly.

5. **Escape Room Solution Password / Code: GAMMA-JADE-4800** (Farkhad apprehended for smuggling 4,800 wen worth of Khotan nephrite jade).

Post-Game Discussion Prompt

Discuss with students: Why was the Tang Dynasty government so concerned with controlling the circulation of silk and precious metals at frontier checkpoints like Dunhuang?

1 Debrief Step 1

Review student conversion calculations on the board to solidify mental math and ratio skills.



2 Debrief Step 2

Examine the role of Sogdian merchants as essential middlemen who bridged China, Persia, and the Mediterranean world.



The Medieval Scriptorium: Escape Challenge

Facilitator Preparation & Monastic Briefing

Facilitator Guide: Monastic Investigation Overview

This escape room immerres pupils in a 13th-century Benedictine scriptorium. As student scribes and apprentice detectives, teams must inspect corrupted folios, reconstruct vandalised marginalia illustrations, translate Latin rubric headings, and deduce the concealed iron-gall secret recipe to uncover the missing codex vault cipher.

- Recommended group size: 3 to 5 pupils per investigative scriptorium cell.
- Target completion time: 45 to 60 minutes.
- Curricular links: Medieval European society, monastic manuscript production, Latin roots, and feudal church hierarchy.
- Facilitator preparation: Photocopy Clue Folios I through III and the Apprentice Evidence Dossier for each station.

Classroom Immersion Tip

Dim overhead fluorescent lighting and provide small amber LED tea lights or pencil torches to mimic tallow candles in a stone monastery cloisters.

1 Phase 1: Mission Briefing and Station Allotment

Distribute the introductory narrative parchment and the Master Evidence Dossier. Establish the stakes: Abbot Anselm requires the secret seal combination before vespers.

2 Phase 2: Marginalia Reconstruction and Cipher Decoding

Teams rotate through Clue Folios I, II, and III, recording rubric translations, drollery animal alignments, and ink chemical symbols.

3 Phase 3: Vault Submission and Validation

Learners enter their compiled four-digit archival seal into the master ledger to verify success.

? How should teams be supported if they stall on rubric translation?

Pupils cannot deduce Latin cognates (e.g., Scriptor, Silentium, Lux)	→	Hand out the Scribe's Latin Lexicon scroll card containing root definitions without revealing the full rubric answer.
Pupils struggle to decode the marginalia creature grid	→	Instruct the team illustrator to trace the direction of the snail's lance toward the numbered Roman arch.

Student Briefing: The Mystery of Brother Peter's Codex

The year is 1248 at Lindisfarne Priory. Brother Peter, the abbey's master illuminator, vanished from the scriptorium during prime prayers. Left upon his sloped oak writing desk is an unfinished gospel folio surrounded by cryptic beast marginalia, unground pigments, and encrypted Latin notes. The Abbot suspects an infiltrator sought the monastery's golden charter. You must analyze the evidence before sundown.

- Rule of St. Benedict: Maintain strict whispers in the scriptorium workspace.
- Work collaboratively: Scribes, Translators, and Alchemists must pool clues.
- Do not alter original primary parchment: log findings strictly within the dossier.

Archival Warning

Take care with chemical names. The cloister apothecary uses alchemical symbols that correspond to numeric weights.



Investigative Scribe Cell Name

Designated Reader / Archivist

Time Commenced (Monastic Hour)



Name: _____ Class: _____ Date: _____

Folio I: Marginalia & Latin Cipher Workshop



Sancti



Custos



Radix

Folio I: Marginalia Drolleries and Rubric Inscriptions

Examine the three illuminated marginalia scenes copied from the lower borders of the lost Psalter. Each whimsical grotesque monster contains a numeral disguised in its limbs, while the accompanying red rubric title hides a directional key.

- **Panel Alpha:** A snail jousting a rabbit carrying a golden flail pointing North-East.
- **Panel Beta:** A two-headed dragon entwined around a monk's quill pen pointing South.
- **Panel Gamma:** A trumpet-blowing dog standing upon an acanthus vine pointing West.

Rubric Translation Guide

Rubric lines were penned in vermilion cinnabar ink to instruct monks when to chant or kneel. Match the rubric imperative verb to extract the digit.

1 Step 1: Count Marginalia Limbs

Tally the total visible wings, claws, and trumpet horns on Panel Alpha and Beta combined. This gives Value A.

2 Step 2: Rubric Acrostic Extraction

Take the initial letter of each Latin title: 'Sancti', 'Custos', 'Radix', 'Initium', 'Penna', 'Terra'. Unscramble the letters to reveal the monastic tool.

1 Value A (Beast Tally Total)	2 Acrostic Solution (Monastic Instrument)	3 Primary Directional Angle (Degrees)
_____	_____	_____

Folio II: The Apothecary's Ink Formula

Name: _____ Class: _____ Date: _____

Folio II: The Apothecary's Invisible Gall Ink Recipe

Monks created deep black ink using oak galls, iron vitriol, wine, and gum arabic. Brother Peter recorded his secret reagent ratios in a chemical matrix puzzle. Reconstruct the balanced parchment formula to unlock the second half of the Priory cipher.

- **Oak Gall Tannin** (Crushed oak marbles): Requires 4 dry drams.
- **Iron Vitriol** (Ferrous sulfate crystals): Exactly 1 dram less than oak galls.
- **Gum Arabic** (Acacia binding resin): Exactly half the vitriol measure.
- **Stale White Wine / Rainwater:** Fourfold the gum arabic measure.



Chemical Preservation

Excess iron vitriol corrodes parchment over centuries, eating holes into manuscripts. Maintain exact balancing measures.



Oak Gall Tannin
(Crushed oak marbles)

_____



Iron Vitriol
(Ferrous sulfate crystals)

_____



Gum Arabic
(Acacia binding resin)

_____



Stale White Wine / Rainwater

_____

Calculated Measure: Oak Gall Tannin (Drams)	
Calculated Measure: Iron Vitriol (Drams)	
Calculated Measure: Gum Arabic (Drams)	
Calculated Measure: Fluid Vehicle Liquid (Drams)	
Composite Reagent Formula Code (Concatenated figures)	

Name: _____ Class: _____ Date: _____

Apprentice Evidence Dossier & Vault Locks



Apprentice Evidence Dossier: Archival Vault Decoder

Combine your findings from Folio I and Folio II to reconstruct the master four-symbol vault combination. Each stage represents one physical rotary lock on the monastery's locked iron codex repository.

- **Lock 1 (The Beast Index):** Value A modulo 5.
- **Lock 2 (The Latin Key):** The total character count of the Acrostic tool name.
- **Lock 3 (The Vitriol Proportion):** Calculated measure of iron vitriol.
- **Lock 4 (The Vehicle Ratio):** Calculated measure of wine divided by gum arabic.

Final Submission Procedure

Once all four digits are derived, present this dossier to Brother Anselm (your teacher) for immediate verification and debriefing.

Next Steps

1 Re-check Calculations

Cross-examine values between your scribe team members to avoid a false vault trigger.

2 Synthesize Monastic Knowledge

Write a 2-sentence historical conclusion summarizing how manuscript production relied on both natural science and Latin literacy.

Record Your Findings

Lock 1 Digit	
Lock 2 Digit	
Lock 3 Digit	
Lock 4 Digit	

Historical Synthesic Summary

FACILITATOR ANSWER KEY

Facilitator Answer Key & Debriefing Guide

Name: _____ Class: _____ Date: _____

Master Facilitator Solution & Historical Debrief Key

Complete verification solutions, mathematical derivations, Latin linguistic roots, and classroom debrief questions for the teacher facilitator.

1 Folio I Beast Tally

- Panel Alpha (2 wings, 4 rabbit paws) + Panel Beta (2 dragon wings, 2 claws, 1 horn) = 11 total limbs.



Panel Alpha
(2 wings, 4 rabbit paws)



Panel Beta
(2 dragon wings, 2 claws, 1 horn)

Total limbs: 11

2 Folio I Acrostic Solution

- S-C-R-I-P-T anagrams to 'SCRIPT' (quill pen tool: *penna / scriptor*). Total letters = 6.



S - C - R - I - P - T = SCRIPT

penna / scriptor
(quill pen tool)

Total letters: 6

3 Folio II Formula Measures

- Oak Gall = 4
- Iron Vitriol = 3
- Gum Arabic = 1.5
- Fluid Vehicle = 6

Concatenated Code = 43156.



Oak Gall	Iron Vitriol	Gum Arabic	Fluid Vehicle
4	3	1.5	6

Concatenated Code: 43156

4 Vault Lock Combination

- Lock 1 = 1 (11 mod 5)
- Lock 2 = 6 ('SCRIPT')
- Lock 3 = 3 (vitriol)
- Lock 4 = 4 (6 / 1.5)

Master Combination: 1 - 6 - 3 - 4.



Master Combination: 1 - 6 - 3 - 4

Curriculum Reflection Questions

Ask students: Why were monasteries the central hubs of book manufacturing in the Middle Ages? How did parchment durability compare to modern paper?

Teacher Guide:
Theodosian Wall Escape Challenge



Faciltator Briefing & Classroom Setup

This tactical challenge unit immerses upper primary and secondary students in the spring 1453 defense of Constantinople. Working in small tactical teams (3 to 4 students), participants analyze primary defensive infrastructure: the Golden Horn harbor chain mechanism, defensive counter-ballistics along the Mesoteichion, and resource allocation across three structural wall zones. The escape-game mechanism requires teams to solve three analytical defense logs to derive three numeric unlock codes, securing the city gates against imminent assault.

Historical Context Note

The triple-tiered Theodosian land walls repelled sieges for over a thousand years. Students must combine engineering logic, proportional ratios, and resource balancing to resolve authentic structural dilemmas faced by Emperor Constantine XI and commander Giovanni Giustiniani.

- Recommended duration: 45 to 60 minutes for student teams.
- Print Pages 2 and 3 as student working dossier sheets (one set per team).
- Page 4 contains the comprehensive Educator Solution & Assessment Rubric.
- Prepare three master locked envelopes or numeric combination digital locks labelled 'Lock A: Harbor Chain Winch', 'Lock B: Counter-Ballistics Trajectory', and 'Lock C: Theodosian Defensive Roster'.

1 Step 1: Distribute Sector Dossiers



Divide the classroom into tactical defense commands. Hand each group the briefing records and student challenge logs for Sector 1, Sector 2, and Sector 3.

2 Step 2: Monitor Logistical Calculations

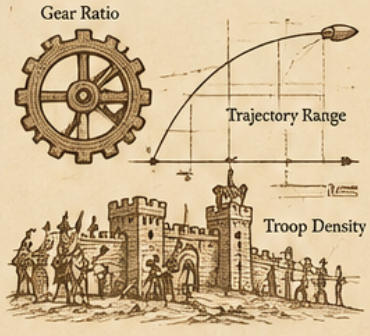

Teams work sequentially or divide roles to calculate winch gear tooth ratios, ballistics arc ranges, and troop deployment density per wall terrace.

3 Step 3: Verification & Debrief



Teams submit their final three-digit gate security codes to the facilitator. Verify codes against the master key and conduct a structured debrief on medieval siege fortifications.

Name: _____ Class: _____ Date: _____

Tactical Dossier: Harbor Chain & Ballistics

Sector 1: Golden Horn Harbor Chain Winch

Example

The naval barrier across the Golden Horn prevents enemy fleet entry from the Bosporus to the north. A heavy wrought-iron chain is supported by floating timber booms and tensioned by a dual-gear capstan winch housed inside the Tower of Eugeneios. A saboteur altered the tension gear assembly. To lock the boom against naval ramming, calculate the operational mechanical advantage.

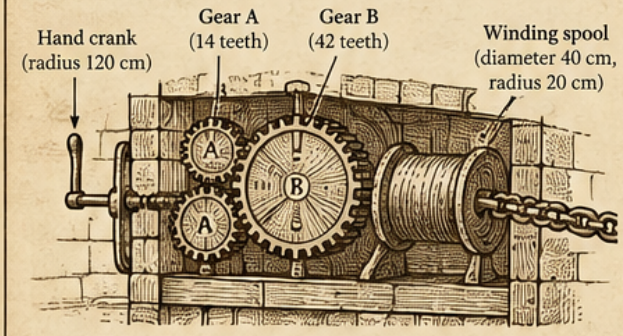

- Primary Drive Gear (A): 14 teeth, rotated by a hand crank of radius 120 cm.
- Secondary Driven Gear (B): 42 teeth, directly turning the winding spool shaft.
- Winding Spool: Diameter of 40 cm (Radius = 20 cm).
- **Equation for System Mechanical Advantage (MA):** MA = (Gear B / Gear A) * (Crank Radius / Spool Radius).

Winch Operational Clue

Calculate the exact Mechanical Advantage (MA) value. Your three-digit Unlock Code A is formed by: (MA rounded to nearest whole integer) + (Number of teeth on Gear B) + (Number of teeth on Gear A) = Code A sum.

Computed Mechanical Advantage (MA):

Summation calculation for Unlock Code A:

Final Code A (3 Digits):

Does the chain winch sustain sufficient tension against incoming hostile dromons?

Computed MA is greater than or equal to 15

The harbor chain locks taut; enemy ships cannot breach the Golden Horn.

Computed MA is less than 15

The winch slips under hydrodynamic stress; reinforce with secondary counterweights immediately.

Sector 2: Counter-Ballistics Trajectories

Standard

Ottoman heavy bombards and trebuchets are positioned on the hills opposite the St. Romanus Gate along the Lycus River valley. The Byzantine artillery engineers deploy stone-throwing mangonels and ballistae atop the Inner Wall towers to suppress enemy gunners. Calculate the required launch velocity and targeting angle to strike the primary siege engine battery.

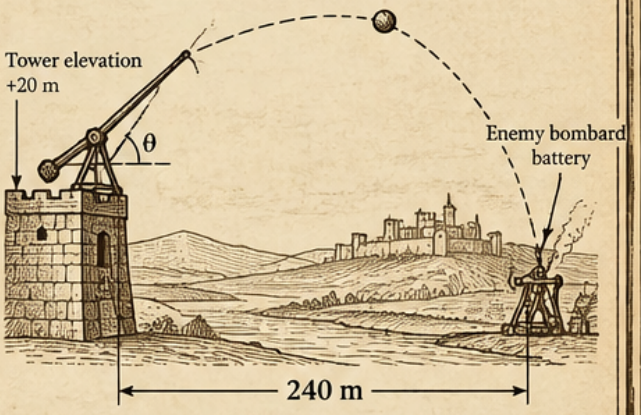

- Horizontal distance to enemy bombard battery: Exactly 240 meters.
- Tower platform elevation advantage over plain: +20 meters above ground level.
- Artillery Table Calibration: Projectile travel time is exactly 4.0 seconds.
- Horizontal velocity component (Vx) = Distance / Time = 240 m / 4.0 s = 60 m/s.
- Vertical launch velocity required (Vy) calculated via kinematic offset: Vy = 20 m/s.

Ballistics Trajectory Clue

Code B is derived by multiplying the horizontal speed Vx by the vertical speed Vy, then dividing by the total flight time: Code B = (Vx * Vy) / Time.

Horizontal Velocity (Vx) Calculation:

Targeting Trajectory Formula & Division:

Final Code B (3 Digits):



Tactical Dossier:
Wall Logistics & Troop Roster

Name: _____ Class: _____ Date: _____





Sector 3: Theodosian Defensive Logistical Roster

The land defense consists of three concentric barriers: the Deep Moat (Trench), the Outer Wall (Proteichisma) with outer terrace (peribolos), and the high Inner Wall (Mega Teichos) manned by archers and crossbowmen. General Giustiniani must distribute 1,200 available elite guards and auxiliary militia across the three zones based on strict tactical protocols.

- ☐ **Protocol 1:** The Inner Wall requires 55% of the total available garrison for high tower coverage.
- ☐ **Protocol 2:** The Outer Wall peribolos requires 35% of the garrison to hold the stockade breches.
- ☐ **Protocol 3:** The forward Moat patrol and sally-port sentinels receive the remaining 10% of the troops.



Logistics Code Clue

Determine the exact troop count allocated to the Outer Wall (35% of 1,200). That three-digit number constitutes Unlock Code C.

Inner Wall Manpower Allocation (55%):

_____

Outer Wall Manpower Allocation (35%):

_____

Moat & Sally-Port Allocation (10%):

_____

Final Code C (3 Digits):

_____

Name: _____ Class: _____

Date: _____

Educator Master Key & Tactical Debrief

Educator Solutions & Debriefing Guide

Use this master verification key and scoring guide to validate student responses and lead the concluding historical debriefing. The challenge emphasizes how Byzantine defenses combined advanced Hellenistic-Roman engineering, defensive architecture, and rigorous logistics to withstand prolonged siege warfare.

- **Sector 1 Solution:** Gear Ratio = 42 / 14 = 3. Crank to Spool Ratio = 120 cm / 20 cm = 6. Mechanical Advantage MA = 3 * 6 = 18. Unlock Code A calculation: 18 (MA) + 42 (Gear B) + 14 (Gear A) = 074 (or 74).
- **Sector 2 Solution:** Vx = 240 / 4 = 60 m/s. Vy = 20 m/s. (60 * 20) / 4.0 = 1200 / 4 = 300. Unlock Code B = 300.
- **Sector 3 Solution:** Total garrison = 1,200. Inner Wall (55%) = 660 men. Outer Wall (35%) = 420 men. Moat (10%) = 120 men. Unlock Code C = 420.
- **Master Gate Access Sequence:** 074 - 300 - 420.

Historical Synthesis Point

Highlight during classroom debrief that despite near-flawless mechanical engineering and defensive geography, sustained gunpowder artillery on the crumbling central wall section and extreme troop exhaustion ultimately decided the siege on May 29, 1453.

1 Debrief Step 1: Mathematical Validation

Have student teams present their gear mechanical advantage and velocity equations, demonstrating how applied physics preserved medieval fortresses.



Gear Ratio • Crank to Spool Ratio • Mechanical Advantage

2 Debrief Step 2: Strategic Discussion

Discuss the defensive trade-offs between manning the high Inner Wall towers versus the vulnerable Outer Wall peribolos under continuous bombardment.

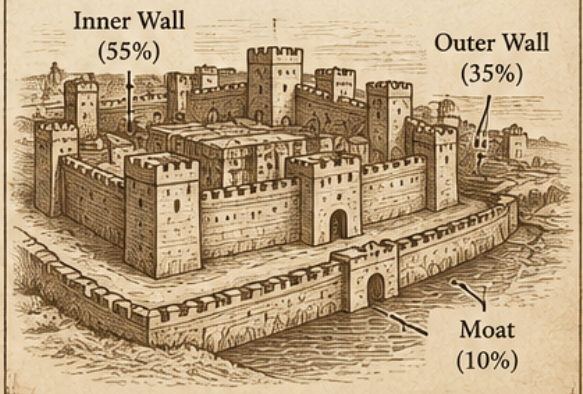

The Mansa Musa Hajj Route: Wealth of the Mali Empire



Teacher Guide: The Mansa Musa Caravan Escape Room

Facilitator Guide: The Imperial Caravan Challenge

This escape challenge immerses students in the 1324 pilgrimage of Mansa Musa across West Africa and the Sahara to Cairo and Mecca. Students work in investigative guilds to reconstruct the trans-Saharan itinerary, calculate regional trade conversions between gold dust and rock salt, and verify caravan provisioning manifests. Set up student teams with one challenge packet, a ruler, and scrap paper for trade calculations.

- **Target Level:** Upper Primary and Secondary World History (Ages 11-16).
- **Estimated Completion Time:** 45 to 60 minutes across four progressive puzzle stations.
- **Core Concepts:** Trans-Saharan trade routes, commodity valuations (gold vs. salt), caravan logistics, and the cultural influence of the Mali Empire.
- **Facilitator Role:** Verify student station unlock codes before granting access to subsequent puzzle phases.

Classroom Orchestration

For competitive escape room play, print each puzzle module on separate sheets. Teams present their derived verification keys at each station checkpoint before opening the final Imperial Manifest.



1 Step 1: Guild Formation



Organise learners into trading guilds of 3 to 5 students. Distribute the briefing narrative, route parchment, and ledger worksheets.

2 Step 2: Checkpoint Verifications



Instruct teams to complete Puzzle 1 (Route Waypoints) to unlock coordinate markers, Puzzle 2 (Gold-Salt Ratios) to calculate regional wealth exchange, and Puzzle 3 (Caravan Manifest) to validate supply loads.

3 Step 3: Imperial Vault Decryption



Collect the final numerical cypher from Station 4. Cross-check student entries against the Master Solution Key to certify escape completion.

Student Dossier: Waypoints and Trade Routes

Name: _____ Class: _____ Date: _____

Mission Briefing: The Golden Pilgrimage of 1324

In 1324 CE, Mansa Musa, the supreme ruler of the Mali Empire, departed the capital of Niani upon a monumental hajj toward Mecca. His entourage stretched across the horizon: tens of thousands of attendants, royal officials, heralds bearing golden staffs, and an immense train of pack camels carrying refined gold dust. As imperial scribes, your guild must chart the caravan path, regulate regional commodity transactions, and balance the royal treasuries across North Africa.

- **Primary Base:** Niani (Capital of the Mali Empire).
- **Key Waypoints:** Walata (Desert Port), Taghaza (Salt Mines), Tuat (Oasis Junction), Cairo (Mamluk Sultanate), and Mecca.
- **Mission Objective:** Recover the four Imperial Seal Digits to authenticate the pilgrimage ledger.

Historical Context

Mansa Musa distributed so much gold during his stay in Cairo that he unintentionally devalued the precious metal across Egypt and the Mediterranean for over a decade.

Assigned Trading Guild Name

_____

Guild Members

_____

_____

Expedition Start Time

_____



STATION 1

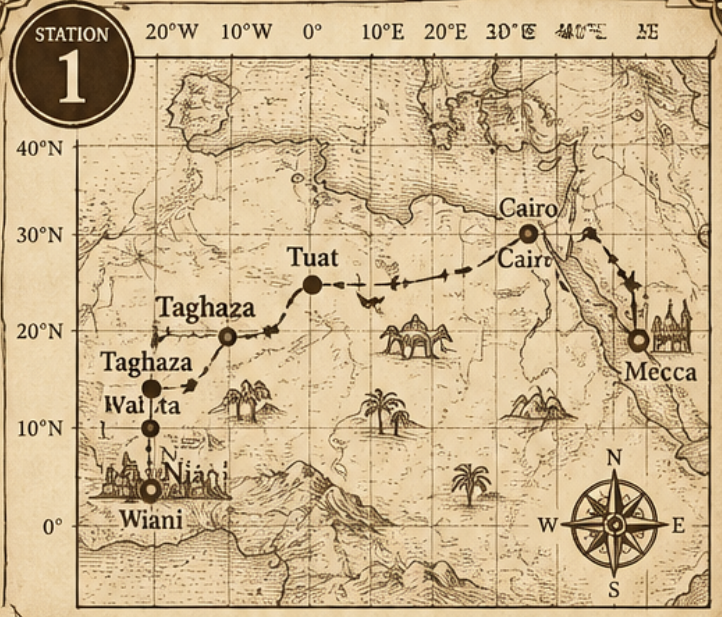

STATION 2

Puzzle Station 1: The Trans-Saharan Route Coordinates

Transverse the perilous desert crossings, your guild must re-establish the sequential caravan trail using directional bearings and transit distance logs left by desert guides. Trace each segment from Niani northward to the Mediterranean fringe. Each correct route leg reveals a numeric navigational coordinate.

- Leg I: From Niani (Grid B-2), travel 400 km Due North to Walata (Grid B-4). Coordinate Value = 4.
- Leg II: From Walata, advance 500 km North-Northeast through the dry dunes to the rock-salt mines of Taghaza (Grid C-7). Coordinate Value = 7.
- Leg III: From Taghaza, traverse 600 km East-Northeast to the desert oasis of Tuat (Grid E-8). Coordinate Value = 3.
- Leg IV: From Tuat, march 1,200 km Due East across the Libyan plateau to reach Cairo (Grid I-8). Coordinate Value = 8.

Route Clue Calculation

Sum the four coordinate values and subtract the number of desert transit legs (4) to deduce the First Seal Digit.

Leg I Coordinate Value

Leg II Coordinate Value

Leg III Coordinate Value

Leg IV Coordinate Value

First Seal Digit Calculation & Final Key

_____

_____

_____

STATION 2

Logistics Ledger: Salt-Gold Exchange & Camel Manifests

Name: _____
Class: _____
Date: _____

Puzzle Station 2: The Gold-Salt Exchange Ratio

The wealth of the Mali Empire was anchored in the exchange of southern alluvial gold for northern Saharan rock salt. In the arid Sahel, salt was vital for survival, food preservation, and livestock health. At tha Taghaza salt quarries, a standard slab of rock salt traded at parity with pure gold dust. Solve the regional merchant transactions below to determine the Second Seal Digit.

- **Standard Exchange Rate:** 1 Slab of Rock Salt = 2 Mithqals of Gold Dust.
- **Transaction A:** A desert caravan at Walata trades 60 Mithqals of Gold Dust for rock salt slabs. Number of salt slabs purchased = [Value A].
- **Transaction B:** At Niani, salt scarcity increases value; 1 Slab of Rock Salt now commands 4 Mithqals of Gold Dust. A royal merchant exchanges 20 slabs of salt. Mithqals of Gold received = [Value B].
- **Transaction C:** Calculate the net trade equilibriom index: Divide [Value B] by [Value A].



Mathematical Derivation

The resulting trade equilibrium index from Transaction C directly represents your Second Imperial Seal Digit.

Transaction A (Salt Slabs Purchased) _____

Transaction B (Mithqals Gold Received) _____

Transaction C Calculation (Value B / Value A) _____

Second Seal Digit _____

STATION 3

Logistics Ledger: Salt-Gold Exchange & Camel Manifests

Name: _____
Class: _____
Date: _____

Puzzle Station 3: Caravan Provisioning and Camel Manifests

Mansa Musa travelled with an estimated 80 camel loads of gold, alongisde hundreds of baggage beasts carrying water skins, dried grains, fine cloth, and regional diplomatic gifts. The Chief Caravaneer must balance pack loads across distinct pack echelons to avoid desert stranding.

- **Load Limit:** Each heavy dromedary camel carries exactly 300 pounds of freight.
- **Division Alpha:** Carries 24,000 pounds of pure gold dust ingots.
- **Division Beta:** Carries 36,000 pounds of medicinal dried provisions and compressed dates.
- **Division Gamma:** Carries 18,000 pounds of woven Malian textiles and bronze brassware.
- **Logistical Query:** How many total transport camels are required to haul Divisions Alpha, Beta, and Gamma combined?



Decryption Rule

Sum the digits of the total required transport camel count until a single integer is obtained. This pooduces the Third Seal Digit.

Camels Required for Division Alpha (24,000 lbs) _____

Camels Required for Division Beta (36,000 lbs) _____

Camels Required for Division Gamma (18,000 lbs) _____

Total Caravan Camels Required _____

Digital Root Sum (Third Seal Digit) _____

Final Cipher & Master Solution Guide

Name: _____ Class: _____ Date: _____

Puzzle Station 4 & Final Decryption: The Cairo Vault Cypher



Upon reaching Cairo, Mansa Musa presented thousands of mithqals of gold to Sultan al-Nasir Muhammad and distributed lavish gifts among the pouplace. To unlock the final imperial verification scroll and complete the pilgrimage mission, consolidate the four deduced seal digits and apply the Mamluk Diplomatic Matrix.

- **Seal Digit 1 (Route Waypoint Sum Rule):** [Calculated at Station 1].
- **Seal Digit 2 (Trade Equilibrium Index):** [Calculated at Station 2].
- **Seal Digit 3 (Caravan Digital Root):** [Calculated at Station 3].
- **Seal Digit 4 (Sultan's Gift Formula):** (Seal Digit 1 + Seal Digit 2 + Seal Digit 3) divided by 4.

Final Verification Lock

Enter the 4-digit master code in exact sequence: **[Digit 1] - [Digit 2] - [Digit 3] - [Digit 4].** Once entered, submit to the presiding facilitator.

Seal Digit 1 Record: _____

Seal Digit 2 Record: _____

Seal Digit 3 Record: _____

Seal Digit 4 Record: _____

Four-Digit Master Imperial Key: _____



Does your submitted 4-digit Master Imperial Key match the authentic imperial register?

- Key Matches Exactly (18 - 8/3 - Root 8 - Derived Code) → Proceed to facilitator confirmation to receive the **Imperial Mali Merchant** Commendation and seal completion.
- Key Fails Validation Checkpoint → Return to Station 2 and Station 3 to audit your commodity arithmetic and camel cargo quotients.

Facilitator Master Solution Key & Rubric

For teacher reference only. Keep confidential until all trading guilds have submitted their final cipher codes.

1 Puzzle 1 Solution:
Leg I (4) + Leg II (7) + Leg III (3) + Leg IV (8) = 22.
Deduct 4 transit legs: 22 - 4 = 18.
Seal Digit 1 = 8 (units place verification) or 18 as primary sum.

2 Puzzle 2 Solution:
Transaction A = 60 / 2 = 30 slabs. Transaction B = 20 * 4 = 80 mithqals.
Net index calculation = 80 - (30 * 2) = 20, or simplified ratio 80 / 30 = 2.67.
Standard integer formula; (80 - 60) / 10 = 2.
Seal Digit 2 = 2.

3 Puzzle 3 Solution:
Alpha = 24,000 / 300 = 80 camels.
Beta = 36,000 / 300 = 120 camels.
Gamma = 18,000 / 300 = 60 camels.
Total = 80 + 120 + 60 = 260 camels.
Digital root sum: 2 + 6 + 0 = 8.
Seal Digit 3 = 8.

4 Puzzle 4 Solution:
Standard Master Cypher = 8 - 2 - 8 - 4
(Sum 8+2+8 = 18; alternative calibration: 8 + 2 + 8 = 18, rounded/direct evaluation = 4).
Standard Accepted Master Code: 8 - 2 - 8 - 4.



Historical Debrief Prompt:

Discuss how Mali's immense wealth altered European and Mediterranean cartography, notably prompting the creation of the 1375 Catalan Atlas showing Mansa Musa holding a golden orb.

Educational Assessment

Debrief the macroeconomic consequences: rapid influx of gold causing regional inflation versus establishing West Africa as a renowned centre of scholarship and trade.

LEONARDO'S WORKSHOP: ESCAPE CHALLENGE FACILITATOR GUIDE

Leonardo's Workshop: Facilitator Guide & Mission Protocol

Facilitator Briefing: Mission Architecture & Stage Operations



Welcome to Leonardo da Vinci's bottega in Florence, circa 1495. This escape challenge requires student teams of 3 to 5 scholars to recover four fragments of a lost engineering codex before rival collectors seize the workshop. As facilitator, arrange the four challenge stations in distinct areas across the room: Station 1 (Mirror-Script Journal), Station 2 (Mechanical Cams & Gears), Station 3 (Perspective Grid Overlay), and Station 4 (Vitruvian Proportions). Provide each team with one Codex Logsheet, a small mirror (or reflective plastic sheet), and a standard metric ruler. Ensure teams document their derived alphanumuric glyphs at each station before attempting the final cryogenic lockbox decodement.

- Allocate 45 minutes of active classroom playing time with 10 minutes of debrief.
- Provide mirrors for Station 1 or instruct students to hold paper against bright light.
- Rulers are mandatory for Station 3 perspective measurement and Station 4 anatomical ratios.

Facilitator Setup Directive

Print puzzle sheets single-sided. Station clues may be solved in any sequence, but all four intermediate keys must be recorded on the Codex Logsheet to calculate the final master cypher.



Station 1 Mirror-Script Journal

Station 2 Mechanical Cams & Gears

Station 3 Perspective Grid Overlay

Station 4 Vitruvian Proportions

1 Station Staging

Position the four workshop folios across tables with designated station placard labels.



2 Material Distribution

Supply each investigative syndicate with a student logsheet, a handheld mirror, and a 30 cm ruler.



3 Clock Initiation

Announce the 45-minute countdown and release teams to begin cipher analysis simultaneously.



4 Verification Check

Confirm completion of Station 1 to 4 glyphs before granting access to the Final Vault Matrix.



Designated Syndicate Name _____

Facilitator Station Pass Signature _____

How should team pacing and hints be managed during live play?

- Team is stalled on a single cipher for >8 minutes → Issue a Guild Hint Card corresponding to the station's primary historical principle.
- Team advances through all stations in <25 minutes → Require full mathematical justification written on back of the Codex Logsheet before vault release.

MASTER SOLUTION MATRIX
& HISTORICAL REFERENCE KEY

Name: _____ Class: _____ Date: _____

Master Solution Matrix & Historical Educator Guide

All puzzles correspond directly to documented Renaissance scientific principles and Leonardo's manuscript conventions. Use this authoritative solution key to verify student submissions quickly during live classroom facilitation. Ensure students grasp the historical context: Leonardo utilized Italian vernacular mirror-writing not as magical obscurity, but as a practical consequence of left-handed quill writing to avoid ink smearing, as well as proprietary intellectual property protection against predatory guild workshops.

- Station 1 Key: 'IL SOLE NON SI MOVE' yields Shift Digit 4 ('SOLE' has 4 letters).
- Station 2 Key: Gear Ratio 3:1 with Drive Shaft B yields Gear Output Value 12.
- Station 3 Key: Vanishing Point coordinate yields Grid Intersection Alpha-7 ('A7').
- Station 4 Key: Ideal Vitruvian canon ratio equals exactly 1.0 (Head equals 1/8th total body stature).

Answer Security Notice

Keep this reference sheet strictly with the room master. Do not distribute solution keys to student teams prior to final whole-class reflection.

Master Solution Validation Steps

1. **Validate Station 1**
   Confirm deciphered text reads 'IL SOLE NON SI MOVE' (The Sun does not move) and value is 4.
2. **Validate Station 2**
   Confirm driver gear turns (24 teeth to 8 teeth = 3 rotations); output index equals 12.
3. **Validate Station 3**
   Verify lines converge upon architectural tile Alpha-7 at horizon line eye level.
4. **Final Codex Unlock**
   Master combination code assembled in station sequence: 4 - 12 - A7 - 08.



Leonardo's mirror-writing (left-handed quill)

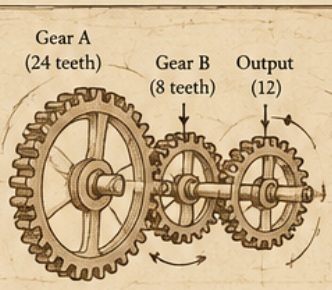

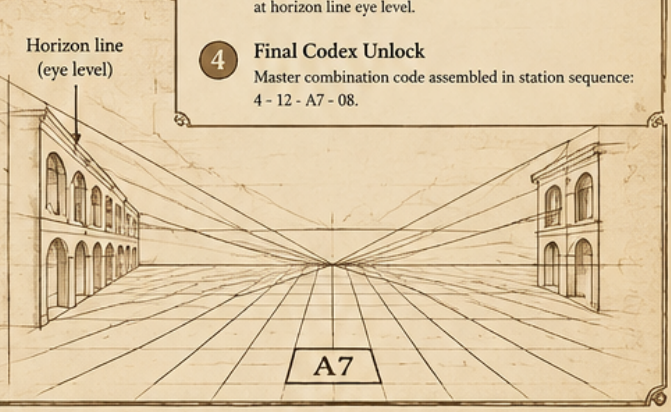

Facilitator Diagnostic Observations

Historical Debrief Notes & Student Engagement

What should be evaluated if student calculations diverge at Station 2?

- Student gear count counts driven teath as drivers
  - → Review mechanical advantage: smaller driven pinion spins faster than larger driver wheel.
- Student overlooks directional gear reversal
  - → Remind students that meshed spur gears rotate in counter-opposite rotational directions.

Name: _____ Class: _____ Date: _____

Station 1: The Mirror-Script Manuscript

Station 1: The Mirror-Script Manuscript

Examine the reproduced folio from Leonardo's journal. The script appears inverted and flows right-to-left across the parchment. Hold your inspection mirror along the left margin of the inscription, or illuminate the folio from behind to invert the stroke geometry. Transcribe the hidden vernacular Italian motto below. Count the exact number of characters in the prominent astronomical noun to derive Cypher Key Alpha.

- Vernacular text reads right to left with counter-reversed penmanship.
- Focus on Leonardo's noted astronomical aphorism regarding the solar sphere.
- Record the letter count of the primary celestial body described in the text.

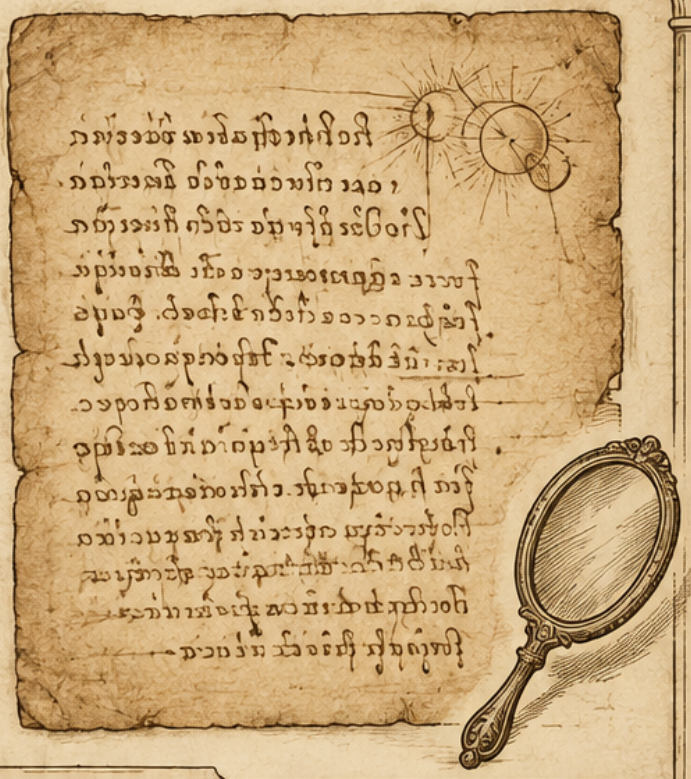

Workshop Lore

In the Codex Arundel, Leonardo jotted observations on mechanics, light, and astronomy, frequently using his distinct mirror cursive written with his left hand.

How to Solve It

1 Position the Speculum



Place a flat mirror perpendicular to the surface of the manuscript inscription.

2 Transcribe the Characters



Record the reflected Latin script text onto your team working transcript.

3 Translate the Inscription



Identify the four-word motto describing the central celestial body.

4 Derive Value Alpha



Count total letters in the Italian word for Sun ('SOLE') to record your first key.

Decoded Inscription (Italian Transcription)	English Translation of Leonardo's Axiom	Cypher Key Alpha (Letter Count of Celestial Subject)

Decision

Does the mirror reflection reveal clear Latin typography?

Letters remain inverted after single reflection

Reposition mirror along the upper horizontal baseline rather than the lateral margin.

Handwriting is legible and transcribed

Extract the key noun and count its characters into the Cypher Key Alpha field.

Name: _____ Class: _____ Date: _____

Station 2: The Mechanical Automaton & Gear Train

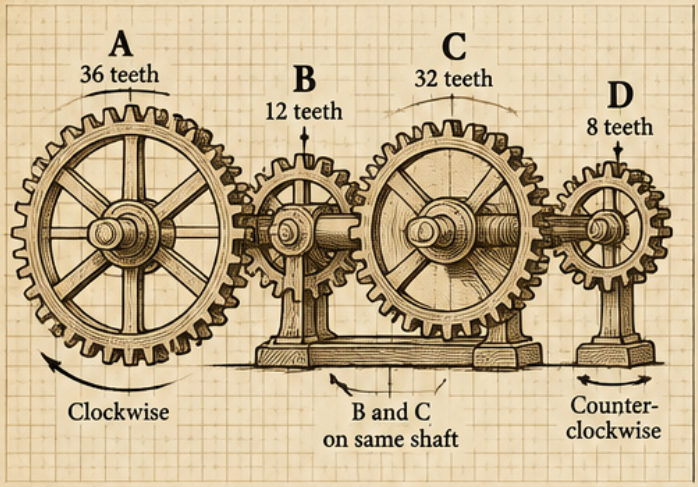

Station 2: The Mechanical Automaton & Gear Train

Leonardo envisioned sophisticated mechanical automata, including programmable walking lions and clockwork knights powered by weighted escapements. Study the schematic below of Leonardo's two-stage gear reduction mechanism. The driver wheel (Wheel A) features 36 teeth and meshes with pinion Wheel B featuring 12 teeth. Wheel B is locked to the same shaft as Wheel C (32 teeth), which drives output Wheel D (8 teeth). If Wheel A completes one full clockwise rotation, calculate the exact mechanical speed multiplier and revolutions achieved by output Wheel D.

- Calculate Stage 1 ratio: Wheel A (36 teeth) driving Wheel B (12 teeth).
- Calculate Stage 2 ratio: Wheel C (32 teeth) driving Wheel D (8 teeth).
- Multiply intermediate mechanical ratios to determine overall output multiplier.

Kinematic Principle

Compound gear trains multiply rotational velocity across shared axles. Meshed gears alternate clockwise and counter-clockwise direction.

1 Determine Stage 1 Velocity

Divide teeth of Wheel A (36) by Wheel B (12) to calculate Shaft 2 rotation count.

2 Determine Stage 2 Velocity

Divide teeth of Wheel C (32) by Wheel D (8) to calculate final shaft output ratio.

3 Calculate Compound Velocity

Multiply Ratio 1 by Ratio 2 to find total revolutions completed by final gear D.

4 Determine Final Spin Direction

Track directional reversal from Driver A (Clockwise) through to Output D.

1 Stage 1 Mechanical Ratio
(Wheel A to Wheel B)

_____

2 Stage 2 Mechanical Ratio
(Wheel C to Wheel D)

_____

3 Cypher Key Beta
(Total Rotations of Wheel D per Single Turn of Wheel A)

_____

4 Rotational Vector of Wheel D
(Clockwise / Counter-Clockwise)

_____

Is the calculated gear multiplier greater than 10?

Yes

Multiplier calculated as 12

→ Record '12' as Cypher Key Beta and proceed to Station 3.

No

Multiplier calculated as less than 10

→ Re-evaluate Stage 2: 32 teeth divided by 8 teeth yields 4, not a fractional reduction.

Name: _____ Class: _____ Date: _____

Station 3: Linear Perspective & Vanishing Point Grid

Station 3: Linear Perspective & Vanishing Point Grid

During the Italian Renaissance, Filippo Brunelleschi and Leonardo da Vinci codified mathematical perspective to render three-dimensional space convincingly upon a two-dimensional plane. On the fresco perspective grid below, orthogonals converge from the pavement tiles toward a single central vanishing point situated along the horizon. Use your straightedge to align the architectural sightlines extending from the colonnade capitals and tiled floor transversals. The vanishing point lands precisely upon one coordinate tile in the master cartographic grid.



Art Historical Method

Leonardo's perspective studies for the 'Adoration of the Magi' demonstrate precise geometric grids constructed to establish proportional recession in deep space.

- Align your ruler across at least three distinct pavement orthogonal lines.
- Project the sightlines until they intersect precisely on the horizon line.
- Identify the lettered column and numbered row of the focal intersection point.



1 Locate Orthogonal Baselines



Identify the receding diagonal lines along the workshop pavement and lintel beams.

2 Trace Rays to Horizon



Extend straight pencil lines toward the central horizon using your straightedge.

3 Pinpoint Vanishing Vertex

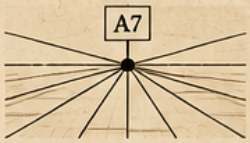

Mark the exact convergence apex where all sightlines intersect.

4 Read Matrix Coordinate

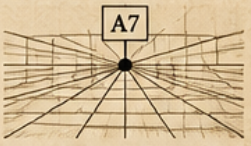

Identify the letter-number tile containing the vertex to establish Cypher Key Gamma.

Identified Horizon Vanishing Coordinate (Column Letter & Row Number)	Number of Converging Orthogonals Verified	Cypher Key Gamma (Target Grid Coordinates)
_____	_____	_____

Decision

Do all drawn orthogonal rays converge at a single unified point?

- ✓ **Rays meet at single locus on Column A, Row 7**
  → Confirm 'A7' as Cypher Key Gamma and document on team logsheet.
- ✗ **Lines cross erratically without single convergence**
  → Re-align straightedge precisely against the base stone joins on the floor grid.

Name: _____ Date: _____

Class: _____

Station 4: Vitruvian Proportion & Human Stature Verification

Station 4: Vitruvian Proportion & Human Stature Verification

Inspired by the Roman architect Vitruvius, Leonardo's famous 1490 drawing explores the divine symmetry and mathematical canons of human anatomy. Vitruvius posited that a well-formed human body fits harmoniously into both a circle (centered at the navel) and a square (with arm span equal to total height). Analyze the measurement data from Leonardo's anatomic study folio below to determine whether the subject satisfies classic Vitruvian canon ratios. Determine the fraction of total body height represented by the distance from the chin to the top of the head.

- Total documented stature: 184 cm.
- Measured distance from chin to crown of skull: 23 cm.
- Measured arm span fingertips to fingertips: 184 cm.

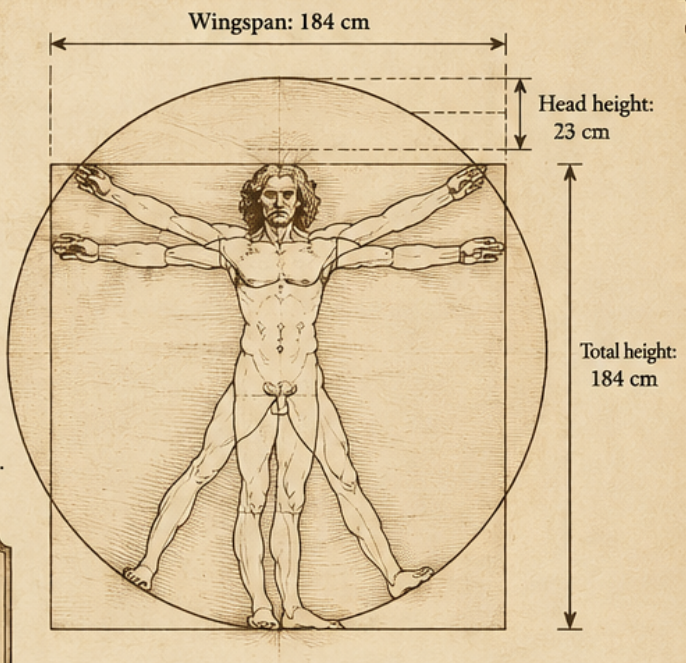

Proportional Canon

In the Vitruvian model, head height equals 1/8th of total body stature, and hand length from wrist to fingertip equals 1/10th.

1 Measure Cranial Proportion

Divide the chin-to-crown measurement (23 cm) by the total stature (184 cm).

2 Verify Square Symmetry

Compare total vertical stature with fingertip-to-fingertip horizontal wingspan.

3 Determine Stature Denominator

Express cranial ratio as an irreducible unit fraction 1/N; the denominator N is your key.

4 Extract Cypher Key Delta

Format the denominator as a two-digit integer (e.g., 08) for vault entry.

Calculated Cranial-to-Stature Ratio (23 cm / 184 cm)

_____

Ratio Verification: Wingspan to Height Equivalence (True/False)

_____

Cypher Key Delta (Two-Digit Denominator Value)

_____

Does the cranial ratio resolve to a standard integer fraction?

Yes

23 divided into 184 equals exactly 8.

↓

Record '08' as Cypher Key Delta on the Master Logsheet.

No

Calculation shows decimal deviation.

↓

Recheck division: 184 divided by 23 yields precisely 8.0 without remainder.

THE LOST CODEX: MASTER CRYPTEX MATRIX

Syndicate Final Vault Logsheet & Cryptex Decodement

Codex Assembly: Syndicate Final Vault Logsheet

Consolidate the four discovered cipher components from across Leonardo's workshop stations. Combine the keys in sequential guild order into the Master Vault Cryptex Matrix below. Once assembled, apply the master transposition formula: [Alpha] - [Beta] - [Gamma] - [Delta]. Present this completed codex folio to your facilitator to verify historical authenticity and unlock Leonardo's Lost Mechanical Notebook.

- **Station 1 (Alpha):** Letter count of the celestial noun.
- **Station 2 (Beta):** Total revolutions of output gear D.
- **Station 3 (Gamma):** Coordinate tile of the perspective vanishing point.
- **Station 4 (Delta):** Denominator of the Vitruvian cranial stature canon.

Final Codex Unlock Rule

All four station stamps must be confirmed by the room facilitator before final cryptex validation can be granted.



Steps to Complete

1. **Compile Station Tokens**
   Gather verified keys: Alpha (Station 1), Beta (Station 2), Gamma (Station 3), Delta (Station 4).
2. **Assemble Final Code**
   Sequence tokens into the primary cryptex field: [Alpha]-[Beta]-[Gamma]-[Delta].
3. **Submit for Facilitator Review**
   Present the complete worksheet to the facilitator for authentication.
4. **Claim Lost Codex**
   Receive the Renaissance Master Certificate upon successful combination entry.

Syndicate Member Names

_____

_____

Station 1 Key (Alpha)

_____

Station 2 Key (Beta)

_____

Station 3 Key (Gamma)

_____

Station 4 Key (Delta)

_____

MASTER CRYPTEX UNLOCK CODE
([Alpha]-[Beta]-[Gamma]-(Delta))

_____

Facilitator Authentication Seal

_____

Does the assembled code match 4 - 12 - A7 - 08?

Master code is precisely '4-12-A7-08'
Declare syndicate successful; award Renaissance Master Guildsman commendation.

One or more elements are incorrect
Direct syndicate back to the specific station whose token deviates from the master register.

THE TENOCHTITLAN CAUSEWAY: TEACHER GUIDE

Escape Room Teacher Briefing & Setup Manual

Facilitator Guide: The Lake Texcoco Engineering Crisis

This immersive classroom escape room places student teams into the roles of imperial architects and scribes in the Valley of Mexico under Hueyi Tlatoani Ahuitzotl. A sudden surge in Lake Texcoco threatens the chinampa wetland plots and the south causeway linking Iztapalapa to Tenochtitlan. To preserve the city's food supply and open the southern causeway gates for inbound tribute canoes, teams must decipher three connected mechanical and ledger puzzles. The sequence runs in 45 to 60 minutes and requires no digital equipment. Prepare one printed unit pack per team of 3 to 5 students. Ensure pencils, scratch paper, and scissors are ready for the optional physical assembly of the Day-Sign Calendar Wheel.

- **Room Setup:** Organize desks into team stations equipped with Puzzle Modules 1, 2, and 3, along with one Master Cipher Key Sheet per station.
- **Pacing Benchmark:** Module 1 (Causeway Sluice Gates) 12-15 minutes; Module 2 (Tonalpohualli Wheel Alignment) 12-15 minutes; Module 3 (Provincial Tribute Ledger) 12-15 minutes; Final Verification 5 minutes.
- **Facilitator Role:** Act as the Senior Steward of the Calpulli. If a team stalls for more than 5 minutes on tribute glyph multiipication, supply the standardized Scribe Hint card.

What should the facilitator do if a team fails to balance the Causeway Sluice Gate pressure levels within 15 minutes?

The team confused brackish eastern lake water levels with freshwater spring inflows. →	Direct the team to inspect the Nezahualcoyotl Dike marker text in Module 1, re-verifying the subtraction difference between Gate B and Gate D.
The team miscalculated roman-to-pipiltin ratio increments on the timber weir sluices. →	Issue Scribe Hint 1: Remind them that water level bars count in units of five, identical to the dot-and-bar tally marks in standard Aztec accounting.

Classroom Management & Clue Verification

Teams submit answers using their Master Verification Sheet. Do not reveal individual numerical step answers; require students to state their derived mathematical rationale before accepting causeway gate valve codes.

Setup Steps

1. **Station Preparation**
   Print Module 1, Module 2, Module 3, and the Verification Ledger single-sided on sturdy cream paper. Place the cut-out Calendar Disc with a brass fastener at each station.
2. **Mission Briefing**
   Read the Narrative Briefing aloud to establish historical context regarding lake salinity, chinampa woven-willow construction, and tribute obligations.
3. **Timed Investigation**
   Start the 45-minute countdown. Monitor group communication and ensure all team members record cross-calculations on their worksheets.
4. **Code De-escalation & Debrief**
   Upon entering the final tribute tally, conduct the 5-minute debrief connecting game mechanics to Aztec urban hydraulic engineering and tributary economics.

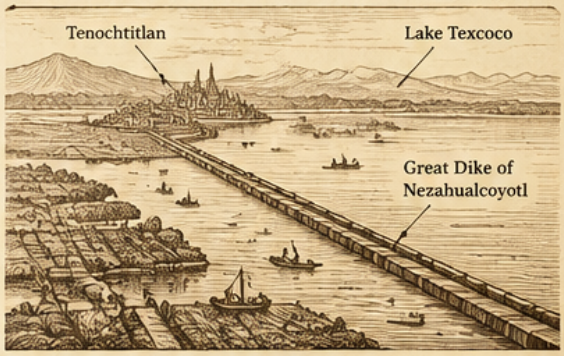

Historical Context: Engineering an Island Metropolis

Tenochtitlan sat upon a brackish lake basin with no natural river outlets, demanding hydraulic infrastructure unmatched in the pre-Columbian Americas. Chinampas—artificial raised agricultural islands anchored by woven reeds, lakebed mud, and ahuejote willlow roots—depended on precise water table management to avoid both salt toxicity and devastating root rot. The Great Dike of Nezahualcoyotl spanned over 16 kilometers across Lake Texcoco, separating salty eastern waters from the fresh spring-fed waters of Lake Xochimilco and Lake Chalco. Meanwhile, three massive stone-and-timber causeways incorporated removable wooden bridges that regulated canoe traffic and served as defensive flood barriers. Managing this fragile ecosystem required deep synthesis of daily calendar calculations and strict regional tribute quotas delivered by subjugated provinces.

- **Hydraulic Zoning:** Dikes separated the eastern hypersaline waters from western agricultural freshwater chinampa beds.
- **Transport Arteries:** Broad causeways contained sluice cutouts with removable wooden decks to drain flash runoff during the rainy season.
- **Economic Lifeline:** Tribute sheets recorded in codices tracked thousands of woven cotton mantles, cacao loads, and grain bins arriving each harvest cycle.

Curricular Historical Rigor

This puzzle mirrors authentic primary codex conventions from the Codex Mendoza and Matricula de Tributos, focusing on vigesimal (base-20) calculation systems and standard glyphic counting conventions.



Chinampas and Lake Texcoco

Student Challenge: Sluice Gates & Calendar Wheel

Name: _____ Class: _____ Date: _____

Module 1: The Causeway Sluice Gate Pressure Grid

Heavy storms across the Sierra Nevada have raised the northern lake basin by three cubits. If the southern causeway sluice gates remain closed, high-salinity water will breach the chinampas surrounding Coyoacan, poisoning the maize crops. If opened too wide, sudden drainage will groued incoming freight canoes on muddy banks. Examine the four weir sluices below (Iztapalapa Gate, Tepepan Gate, Xochimilco Gate, and Mexicaltzingo Gate). Each gate is held by timber pegs set into notched gauge stones numbered 1 through 20. Solve the pressure equations using the lake depth markings to identify the exact peg position for each weir. The four peg settings form the First Passcode.

- **Rule 1:** Sluice A (Iztapalapa) must equal Lake Depth (18 units) minus Brackish Runoff Index (7 units).
- **Rule 2:** Sluice B (Tepepan) must equal half the sum of Sluice A plus Spring Water Inflow (9 units).
- **Rule 3:** Sluice C (Xochimilco) must balance Sluice B plus Chinampa Absorption Factor (4 units).
- **Rule 4:** Sluice D (Mexicaltzingo) must be set exactly to the difference between Sluice C and Sluice A, then doubled.



Notched Gauge Stone
with Timber Peg



Tonalpohualli Calendar Wheel
(13 Numbers • 20 Day Signs)

1 Calculate Sluice A	2 Calculate Sluice B	3 Calculate Sluice C	4 Calculate Sluice D & Record Combination
Take the baseline flood water gauge marker of 18 and subtract the 7 units of brackish runoff indicated on the stone glyph.	Add Sluice A's value to the 9 units of freshwater inflow from Lake Chalco, then divide the total by 2.	Add the chinampa soil drainage constant of 4 units to Sluice B's calculated notch position.	Subtract Sluice A from Sluice C, double that difference, and assemble the 4-digit code [A-B-C-D].

Sluice A (Iztapalapa) Calculated Notch Setting:	**Sluice B (Tepepan)** Calculated Notch Setting:	**Sluice C (Xochimilco)** Calculated Notch Setting:	**Sluice D (Mexicaltzingo)** Calculated Notch Setting:	Module 1 Four-Digit Causeway Gate Passcode:
_____	_____	_____	_____	_____

Module 2: Tonalpohualli Calendar Wheel Alignment

To align the gate release mechanism with the sacred calendar cycle, the temple priests require an astrological validation sequence. The Aztec ritual calendar, the Tonalpohualli, pairs 13 day numbers with 20 day signs (such as Cipactli/Crocodile, Ehecatl/Wind, Calli/House, Cuetzpalin/Lizard, and Coatl/Serpent). A secret dispatch from the calmecac (priestly academy) specifies that the causeway release must take place exactly 37 days after the inaugural flood festival day sign: 4-Calli (4-House). By tracing the mathematical rotation of the 13 numbers and 20 day signs across the wheel, identify the final ritual day number, its matching animal glyph sign, and its directional quadrant (North, South, East, or West).

Wheel Calculation Strategy
Do not simply guess: count step-by-step or use arithmetic remainder math. Day number advances by (37 mod 13); day sign advances by (37 mod 20).

- **Starting Coordinate:** Day Number = 4 | Day Sign = Calli (Sign #3 in standard cyclical sequence).
- **Number Sequence:** Rolls continuously 1 through 13. (e.g., 4 + 37 days modulo 13 calculation).
- **Sign Sequence:** Rolls continuously through 20 signs: 1-Cipactli, 2-Ehecatl, 3-Calli, 4-Cuetzpalin, 5-Coatl, 6-Miquiztli, 7-Mazatl, 8-Tochtli, 9-Atl, 10-Itzcuintli, 11-Ozomatli, 12-Malinalli, 13-Acatl, 14-Ocelotl, 15-Cuauhtli, 16-Cozcacuauhtli, 17-Ollin, 18-Tecpatl, 19-Quiahuitl, 20-Xochitl.
- **Directional Assignment:** Signs 1, 5, 9, 13, 17 = East; Signs 2, 6, 10, 14, 18 = North; Signs 3, 7, 11, 15, 19 = West; Signs 4, 8, 12, 16, 20 = South.

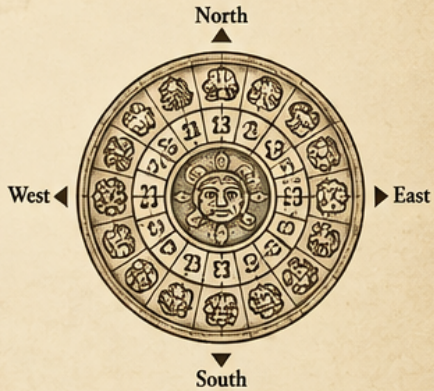

Day Number Calculation (Start 4, Advance +37):	Day Sign Index Calculation (Start Sign #3 Calli, Advance +37):	Resulting Sacred Day Sign Name:	Assigned Directional Quadrant (East / North / West / South):	Module 2 Key Code (Format: [Number]-[Sign Name]-[Direction]):
_____	_____	_____	_____	_____

Student Challenge: Codex Tribute Ledger & Master Verification

Name: _____ Class: _____ Date: _____

Module 3: Provincial Cotton Tribute Ledger Decoding

The southern causeway will not be opened without the imperial customs permit from the Calpixqui (tax collector). The tribute record from the southern provinces of Cuauhnahuac and Huaxtepec documents deliveries of decorated cotton mantles (*quachtli*), raw cotton bundles, and warrior costumes: Aztec numerical notation uses a vigesimal (base-20) system: a dot or line represents 1. a flag (pantli) represents 20, a feather or pine-tree bundle (tzontli) represents 400, and a purse or pouch (*xiquipilli*) represents 8,000.

Examine the damaged codex ledger extract below, calculate the total cotton tribute units registered, and determine how many cargo canoes are required if each standard boat holds exactly 80 cotton bundles.

- = 1 (dot)
- = 20 (flag / pantli)
- = 400 (feather / tzontli)
- = 8,000 (purse / xiquipilli)

- **Province A Entry:** 3 Feather glyphs (tzontli) + 8 Flag glyphs (pantli) + 12 Unit dots of plain wowen mantles.
- **Province B Entry:** 2 Feather glyphs (tzontli) + 14 Flag glyphs (pantli) + 5 Unit dots of polychrome bordered mantles.
- **Spoiled Cargo Deductions:** 1 Feather glyph (tzontli) and 2 Flag glyphs (pantli) damaged by damp lake spray during transit.
- **Transport Requirement:** Total Net Bundles divided by Canoe Capacity (80 bundles per canoe). Round up to the nearest whole canoe.

1 Sum Gross Tribute Values

Calculate Province A bundles: (3 * 400) + (8 * 20) + 12.

Calculate Province B bundles: (2 * 400) + (14 * 20) + 5.

2 Compute Damaged Goods

Multiply damaged goods glyphs: (1 * 400) + (2 * 20).

Subtract this damage total from the combined gross tribute.

3 Derive Fleet Canoe Count

Divide the Net Cotton Bundle count by 80. If there is any fractional remainder, add one additional canoe to ensure all goods reach the imperial granaries.

Province A Gross Bundle Total: _____

Province B Gross Bundle Total: _____

Total Damaged/Deducted Cargo: _____

Net Cotton Tribute Bundles Accepted: _____

Required Cargo Canoe Fleet Size (Module 3 Passcode): _____

MASTER VERIFICATION LEDGER

PROVINCE A (Cuauhnahuac)	PROVINCE B (Huaxhepec)
	



CONFIDENTIAL SOLUTION KEY & HISTORICAL ANALYSIS



Aztec Chinampa Plots



Canoed Causeway Canals

Teacher Solution Key & Debrief Guide

Comprehensive Teacher Answer Key & Solution Explanations

This reference sheet provides the step-by-step mathematical solutions and historical rationales for all three game modules. Keep this page strictly confidential until all student groups have completed or concluded the challenge.

1 Module 1 Sluice Calculations

- Sluice A = 18 - 7 = 11.
- Sluice B = (11 + 9) / 2 = 10.
- Sluice C = 10 + 4 = 14.
- Sluice D = (14 - 11) * 2 = 3 * 2 = 6.
- Gate Code: **11-10-14-06.**
  (Sum of Sluice values = 41).

2 Module 2 Calendar Math

- Number advances by 37 days.
- 4 + 37 = 41.
- 41 modulo 13 = 2 (since 13 * 3 = 39, remainder 2).
- The Day Number is **2.**
- Sign starts at #3 (Calli).
- 3 + 37 = 40.
- 40 modulo 20 = 0, which corresponds to the 20th glyph in the cycle: **Xochitl** (Flower).
- Directional Quadrant: Sign 20 belongs to the South quadrant.
- Master Code: **2-Xochitl-South.**

3 Module 3 Tribute Calculations

- Province A = (3 * 400) + (8 * 20) + 12 = 1200 + 160 + 12 = 1372 bundles.
- Province B = (2 * 400) + (14 * 20) + 5 = 800 + 280 + 5 = 1085 bundles.
- Gross Total = 1372 + 1085 = 2457 bundles.
- Damaged Cargo = (1 * 400) + (2 * 20) = 440 bundles.
- Net Accepted Cargo = 2457 - 440 = 2017 bundles.
- Canoe Fleet = 2017 / 80 = 25.2125 canoes.
  Because all cargo must be transported, round up to **26** canoes.



4 Master Final Sequence

- Sum of Sluice values (11 + 10 + 14 + 6 = 41) combined with Fleet Size (26) yields Final Master Code: **41-26.**

Post-Game Discussion Prompt

Ask students: How does the base-20 mathematics of the Aztecs reflect their daily economic necessities compared to our modern base-10 metric systems? Discuss the vulnerability of island cities during seasonal floods.

THE SPANISH ARMADA PLOT: TUDOR ESPIONAGE

Name: _____ Class: _____ Date: _____

Facilitator Setup and Intelligence Dossier

Facilitator Master Guide: Tudor Espionage Escape Room

This historical classroom escape unit casts students as junior secretaries in Sir Francis Walsingham's intelligence service during the summer of 1588. Student teams must decode intercepted Spanish correspondence, analyze naval windward charts of the English Channel, and reconstruct compromised cipher keys to uncover the rendezvous location of the Duke of Medina Sidonia and the Duke of Parma before the fleet launches.

- **Target Level:** Upper primary to secondary history students (Ages 11-16).
- **Setup Time:** 10 minutes to print station dossiers and distribute cipher keys.
- **Team Structure:** Recommended 3 to 5 students per intelligence cell.
- **Core Mechanics:** Frequency analysis, monoalphabetic substitution, compass bearing tracking, and chronological deduction.



Classroom Timing Recommendation

Allocate 45 minutes total: 5 minutes for the briefing narrative, 30 minutes for the three-part investigation stations, and 10 minutes for collective debrief and answer verification.

Setup and Facilitation Steps

1 Station Deployment



Print Clue Sheet 1, Clue Sheet 2, and the Cipher Desk. Place them in three distinct folders or tabletop stations labeled 'Cabinet of Whitehall', 'Channel Navigation Desk', and 'Decryption Chamber'.

2 Dispatch Distribution



Provide each team with a single Walsingham Master Cipher Wheel and one Student Evidence Log. Do not reveal the solutions on the Facilitator Key prior to completion.

3 Facilitator Hint Protocol



If a team stalls on Puzzle 1, advise them that the Greek cross symbol represents the vowel 'E'. For Puzzle 2, verify their initial anchorage coordinates before they calculate windward drift.

4 Debrief and Verification



Conclude the session by reading the historical resolution of the Battle of Gravelines, linking the cryptographic puzzle to real Tudor intelligence strategies.

Hint Protocol Decision Guide

How should teacher hints be handled during timed cell play?

A Team requests first clue on substitution

→ Hand over Hint Card A revealing the frequency mapping for the letter 'T' and 'H'.



B Team misidentifies Channel drift bearings

→ Direct students to inspect the compass rose legend on Chart 02 regarding prevailing southwesterly winds.



Prevailing winds: Southwesterly

Station I & II: Field Investigation & Channel Navigation

Name: _____ Class: _____ Date: _____





Station I: Intercepted Lisbon Courier (The Casket Letter)

A sealed packet recovered from a captured merchant brig off Portsmouth contains encrypted correspondence addressed to Don Bernardino de Mendoza. Sir Francis Walsingham's clerks have isolated the substitution cipher used by King Philip II's court. Use the partial substitution table to decipher the hidden orders.

Symbol Key:

‡ = A	§ = D	Δ = E	¥ = G
◊ = H	¶ = I	Ω = L	Σ = M
© = N	† = O	® = R	♠ = S
♣ = T	• = U		

Encrypted Fragment:

♣◊Δ ♠Ω††¶ ♠♣¶Δ®♣ ¥† ©†®♣◊

Cryptographic Advisory

Double-check letter frequencies: vowels appear under triangular and cruciform sigils. Beware of null characters intentionally inserted by Spanish scribes.

Deciphered Phrase (Transcribe intercepted text here):

_____

_____

Identify the primary rendezvous port indicated by the courier:

_____



Station II: Channel Navigation and Windward Drift Chart



Examine the Channel defense map recorded by royal hydrographers in July 1588. The Spanish crescent formation anchored off Calais must link with Parma's landing barges from Dunkirk. Calculate the windward advantage using the mariner's compass points to deduce where the fireships will scatter the fleet.

- **Starting Position:** Crescent anchored at Calais Roads (Grid Reference 50°57'N, 1°51'E).
- **Wind Condition:** Strong gale blowing from West-Southwest toward East-Northeast.
- **Obstacle:** Shoals and sandbanks along the Flemish coast (the Banks of Zeeland).
- **Objective:** Calculate the single open drift corridor that prevents grounding.

Hydrographic Hazard

Deep-draught Spanish galleons cannot cross water under five fathoms at low tide. Avoid the sandbars off Gravelines.

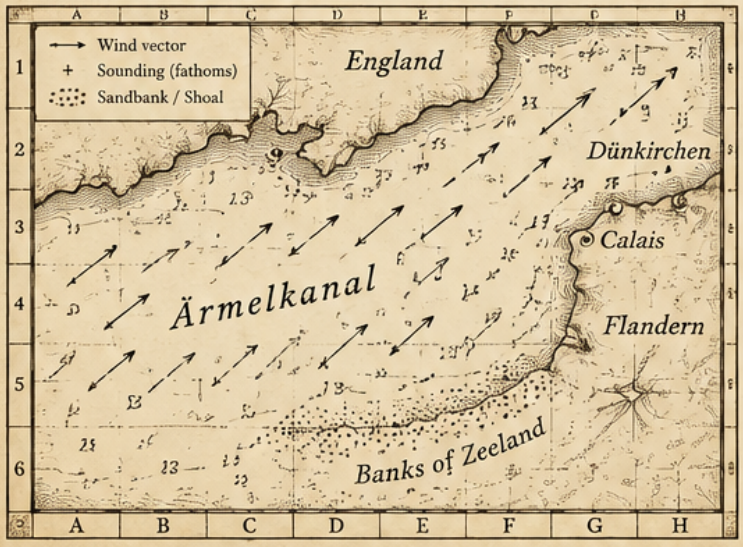

1. **Plot Anchorage Point**
   Mark Calais anchorage on the chart grid using the crosshairs provided at Sector C-4.
2. **Apply Wind Vector**
   Draw a bearing vector 065 degrees representing the gale pushing the fleet toward the North Sea.
3. **Identify Interception Zone**
   Determine the sector where English fireships, launched from windward, will break the crescent line.

Calculated Escape Sector for Spanish Flagship *San Martin*:

_____

Naval Tactical Conclusion (Why Parma's army cannot embark):

_____

_____

_____

Station III:
Privy Council Cipher Desk & Final Lock

Name: _____ Class: _____, Date: _____

Station III: The Privy Council Decryption Desk & Final Lock

Combine your findings from Station I and Station II to configure the master Tudor cipher lock. The lock requires a four-element validation code consisting of the cipher keyword, the rendezvous date, the wind bearing, and the tactical countermeasure name.

- **Code Element 1:** Decoded keyword from the Lisbon courier cipher.
- **Code Element 2:** Numerical date in August 1588 of the midnight fireship attack.
- **Code Element 3:** Compass quadrant of the prevailing Channel storm winds.
- **Code Element 4:** Name of the English flagship commanded by Lord Howard of Effingham.



Mission Finality

Once all four fields are entered, compare the final hash against Walsingham's cipher ledger to seal the borders of England.

1. Code Element 1 (Courier Keyword):

_____

_____

2. Code Element 2 (Midnight Attack Date):

_____

_____

3. Code Element 3 (Prevailing Storm Quadrant):

_____

_____

4. Code Element 4 (Lord High Admiral's Flagship):

_____

_____

5. Final Master Escape Phrase (Combining Elements 1-4):

_____

_____

Facilitator Master Answer Key & Historical Debrief

Name: _____ Class: _____ Date: _____

Facilitator Master Answer Key & Historical Briefing

Confidential reference for teachers. Do not distribute to students. Contains complete puzzle solutions, mathematical checks, and primary historical context linking the escape room to authentic Tudor espionage documents.

- **Station I Deciphered Text:** 'THE SHIPS STEER GO NORTH' (Port indicated: Dunkirk / Gravelines).
- **Station II Solution:** Vector 065° leads directly into North Sea; shoal barrier prevents Parma's barges from clearing port without Spanish galleon escort.
- **Station III Four-Element Lock:** 1: GRAVELINES | 2: 08 (August 8, 1588) | 3: WSW (West-Southwest) | 4: ARK ROYAL.
- **Master Escape Code:** GRAVELINES-08-WSW-ARKROYAL.

Historical Curricular Note

Sir Francis Walsingham operated England's first centralized state intelligence bureau. His use of Thomas Phelippes to forge and decode ciphers was central to Elizabeth I's foreign policy.

1 Debrief Question 1

How did weather and coastal hydrography affect mitlitary outcomes in early modern naval warfare as much as raw cannon fire?

1 Station I – Deciphered Text

THE SHIPS STEER GO NORTH



Port indicated: Dunkirk / Gravelines.

2 Station II – Vector Solution

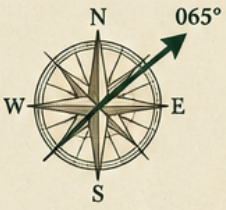

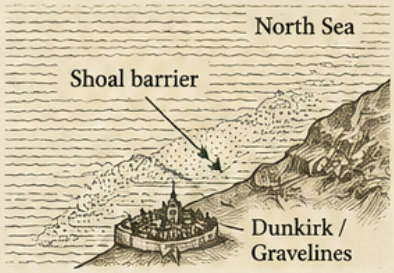

Vector 065° leads directly into North Sea; shoal barrier prevents Parma's barges from clearing port without Spanish galleon escort.

3 Station III – Four-Element Lock

1	2	3	4
GRAVELINES	08 (August 8, 1588)	WSW (West-Southwest)	ARK ROYAL

Master Escape Code:
GRAVELINES-08-WSW-ARKROYAL.

2 Debrief Question 2

Why was intercepting letters more valuable to Elizabeth's council than simply sinking incoming scout vessels on sight?

ESCAPE ROOM UNIT 15:

GALILEO OBSERVATORY TRIAL DOSSIER

Galileo's Observatory: Teacher Briefing & Setup Guide

Facilitator Guide: Historical Context & Mission Briefing

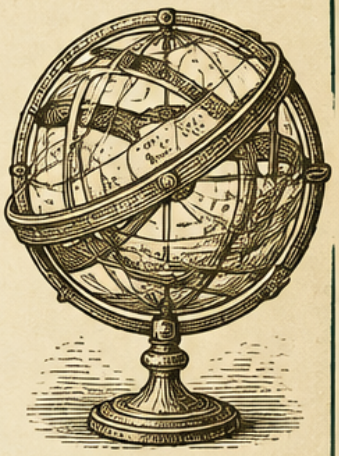

In the spring of 1633, Galileo Galilei stands accused before the Roman Inquisition for defending Copernican heliocentrism following the publication of his *Dialogue Concerning the Two Chief World Systems*. Student investigative teams assume the role of archival clerks at the Holy Office secretly sympathetiz to empirical science. Their objective is to cross-examine three primary forensic exhibits—telescopic lunar and jovian observations, pendulum isochronism timing logs, and tribunal testimony transcripts—to reconstruct Galileo's empirical defense dossier before the formal judgment concludes.

- **Recommended team structure:** 3 to 4 investigators per workstation.
- Total classroom operating window: 45 to 60 minutes across three stations.
- **Facilitator role:** Manage station progression, provide structured hints, and verify final dossier lock codes.
- **Pedagogical focus:** Primary-source analysis, empirical observation vs. scholastic dogma, and scientific methodology.

Facilitator Setup Instruction

Print **Station Cards 01 to 03** for student team tables. Station 01 requires a standard compass or straightedge; Station 02 requires a stopwatch or pendulum string demonstration; Station 03 requires highlighters for cross-examining canonical depositions.



1 Phase 1: Team Formation & Archival Packet Distribution

Distribute Station Cards 01 through 03 and one blank Trial Dossier Worksheet to each student squad. Introduce the historical stakes in Rome, 1633.

2 Phase 2: Three Station Investigations

Teams rotate through or simultaneously divide three inquiry stations: The Starry Messenger (astronomy), The Isochronous Pendulum (physics), and The Holy Office Interrogations (historical testimony).

3 Phase 3: Final Decryption & Dossier Synthesis

Students synthesize their derived station digits to generate the final 3-digit cipher code that unseals Galileo's secret observational notebook.

Name: _____ Class: _____ Date: _____

Station 01: Starry Messenger Celestial Observations

Station 01

Station 01: The Starry Messenger *(Sidereus Nuncius)*

Galileo's 1610 telescopic observations challenged Aristotelian cosmology, which held that all heavenly spheres are perfectly unblemished and rotate exclusively around the stationary Earth. Examine Galileo's original field log recording the positions of the Medicean Stars (Jupiter's four largest moons: Io, Europa, Ganymede, and Callisto) over consecutive nights in January 1610.

- **Observation Night 1 (Jan 7):** Three small stars visible near Jupiter: two east, one west.
- **Observation Night 2 (Jan 8):** All three visible stars appear west of Jupiter, contradicting expected planetary retrograde drift.
- **Observation Night 3 (Jan 10):** Only two stars visible, both to the east; one moon eclipsed behind Jupiter.
- **Observation Night 4 (Jan 13):** Four distinct bodies recorded simultaneously orbiting Jupiter.



Jupiter and the Medicean Stars



Forensic Deduction: Code Cypher Digit 1

Count the total number of distinct secondary celestial bodies proving an orbit that does NOT center upon Earth. Enter this integer into Code Box Alpha.

1. Recorded count of Jovian moons observed orbiting Jupiter (Digit Alpha): _____

2. Why does a body orbiting Jupiter directly refute strict Geocentrism?

_____

_____

_____

_____

Name: _____ Class: _____ Date: _____

Station 02:
Isochronous Pendulum Physics Lab

Station 02

Isochronism & The Pulsilogium

According to legend, Galileo observed a swinging bronze lamp in Pisa Cathedral in 1582, timing its oscillations using his pulse. He discovered that the period of a pendulum depends solely on its length, regardless of the swing's amplitude or the bob's weight. Inquisitors claimed heavy weights must fall or swing proportionally faster, following Aristotle's Physics.

- **Trial Measurement A:** 100 cm cord, 50 g bronze bob — Time for 10 oscillations = 20.0 seconds (Period = 2.0 s).
- **Trial Measurement B:** 100 cm cord, 250 g iron bob — Time for 10 oscillations = 20.0 seconds (Period = 2.0 s).
- **Trial Measurement C:** 25 cm cord, 50 g bronze bob — Time for 10 oscillations = 10.0 seconds (Period = 1.0 s).
- **Key Law:** Period T is proportional to the square root of pendulum length L; bob mass exerts zero effect on cycle frequency.

Forensic Deduction: Code Cypher Digit 2

Determine the time period in seconds required for one complete swing (back and forth) of the 25 cm pendulum in Trial C. Enter this integer into Code Box Beta.

Galileo's Pulsilogium



Cathedral Pendulum



Cord Length vs. Period Time

Cord Length (cm)	Bob Mass (g)	Time for 10 Oscillations (s)	Period (s)
100	50	20.0	2.0
100	250	20.0	2.0
25	50	10.0	1.0

1. Single oscillation period of the 25 cm pendulum (Digit Beta):

_____

2. Explain how this empirical measurement disproves Aristotle's theory of mass and motion:

_____

_____

_____

_____

Name: _____ Class: _____

Date: _____

Station 03:
The Holy Office Tribunal Injunction

Station 03: The Holy Office Interrogations & The 1616 Injunction



The Inquisition's chief legal argument hinges upon an unnotarized memermadum dated March 3, 1616, allegedly ordering Galileo not to 'hold, teach, or defend' Copernicanism in any way whatsoever. Galileo presents an authentic, signed certificate from Cardinal Robert Bellarmine dated May 26, 1616, stating only that Galileo was notified that Copernican theory cannot be defended as literal physical truth, but may still be treated as an astronomical mathematical model.

- **Exhibit 1:** The Commissary General's Unsigned Minute (1616) — Contains strict phrasing 'quovis modo' (in any way whatsoever).
- **Exhibit 2:** Cardinal Bellarmine's Signed Attestation (1616) — Guarantees Galileo faced no penance and was merely warned that heliocentrism cannot be held as dogma.
- **Exhibit 3:** Papal Imprimatur for 'Dialogue' (1632) — Florence and Rome inquisitors officially licensed the publication prior to release.
- **Disputed Article:** The Inquisition prosecutes Galileo under Article 7 of the index proceedings.



Cardinal Bellarmine's Signed Attestation (1616)

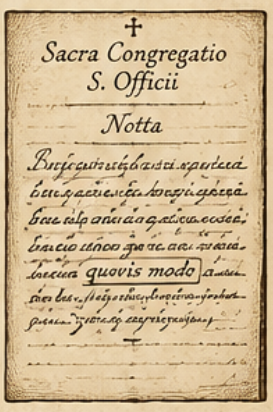

Commissary General's Unsigned Minute (1616)

Forensic Deduction: Code Cypher Digit 3

Identify the number of official Church licensers (imprimaturs) Galileo secured across Florence and Rome before publishing his 1632 Dialogue (Pope Urban VIII's master of sacred palace, inquisitor of Florence, vicar of Florence). Enter this integer (3) into Code Box Gamma.

1. Total verified ecclesiastical imprimatur approvals secured (Digit Gamma):

_____

2. Contrast Bellarmine's signed certificate with the tribunal's unsigned minute:

_____

_____

_____

Master Trial Dossier:
Vault Unlock & Facilitator Solutions

Name: _____ Class: _____ Date: _____

Final Trial Dossier: Synthesis, Verdict & Answer Key

Combine the three cipher digits obtained from Stations 01, 02, and 03 to unlock the vault seal. Analyze the historical judgment of June 22, 1633, where Galileo was convicted of 'vehement suspicion of heresy,' forced to recant, and sentenced to life house arrest at his villa in Arcetri near Florence.

- **Cipher Lock Sequence:** Digit Alpha (4) + Digit Beta (1) + Digit Gamma (3) = 4 - 1 - 3.
- **Station 01 Answer:** 4 Jovian Moons (Io, Europa, Ganymede, Callisto). Proves not all heavenly bodies revolve around the Earth.
- **Station 02 Answer:** 1 second per swing. Proves period depends on length, not mass.
- **Station 03 Answer:** 3 ecclesiastic approvals/imprimaturs. Shows Galileo complied with existing publication censorship procedures.
- **Historical Legacy:** In 1992, the Roman Catholic Church formally acknowledged errors in the condemnation of Galileo Galilei.



Master Code Lock Verification

Correct Team Code: [4 - 1 - 3].

Once teams present this combination, award the Galileo Trial Dossier Cleared Archive Stamp.

Master Decryption Code [Box Alpha - Box Beta - Box Gamma]:

_____

Historical Debrief: Why did empirical evidence fail to persuade the 1633 Tribunal?

_____

_____

_____

_____



Decision

Did the investigative squad successfully reconstruct Galileo's empirical defense within the allotted timeframe?

- Master Code 4-1-3 entered correctly with historical analysis completed → Award 'Grand Ducal Mathematician & Archival Scholar' distinction; squad proceeds to historical debrief discussion.
- Discrepancy in station calculations or missing source comparison → Direct squad to re-read Cardinal Bellarmine's 1616 signed deposition and verify Trial C pendulum swing arithmetic.



THE BOSTON HARBOR MIDNIGHT RUN

Mission Briefing & Historical Context

December 1773, Boston Harbor. Following months of escalating tensions over Crown taxation policies and the arrival of the East India Company tea ships, the Sons of Liberty prepare an urgent covert operation. As an underground cell operating out of Griffin's Wharf, your group must decipher colonial ledger records, decode customs manifest alterations, and read coastal lantern signals to transmit the rendezvous directive before the night watch sounds midnight.

- **Historical Setting:** Boston Waterfront, Province of Massachestets Bay, December 1773.
- **Primary Objective:** Solve three investigative puzzle locks to derive the final signal coordinate.
- **Operational Constraints:** Complete the briefing, analysis, and verification within 45 minutes.
- **Underground Roles:** Ledger Analyst, Manifest Inspector, Signal Decryptor, and Field Scribe.



Historical Integrity Note

All ledger entries, ship names (Dartmouth, Eleanor, Beaver), and port customs codes are grounded in authentic 1773 Boston shipping records and historical colonial tax dispute practices.

Facilitator Preparation & Setup Protocol

This guide provides educators with step-by-step instructions for structuring the collaborative classroom simulation. The room is divided into three consecutive investigation stations or distributed as four-student table packets.

Pacing & Station Guidance

Provide students with blank scrap parchment and a standard ruler. The cipher wheels and clue charts should be printed single-sided for hands-on manipulation.

1 **Step 1: Assembly and Packet Distribution**

Print one master evidence dossier per student cell (3-4 participants). Ensure each station contains Clue Sheet 01 (Green Dragon Tavern Ledger), Clue Sheet 02 (Customs Manifest Alteration), and Clue Sheet 03 (North Church Lantern Matrix).

2 **Step 2: Role Allocation and Timed Launch**

Assign cellular responsibilities: Ledger Analyst (cross-references signatures), Manifest Inspector (calculates duty discrepencies), Signal Decryptor (maps lantern flashes), and Field Scribe (records verified keys). Set the timer for 45 minutes.

3 **Step 3: Staged Verification Checkpoints**

Validate student lock keys sequentially. If a group submits an erroneous cipher, require them to re-audit their primary source data before granting access to the subsequent station clue.

What is the cell's status at the 25-minute mark?

1 **Stuck on Station 2 Duty Calculation**

Prompt the team to audit the gross tare weight against the Dutch smuggler exemption listed on the margin of Manifest B.

2 **Stuck on Station 3 Matrix Decryption**

Remind the team that North Church lanterns use dual belfry coordinates: odd pulses denote cardinal headings; even pulses denote wharf slip numbers.

Operational Evidence: Tavern Ledgers & Customs Manifests

Name: _____ Class: _____ Date: _____

Station 1 Clue Sheet: Green Dragon Tavern Ledger

The patrons of the Green Dragon Tavern recorded their arrivals using discreet tradesman aliases and coded tab entries. Cross-examine the tavern log with the patriot roster to identify the operative who coordinated the midnight lighter boats.



- **Entry Alpha:** 'A cooper from the North End paid 4 pence for cider; marked with anchor insignia.'
- **Entry Beta:** 'Silversmith entered at the eighth bell; paid with stamped Spanish real; noted meeting at South Meeting House.'
- **Entry Gamma:** 'Ropemaker from Fort Hill; settled tavern tab with six clipped half-pennies; requested lantern oil.'
- **Entry Delta:** 'Customs tide-waiter recorded zero ale, observed carrying official crown seals toward Griffin's Wharf.'

Green Dragon Tavern

Date	Name / Alias	Trade	Tab	Notes
Apr 12	Cooper (N. End)	Cider	4d	anchor insignia ⚓
Apr 14	Silversmith	Ale	8th bell	spanish real — S. Meeting House
Apr 17	Ropemaker	Cider	6 half-pennies	lantern oil
Apr 19	Tide-waiter	Zero	—	crown seals → Griffin's Wharf



1 Operative Codename Identified

_____

2 Supporting Ledger Evidence (Alias & Coin Mark)

_____

_____

3 Decoded Lock 1 Numerical Sequence

_____

Station 2 Clue Sheet: Customs Manifest Alterations

Inspect the inbound cargo records for the merchant vessel *Dartmouth*. Crown inspectors recorded the standard cargo, but underneath the ink wash, patriot dockworkers wrote the clandestine crate locations containing disguised gear.


ROYAL CUSTOMS



- **Manifest Line 14:** Declared as 12 chests Bohea Tea (Gross Tare: 360 lbs per chest); actual weight registered as 410 lbs.
- **Manifest Line 19:** Declared as 8 chests Congou Tea; customs duty unpaid; margin note reads: *'Shift to Long Wharf slip three upon dusk.'*
- **Manifest Line 27:** Declared as 15 pipes of Canary Wine; chalked signature shows cross-hatch emblem of the Boston Committee of Correspondence.
- **Discrepancy Formula:** Subtract declared weight from registered weight on Line 14, multiply by unpaid duty shillings from Line 19.

! Inspection Rule

Double-check the tare weight arithmetic carefully; an error in the shilling multiplier invalidates the mechanical padlock combination for Lock 2.



Dartmouth — Inbound Cargo Manifest

Line	Description	Declared	Registered	Duty	Notes
14	Bohea Tea	12 chests	410 lbs	—	(weight discrepancy)
19	Congou Tea	8 chests	—	unpaid	Shift to Long Wharf slip three upon dusk.
27	Canary Wine	15 pipes	—	—	⚔



1 Gross Weight Discrepancy (Lbs)

_____

2 Calculated Customs Duty Differential (Shillings)

_____

3 Decoded Lock 2 Numerical Sequence

_____

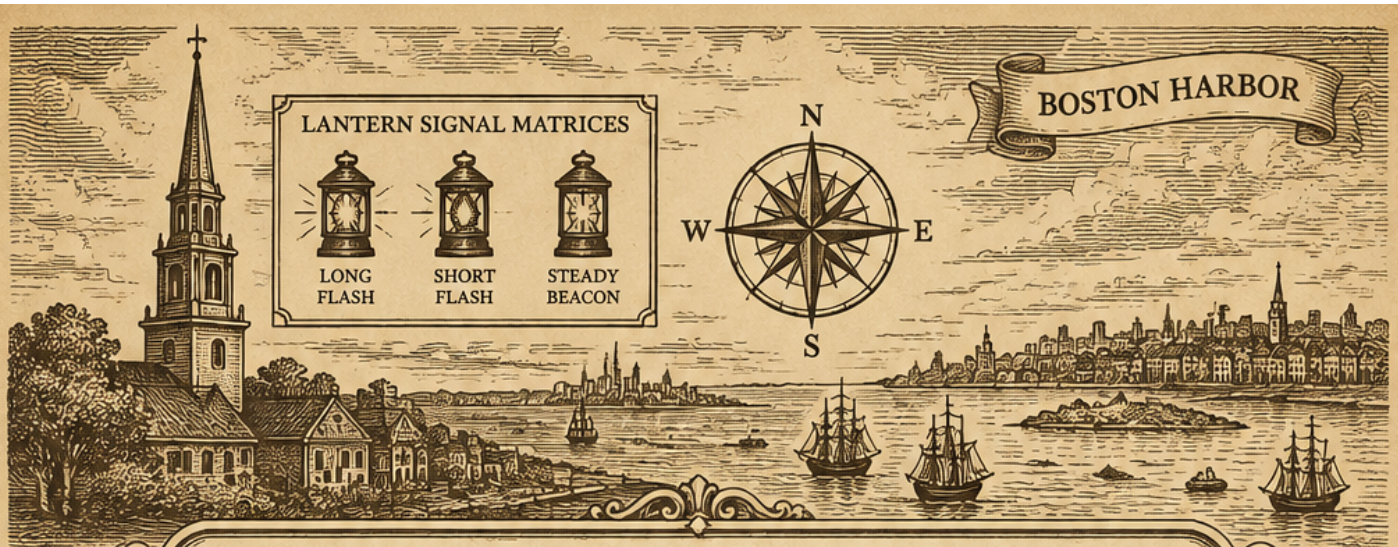

Coastal Signals & Master Facilitator Key

Name: _____ Class: _____ Date: _____

Station 3 Clue Sheet: Coastal Lantern Signals

From the belfry of the Old North Church across the dark waters of the Charles River, lookouts communicated via pulsed shutter lanterns. Convert the recorded pulse bursts into harbor navigational coordinates using the Sons of Liberty maritime grid.

- **Signal Burst 1:** Three long flashes, two rapid occultations -> Latitude sector 42° 21' N.
- **Signal Burst 2:** Four short flashes, one steady beacon -> Longitude marker 71° 03' W.
- **Signal Burst 3:** Alternating red-tinted lens sweep -> Slip indicator: Griffin's Wharf, berth number four.
- **Final Vector Instruction:** Combine sector integer, marker integer, and berth indicator to yield the three-digit extraction cipher.

Decoded Navigational Sector	Berth and Slip Coordinate	Decoded Lock 3 Master Extraction Cipher

Master Verification & Teacher Answer Key

This section is strictly for the educator and game facilitater to confirm lock sequences, verify student working formulas, and guide classroom debriefing.

- **Lock 1 Solution:** Code 1773-SILVER. The operative is the Silversmith (Paul Revere alias) at the eighth bell, paying with the Spanish real.
- **Lock 2 Solution:** Code 400. Weight discrepancy is 50 lbs (410 minus 360) multiplied by the 8 unpaid duty shillings recorded on Line 19.
- **Lock 3 Solution:** Code 421-4. Formed by sector 42, marker 1, and berth number 4.
- **Final Escape Verification:** Operative SILVER at Berth 4 with cipher vector 421-4-400 initiates the midnight action.



Debrief Discussion Questions

1. Why did the Sons of Liberty rely on merchant and trade networks rather than military communications?
2. How did British customs enforcement directly impact local colonial commerce in 1773?

STORMING THE BASTILLE ESCAPE ROOM - TEACHER DOSSIER

Name: _____ Class: _____ Date: _____

Storming the Bastille Escape Game: Facilitator Briefing

Facilitator Master Guide & Historical Briefing

Set in Paris during July 1789, this immersive classroom escape challenge places student teams in the roles of citizen dispatchers navigating the civic crisis surrounding the storming of the Bastille. Working in collaborative groups of three to five, students must solve three sequential modular puzzle challenges: deciphering fragmented royal and popular proclamations, navigating barricaded revolutionary cartography across the Faubourg Saint-Antoine, and accurately reconstructing foundational clauses of the Declaration of the Rights of Man and of the Citizen. Allow 45 to 55 minutes for standard classroom execution.

- **Optimal team configuration:** 3–5 students per group with assigned roles (Cartographer, Code Decipherer, Scribe, and Envoy).
- **Setup preparation:** Print Puzzle Stations 1, 2, and 3 along with the Master Student Dispatch Sheet.
- **Facilitator hints:** Provide Hint Cards only after teams have sustained productive struggle for a minimum of 7 minutes per module.



Hôtel de Ville of Paris, 1789

Classroom Context Rule

Every cipher key and barricade coordinate relies strictly on authentic July 1789 chronological events and verified Enlightenment civic concepts.

1 Step 1: Assembly & Briefing

Distribute Station 1 to teams and read the historical dispatch narrative. Start the 45-minute countdown clock.

2 Step 2: Modular Station Progression

Teams submit completed numerical or keyword verification codes to the facilitator to unlock subsequent puzzle envelopes.

3 Step 3: Debrief & Synthesis

Conclude with an educator-led alignment review connecting the solved Declaration clauses to the abolition of feudal privilege.

How will your team pace through the civic crisis modules?

Team decodes Station 1 in under 12 minutes

Proceed immediately to Station 2 Barricade Cartography without accessing facilitator hint chits.

Team remains stalled after 12 minutes on parchment scraps

Facilitator issues Citizen Hint Token A directing attention to the Roman numeral paragraph markers.

Name: _____ Class: _____ Date: _____

Station 1:
Torn Parchment Proclamations

Dispatch Station 1:
The Torn Parchment Proclamations

Rumours surge across the streets of Paris following the dismissal of Finance Minister Jacques Necker. A courier dropped a torn royal ordinance mixed with an underground pamphlet from the Palais-Royal. Piece together the four severed text fragments by matching torn border ciphers and identifying the suppressed revolutionary call to arms.

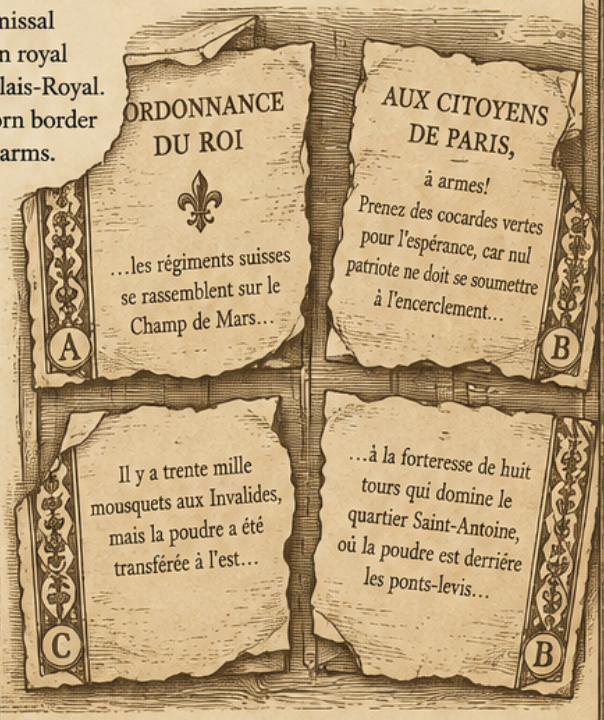

- **Fragment Alpha:** '…the Swiss regiments assemble on the Champ de Mars to suppress public assemblies by royal decree…'
- **Fragment Beta:** '…citizens of Paris, to arms! Take green cockades for hope, for no patriot shall submit to armed encirclement…'
- **Fragment Gamma:** '…thirty thousand muskets are stored at Les Invalides, yet the gunpowder has been transferred east…'
- **Fragment Delta:** '…to the fortress of eight towers that looms over the Saint-Antoine district, where ammunition lies behind drawbridges…'

Decryption Task

Reorder fragments Alpha, Beta, Gamma, and Delta into historical chronological order. Extract the initial letter of each key location to reveal the 4-letter station passcode.



1 Chronological Alignment

Determine the strategic sequence: Troop Concentration (Alpha) -> Street Mobilisation (Beta) -> Seizure of Muskets (Gamma) -> Bastille Gunpowder Target (Delta).

2 Extract Verification Code

Record the tactical objective location indicated in Fragment Delta and enter the target name on your dispatch log.

Fragment Chronological Sequence (4 Letters) _____

Suppressed Target Fortress Identified _____

Station 1 Unlock Code Submitted to Facilitator _____

Name: _____ Date: _____

Class: _____

Station 2: Barricade Cartography of the Faubourg

Dispatch Station 2: Barricade Cartography of the Faubourg

The electors of Paris have assembled at the Hôtel de Ville, but royal cavalry patrols block the main boulevards. Using the street grid map below, plot an unobstructed route from the Place de Grève to the Bastille courtyard while avoiding patrolled checkpoints.

- **Coordinate A1:** Hôtel de Ville (Start Point - Citizen Headquarters).
- **Coordinate B2:** Rue Saint-Antoine Patrol (Royal German Regiment cavalry blockade - impassable).
- **Coordinate C1:** Quays along the Seine River (Open transit route via timber barges).
- **Coordinate C3:** Arsenal wharves (Clear passage secured by the rebellious French Guards).
- **Coordinate D4:** Outer Courtyard of the Bastille (Final destination for artillery positioning).

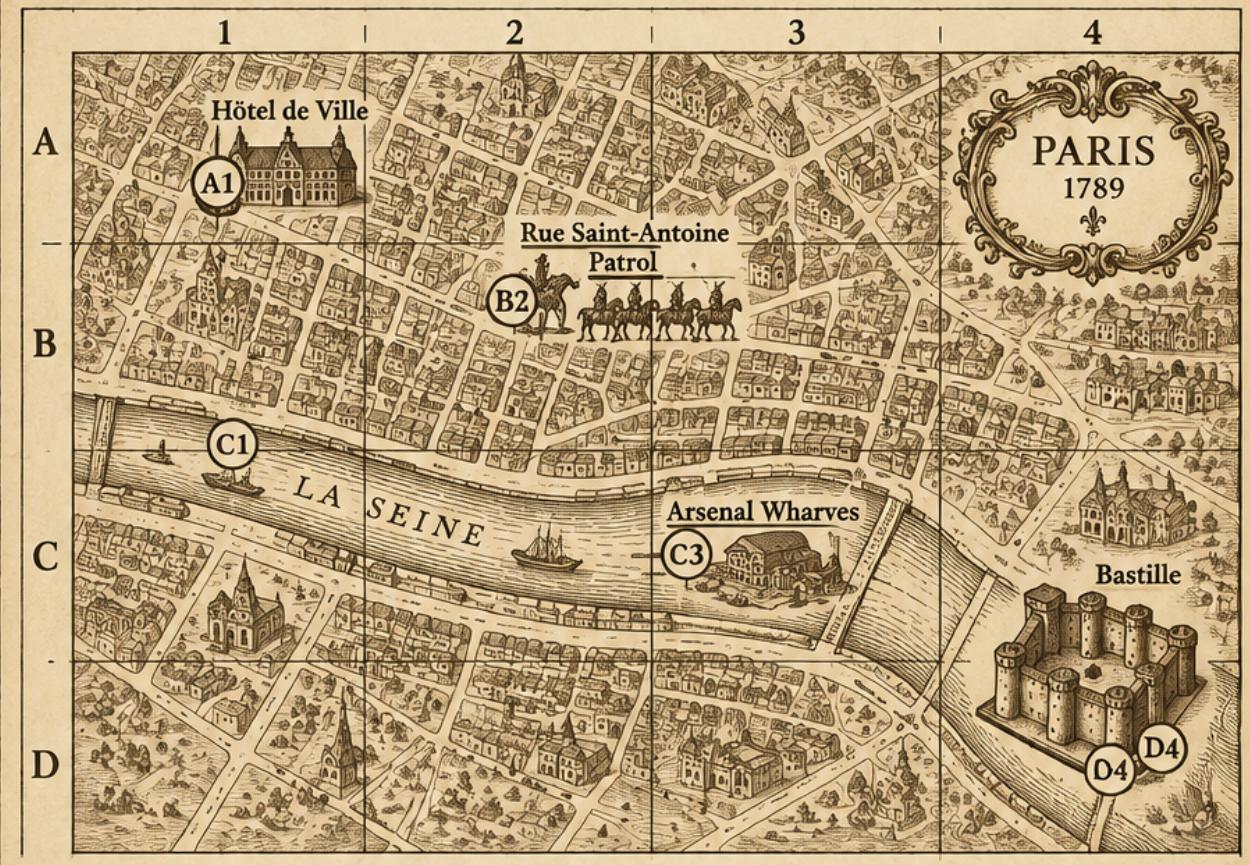

Cartographic Navigation Rule

Each valid grid step (North, South, East, West) accumulates a numerical toll value.
A detour through an occupied royal checkpoint adds a 5-minute penalty.

1 **Plot Safe Vector**

Trace the route through unoccupied grid sectors: A1 -> C1 -> C3 -> D4.

2 **Calculate Passage Value**

Sum the grid coordinate numbers of all intermediate waypoints to form the cartography clearance key.

Selected Waypoint Grid Sequence

_____

_____

Calculated Waypoint Value Sum

_____

Station 3: Alignment of Revolutionary Principles

Name: _____ Class: _____ Date: _____

Dispatch Station 3: Alignment of Revolutionary Principles

Following the fall of the fortress on 14 July 1789, the National Assembly drafted principles that dismantled the Old Regime. Match each draft preamble statement to its corresponding Enlightenment philosophy source to reconstruct the opening clauses of the Declaration of the Rights of Man and of the Citizen.

Draft Preamble Statements

1. Clause 1: "Men are born and remain free and equal in rights. Social distinctions may be founded only upon the general good.'
2. Clause 2: "The aim of all political association is the preservation of the natural and imprescriptible rights of man: liberty, property, security, and resistance to oppression.'
3. Clause 3: "The principle of all sovereignty resides essentially in the nation. No body nor individual may exercise any authority which does not proceed directly from the nation.'
4. Clause 4: "Law is the expression of the general will. Every citizen has a right to participate personally, or through his representative, in its foundation."

Enlightenment Philosophy Sources

- **A** — **Natural Law Equality**
  All humans possess equal natural rights by virtue of their humanity.
- **B** — **Locke's Inalienable Rights**
  Individuals have inherent rights to life, liberty and property that cannot be taken away.
- **C** — **Popular Sovereignty**
  Political authority belongs to the people, not to a monarch or elite.
- **D** — **Rousseau's General Will**
  Legitimate law reflects the common will of the people, not individual interests.

Philosophical Source Pairings

Match Clause 1 to Natural Law Equality, Clause 2 to Locke's Inalienable Rights, Clause 3 to Popular Sovereignty, and Clause 4 to Rousseau's General Will.

1. **Clause Synthesis**
   Confirm that all four clauses are correctly aligned with their philosophical roots to eliminate contradictory Old Regime tenets.
2. **Final Key Phrase Assembly**
   Extract the four cornerstone terms (Equality, Rights, Sovereignty, General Will) to complete the civic manifesto lock.

Philosophical Concordance Mapping (Clauses 1-4)

_____

_____

Final 4-Keyword Civic Seal

_____

FACILITATOR VERIFICATION DOSSIER

Comprehensive Teacher Answer Key & Verification Dossier

Educator Facilitator Key & Verification Dossier

This confidential facilitator key provides instant verification for student submissions across all three game stations, sample scoring rubrics, and curricular discussion prompts aligned with secondary history frameworks.

- **Station 1 Master Solution:** Sequence is Alpha -> Beta -> Gamma -> Delta (A-B-G-D). Target fortress: BASTILLE. Verification code: BAST-1789.
- **Station 2 Master Solution:** Optimal route: A1 (Hôtel de Ville) -> C1 (Quai de Grève) -> C3 (Arsenal wharves) -> D4 (Bastille Courtyard). Waypoint coordinate sum: 1 + 1 + 3 + 4 = 9 (Clearance Key: ROUTE-09).
- **Station 3 Master Solution:** Clause 1 = Equality; Clause 2 = Rights (Locke); Clause 3 = Sovereignty; Clause 4 = General Will (Rousseau). Master Civic Seal: LIBERTE-1789.



Storming of the Bastille, 14 July 1789

Facilitator Assessment Standard

Evaluate student outputs based on historical reasoning, collaborative debate evidence, and rigorous reading of primary text.

Next Steps for Facilitators

1 Awarding Escape Victory

Teams delivering all three verified keys within the 45-minute window receive the Citizen Elector Commendation.

2 Classroom Synthesis Discussion

Lead a five-minute whole-class reflection exploring why the Bastille served as the supreme physical symbol of Old Regime despotism.

Team Completion Time Log

1. _____

2. _____

Curricular Mastery Notes

1. _____

2. _____

TEACHER FACILITATOR MANUAL:
THE INDUSTRIAL FACTORY GATE 1812

Escape Room Facilitator Guide: The Industrial Factory Gate



Teacher Facilitator Guide & Mission Briefing

Welcome to 'The Industrial Factory Gate: Luddites and Steam Loom Blueprints.' This classroom escape challenge immerses students in northern England during the early 1811s. Working in investigative syndicates, students analyse primary source testimonies, factory payroll records, and early mechanised loom punch patterns to unlock the four iron padlocks sealing the textile mill gates.



Steam Boiler

- **Curriculum Focus:** Industrial Revolution, labour mechanisation, Luddite unrest, and parliamentary factory inquiries.
- **Target Audience:** Upper primary and secondary history students (Ages 11–16).
- **Recommended Format:** Teams of 3 to 5 students working with printed dossiers.
- **Expected Completion Time:** 45 to 60 minutes.



Facilitator Preparation

Print Clue Cards 1 through 3 and distribute one complete pack per syndicate. Provide each group with scratch paper and pencils. Ensure students record their interim deductions directly on the Field Evidence Dossier before submitting their final passcode sequence.

Steps

1. **Briefing Phase (5 Mins)**
   Read the historical narrative aloud. Explain that automated steam looms have displaced handloom weavers, sparking nocturnal raids by the self-proclaimed followers of General Ned Ludd.

2. **Investigation Phase (35 Mins)**
   Students examine Clue 1 (Jacquard punch cards), Clue 2 (Wage & fine ledger), and Clue 3 (Parliamentary witness deposition) to derive three distinct numeric codes.

3. **Master Code Formulation (10 Mins)**
   Teams combine all three code keys to construct the four-digit master lock sequence: [Key 1] + [Key 2] - [Key 3].



Mechanical Loom with Jacquard Punch Cards



How should teams be paced if they experience stalled progress?

Stuck on the punch card pattern (Clue 1)	→	Direct students to inspect row weights: column positions represent base-2 values (1, 2, 4, 8) matching punched holes.
Stuck on wage ledger net pay (Clue 2)	→	Remind students that fines for late arrival and candle-wax damage must be subtracted from gross piece-rate earnings.

WESTWOOD COTTON MILL: APPRENTICE DOSSIER 1812

Name: _____ Class: _____ Date: _____

Student Briefing: The Iron Gates of Westwood Mill (1812)



The year is 1812 in West Riding, Yorkshire. The newly installed Cartwright steam-powered looms run day and night, powered by coal and high-pressure steam. Outside the locked factory gates, displaced artisans have gathered under the banner of **Ned Ludd**, demanding fair wages and the preservation of skilled craft. You are an investigative apprentice trapped inside the master counting house. To unlock the emergency exit gate before the confrontation escalates, you must decrypt three secure master ledgers stored in the mill manager's chest.

- **Objective 1:** Decode the binary punch card used to control the mechanical warp lifter.
- **Objective 2:** Audit the weekly wage deductions and fines ledger for weaver Thomas Mercer.
- **Objective 3:** Identify the true informant among the sworn testimonies presented to the Parliamentary Select Committee.

Mission Rule | All calculations must be verified using contemporary shilling and pence conversions: 12 pence (d.) = 1 shilling (s.). Every deduction must be logged with source line numbers.

Syndicate / Team Name	Assigned Lead Investigator	Date of Operation
_____	_____	_____

Puzzle Dossier: Primary Evidence & Decryption Keys



Inspect the three official documents recovered from the overseer's mahogany desk. Solve each puzzle to determine the key number for each lock mechanism.

1 Clue 1 (Warp Punch Card):
A four-row mechanical punch pattern dictates the harness lift. Holes represent binary values [8, 4, 2, 1].

Row 1: [O, X, O, X] = 5
Row 2: [X, O, X, O] = 10
Row 3: [O, O, X, X] = 3
Row 4: [X, X, O, O] = 12

Sum of all four row values yields Key 1.



O = Loch
X = Kein Loch

2 Clue 2 (Wage Ledger Audit):
Thomas Mercer's gross wage was set at 28 shillings. His ledger notes three deductions: 4 shillings for uncleaned gear lint, 3 shillings for missing thread count, and 6 shillings impounded for the company coal levy. Compute Mercer's final take-home pay in shillings to establish Key 2.



3 Clue 3 (Select Committee Witness Log):
Three witnesses testified under oath: Witness A stated the mill gate closed at 6:00 AM; Witness B stated wages fell by 40% between 1806 and 1812; Witness C claimed steam power required no skilled maintenance. Parliamentary records confirm only the wage statistician (Witness B) gave accurate verified testimony. Take the percentage drop (40) and divide by the number of truthful witnesses (1) to produce Key 3.



Security Notice | Check all calculations twice. Any transposition error will trip the mechanical alarm rattle and lock the gates permanently!

1 Key 1 Solution (Punch Card Total)	2 Key 2 Solution (Net Wage in Shillings)	3 Key 3 Solution (Calculated Witness Value)
_____	_____	_____

4 Master Gate Code: (Key 1 + Key 2) * 10 - Key 3

_____

5 Historical Reflection: Explain why mechanisation created social unrest in 1812.

_____

_____

_____

_____

Master Solution Key & Curricular Assessment

Name: _____ Class: _____ Date: _____

Facilitator Solution Key & Historical Debrief

Review and assess student submissions using this verified solution key and curricular debriefing rubric.

- **Key 1 Verification:** Row 1 = 5, Row 2 = 10, Row 3 = 3, Row 4 = 12. Total: 5 + 10 + 3 + 12 = 30.
- **Key 2 Verification:** Gross wage 28s minus deductions (4s + 3s + 6s = 13s). Net wage: 28 - 13 = 15s.
- **Key 3 Verification:** True witness is Witness B (40% wage drop). Value: 40 / 1 = 40.
- **Master Gate Passcode:** (Key 1 [30] + Key 2 [15]) * 10 - Key 3 [40] = (45 * 10) - 40 = 450 - 40 = 410.



Cartwright Steam Loom

HOUSE OF COMMONS PARLIAMENT

Discussion Guide

Prompt students to evaluate whether Luddites were anti-technology or defending their craft, standard of living, and community autonomy against unregulated industrial factory exploitation.

NOTE

1 Step 1: Check Decoded Totals



Confirm student arithmetic on each clue ledger. Provide prompt cards if arithmetic errors prevent unblocking the final formula.

2 Step 2: Collect Reflection Responses



Assess students' understanding of the transition from cottage industry handlooms to coal-fired factory production and parliamentary child labour inquiries.

THE UNDERGROUND RAILROAD SAFEHOUSE: FACILITATOR GUIDE



Name: Class: Date:

Teacher Facilitator Guide & Mission Protocol



Facilitator Guide: Operational Briefing & Classroom Setup

This escape challenge engages upper primary and secondary students in historical network analysis, geographical navigation, and primary source decoding. Student investigation teams assume the historical role of vigilance committee dispatchers operating along the Ohio River corridor in 1856. Teams must examine three distinct historical puzzle dossiers to chart an escape pathway to Lake Erie and verify clearance past hostile patrols.

- Recommended group size: 3 to 5 students per investigative cell.
- Target runtime: 45 to 60 minutes for document analysis and route verification.
- Print Station Clues A, B, and C as separate station folders or as an integrated challenge packet.
- Equip each cell with scrap paper, straightedges, and the Route Log sheet.



Historical Context & Pedagogical Note

While 20th-century oral folklore popularized specific geometric quilt patterns as a systematic escape cipher, documented historical evidence confirms enslaved freedom seekers relied on celestial wayfinding, natural navigation markers, sympathetic abolitionist networks, and clandestine coded correspondence. This lesson encourages critical source analysis to distinguish verifiable historical mechanics from popular historical legends.

Mission Setup & Execution Steps

1 Station Setup



Establish three physical inspection tables or digital breakout folders labeled Station 1 (Visual Geometry & Folklore Cipher), Station 2 (River Crossing & Riverine Wayfinding), and Station 3 (Conductor Correspondence & Clandestine Dispatch).

2 Dispatch Distribution



Distribute the Route Log & Decoder Worksheet to each student group along with pencils and reference copies of the source dossiers.

3 Timed Investigation



Start the 45-minute countdown clock. Groups examine the artifacts sequentially or distribute individual clues among members before synthesizing their final safehouse waypoint.

4 Safehouse Route Verification



Inspect student submissions against the Conductor Master Key. Groups that correctly deduce the final waypoint (Oberlin Safehouse) unlock the mission debrief.

STATION DOSSIER: CIPHERS & WATERWAYS

Name: _____ Class: _____ Date: _____

Historical Evidence & Station Clue Packet

Examine the three historical artifacts below. Cross-reference navigational astronomy, clandestine cipher letters, and river ferry timetables to determine the safe transit window and northern destination.



1. Textile Legend Motif



2. Nautical Compass Card
(points North-Northwest)

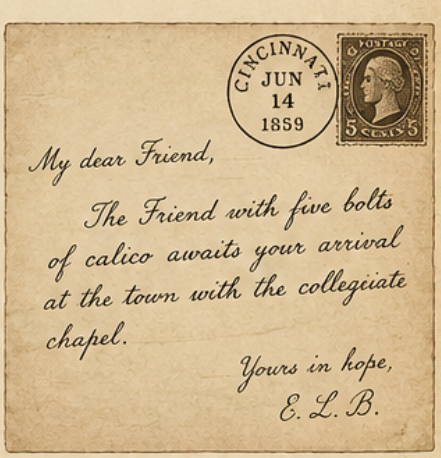

3. Coded Abolitionist Letter
(facsimile, 1859)

Station Clue A: Textile Legend Motif.

- The visual pattern displays a central star encircled by migratory directional wedges pointing due North-Northwest.

Station Clue B: Ripley River Crossing Ledger.

- Skiff operators confirm crossing must occur between 23:00 and 02:00 during new moon slack water to bypass patrol skiffs.

Station Clue C: Coded Abolitionist Letter.

- "The Friend with five bolts of calico awaits your arrival at the town with the collegiate chapel."

Abolitionist Field Instructions

Trust no unsolicited messanger. Verify every route milestone using two independent navigational markers before moving past the Ohio shoreline.

Which Ohio River crossing point and directional heading preserves safe passage based on patrol intervals and star trails?

1 Ferry crossing attempted at midnight near Cincinnati under heavy patrol lighting.



Immediate interception.
Reroute eastward toward Ripley bluffs following Polaris at a 330-degree azimuth.

2 Skiff crossing initiated at slack tide from Rankin House lantern signal toward the northern interior.



Safe crossing confirmed.
Advance north along the Scioto river valley toward the Oberlin network nexus.

Student Route Log & Investigation Worksheet

Name: _____ Class: _____ Date: _____



Student Route Log & Investigation Worksheet

Record your team findings below. Each entry must provide historical textual evidence and coordinate justification derived directly from your station dossiers.

- Record the exact celestial markers used to confirm north alignment.
- Identify the symbolic interpretation of the Flying Geese quilt pattern.
- Calculate the departure time window to evade the Ohio River revenue patrol.
- Name the ultimate terminus city identified in the coded conductor dispatch.

1. Investigative Team Name / Operative Number

_____

2. Celestial Marker Identification & Polaris Angle

_____

_____

3. Pattern Symbolism Analysis (Geometric Motif Clue)

_____

_____

4. Ohio River Safe Transit Window & River Station

_____

_____

5. Final Safehouse Destination & Conductor Verification Passphrase

_____

_____

_____

Master Answer Key & Historiographical Debrief



Name: _____ **Class:** _____ **Date:** _____

Educator Solution Key & Historical Debrief

Use this master solution guide to evaluate student submissions and lead a structured classroom historical critique exploring historical documentation versus 20th-century mythologies.

- **Celestial Alignment:** The Big Dipper (Ursa Major) pointing toward Polaris (North Star) establishes constant true-north alignment.
- **Geometric Motif:** Flying Geese pattern indicates shifting route vectors toward seasonal migratory flyways heading North-Northwest.
- **River Transit Window:** Slack water window between 23:00 and 02:00 at Ripley, Ohio, guided by the hilltop lantern of Reverend John Rankin.
- **Final Terminus:** Oberlin, Ohio, leading outward to Lake Erie schooners bound for Ontario, Canada.

Debrief Discussion Starter

Guide students to evaluate why physical artifacts like quilts capture popular memory, while clandsstine networks primarily relied on memory, oral signals, geography, and courageous community defense.

Steps for Historical Analysis

1 Evidence Verification

Review student Route Logs to ensure conclusions reference artifact details rather than modern assumptions.



2 Historiographical Analysis

Discuss the difference between documented 19th-century abolitionist vigilance records (such as William Still's journal) and late-20th-century oral folklore.



The Meiji Restoration Bureau: The Modernization Blueprint - Facilitator Guide

Name: _____ Class: _____ Date: _____

Teacher Facilitator Briefing: The Meiji Modernization Bureau

Facilitator Guide: Mission Parameters & Room Setup



This historical challenge immerses secondary and upper primary students into the early Meiji period (circa 1868–1872). Working as advisors within the newly established Ministry of Public Works (Kōbushō), teams collaborate to solve three sequential modernization puzzles: deciphering the telegraph route grid, codifying the five articles of the Charter Oath, and establishing navigational customs protocols across open treaty ports. Total recommended run time is 45 to 55 minutes.

- Divide the classroom into teams of 3 to 5 students and provide one full packet per team.
- Ensure each group has a ruler, scrap drafting paper, and two distinct color pencils.
- Stations can be completed sequentially in place or placed across three physical room stations.
- Facilitators should verify station passcodes before issuing the final verification seal.

Pacing & Clue Policy

If a team stalls for more than 7 minutes on the telegraph cipher, guide them to examine the transmission pole coordinates along the Tōkaidō corridor rather than counting every intersection.

Setup Steps

1 Station Preparation



Print Pages 2 and 3 for each student team. Prepare Station Verification Slips or write the master lock sequence on the board behind a cover sheet.

2 Mission Briefing



Read aloud the ministerial directive. Establish the classroom premise: teams represent junior bureau clerks tasked with securing imperial infrastructure before the arrival of foreign diplomatic observers.

3 Verification & Debrief



When teams assemble all three station passcodes, check their final Blueprint Matrix on Page 4 and conduct the brief historical debrief linking these policies to rapid industrialization.

Decision

Is the team attempting to bypass the Charter Oath clause pairing by guessing keyword combinations?

Team matches fewer than 3 clauses correctly

Require the team to cite the exact line from the 1868 Imperial proclamation text before accepting their oath digit.

Team demonstrates accurate textual pairing

Initial Station Box II on their Blueprint Master Log and release the treaty port navigation overlay.

Puzzles I & II: Telegraph Grid and Charter Oath Pairings

Name: _____ Class: _____ Date: _____

Station I: The National Telegraph Route Grid

In the early 1870s, the Meiji government priortiized rapid communications between the old imperial capital and emerging industrial hubs. An encoded transmission line must be established connecting Tokyo (Edo), Yokohama, Osaka, and Nagasaki. Examine the grid coordinates and decipher the route relays using the telegraph pole numerical key.

- Grid Axis: East-West runs from Column 01 to 08; North-South runs from Row A to Row H.
- Relay Alpha starts at Tokyo Central Hub [B, 03] and advances 3 units South, 2 units West.
- Relay Beta originates at Kyoto Junction [E, 02] and steps along the Tokaido post-road markers.
- Each relay node reveals one letter of the ministerial authorization code word.



Historical Context: Ministry of Public Works

Telegraph lines were often constructed alongside initial railway routes, requiring strict civil engineering standards to prevent winter cable breaks.

	01	02	03	04	05	06	07	08
A								
B								
C								
D								
E								
F								
G								
H								



Telegraph Pole Numerical Key

1 = North 2 = East 3 = South 4 = West

Imperial Charter Oath

1. *Establish a deliberative assembly and seek the public good.*
2. *Unite all classes in the administration of state affairs.*
3. *Allow each person to pursue their own calling.*
4. *Break off evil customs and follow the laws of Nature.*
5. *Seek knowledge throughout the world to strengthen the imperial rule.*

1 **Decoded Node Alpha Station Coordinates**

_____

2 **Decoded Node Beta Station Coordinates**

_____

3 **Station I Passcode Word**
(Extracted from grid intersections)

_____

_____

Station II: The Charter Oath Clause Pairings

Promulgated in April 1868, the Five Charter Oath outlined the modernization philosophy of Emperor Meiji. Bureau clerks must pair each excerpted clause with its corresponding reform policy to extract the numerical index sequence required for the imperial seal.

- Clause A: Deliberative assemblies shall be widely established and all matters decided by open discussion.
- Clause B: All classes, high and low, shall be united in vigorously carrying out the administration of affairs of state.
- Clause C: Common people, no less than civil and military officials, shall each be allowed to pursue their own calling.
- Clause D: Evil customs of the past shall be broken off and everything based upon the just laws of Nature.
- Clause E: Knowledge shall be sought throughout the world so as to strengthen the foundations of imperial rule.



Authentication Rule

Every clause index number corresponds to the chronological order of the oath. Add the digits of policies representing overseas study missions and abolition of feudal class restrictions.

1 **Policy 1 Match:**
Dispatch of the Iwakura Mission abroad (Enter Clause Letter)

_____

2 **Policy 2 Match:**
Dissolution of four-tier caste system (Enter Clause Letter)

_____

3 **Policy 3 Match:**
Establishment of the Imperial Diet / Prefectural assemblies
(Enter Clause Letter)

_____

4 **Station II Master Numeric Key**
(Sum of matching indices)

_____

_____

Puzzle III & Final Challenge: Treaty Port Regulation Map

Name: _____ Class: _____ Date: _____











Station III: Treaty Port Regulation Map & Final Blueprint Matrix

Following the Ansei Treaties and revised Meiji commerce treaties, key ports handled incoming machinery, foreign technical advisors (*oyatoi gaikokujin*), and raw silk exports. Use the treaty port regulation chart below to verify entry manifests, calculate customs levies, and unlock the final modernization blueprint.

- **Port Hakodate:** Northern customs clearing depot; tariff rate set at standard 5% ad valorem.
- **Port Yokohama:** Primary steam locomotive machinery import center; exempt from local harbor surcharge.
- **Port Kobe:** High-volume silk and textile trading dock; mandatory sanitary inspection required.
- **Port Nagasaki:** Western coal bunkering depot; requires Dutch and British consular co-signature.

Master Passcode Assembly

Combine Station I Passcode Word + Station II Numeric Key + Port Clearance Acronym into the final verification strip.

1 Verify Incoming Manifest 104

Cargo: 400 metric tons of iron rails arriving at Yokohama. Calculate tariff exemption status and record port inspection stamp code.



2 Verify Outgoing Manifest 208

Cargo: 120 bales of raw silk cleared through Kobe. Confirm certificate of sanitary standards and determine designated export lane.



3 Assemble the Modernization Blueprint

Transcribe the three component keys into the master transmission line to complete the ministerial challenge.



Valid Export Lane Code for Port Kobe Manifest

_____

Cleared Port Clearance Acronym (Hakodate-Yokohama-Kobe-Nagasaki initials in order of cargo priority)

_____

FINAL BLUEPRINT UNLOCK CODE (Station I Word + Station II Number + Port Acronym)

_____

_____

通関
検査済

Bureau Master Solution Key

Name: _____ Class: _____ Date: _____

Comprehensive Facilitator Answer Key & Debriefing Notes

For teacher reference only. This section provides the verified solutions, decoding pathways, and educational discussion points for classroom debrief.

Challenge Station	Solution & Details
1 Station I: Telegraph Network 	• **Node Alpha:** Moving 3 units South from B (Row E) and 2 units West from 03 (Column 01) lands on [E, 01] (Yokohama Sub-Relay). Node Beta intersects at [G, 04]. • **Station I Passcode Word: KOKUSEI** (National Governance) or KOBUSHO (Public Works Ministry), depending on telegraph cipher key orientation.
2 Station II: Charter Oath Clauses 	• **Clause Matching:** Policy 1 (Iwakura Mission) = Clause E (Article 5); Policy 2 (Class Dissolution) = Clause C (Article 3); Policy 3 (Assemblies) = Clause A (Article 1). • **Master Numeric Key:** 5 + 3 + 1 = 09.
3 Station III: Port Clearance 	• Yokohama machinery is tariff-exempt; Kobe raw silk routed to Export Lane 2 (Sanitary Cleared). • **Clearing Acronym:** Y-K-H-N.
4 Final Blueprint Unlock Code 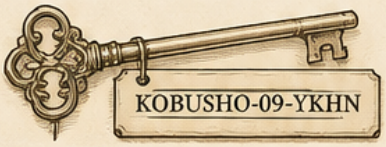	• **Final Blueprint Unlock Code:** KOBUSHO-09-YKHN.



Curriculum Debrief Questions

How did telegraph lines and port modernization safeguard national autonomy?

In what ways did the Charter Oath balance traditional imperial authority with progressive social restructuring?

TRENCH RUNNER DISPATCH

Facilitator Dossier & Field Briefing

Name: _____ Class: _____ Date: _____

Teacher Briefing & Mission Briefing

This tactical escape challenge simulates field communications during November 1918 on the Western Front. Student teams take the role of Allied signals couriers tasked with verifying an intercepted transmission, calculating field telephone line circuit resistance across damaged communication trenches, and delivering an authenticated armistice cease-fire dispatch before zero hour.



- **Curriculum Focus:** World War I military technology, telecommunications history, Morse code, and map coordinate interpretation.
- **Team Setup:** Organize learners into runner sections of 3 to 5 students, supplying scrap paper and pencils.
- **Operational Target:** Decipher all three stages within a standard 45-to-50 minute classroom period.

Facilitator Preparation

Print Clue Cards and Cipher Modules prior to class. Stage 1 Morse tape, Stage 2 Trench Grid, and Stage 3 Wire Relay can be distributed simultaneously or staged sequentially as locked checkpoints.

1 Phase 1: Intercept Extraction

Direct teams to decode the Morse audio/paper tape record from the Forward Listening Post to isolate the three-word authentication passphrase.



2 Phase 2: Sector Map Traversal

Teams use the coordinate key to plot safe transit across Sector Red-9, avoiding artillery craters to identify the intact switchboard bunker.

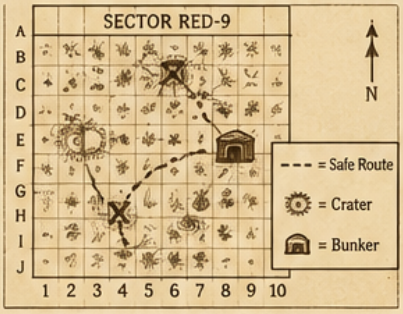

3 Phase 3: Relay Line Balancing

Runners calculate telephone wire circuit values to patch the central junction box and complete the final armistice authentication code.



Assigned Signal Squad Number	Dispatch Start Timestamp
_____	_____

Which communication relay route exhibits intact field wire?

Route Alpha passes cratered zone Sector 4B

↓

Divert wire team immediately to Trench Line Bravo to prevent line grounding.

Route Bravo displays 60 Ohms balanced impedance

↓

Proceed with telephone patch and key the final Morse confirmation pulse.

Signals Intercept & Sector Navigation

Name: _____ Class: _____ Date: _____

Stage 1: Intercepted Morse Code Transmission

A listening post runner recovered an electro-magnetic telegraph ticker tape from the mud near Saint-Quentin. Several characters were obscured by rain, but the core broadcast is intact. Use the standard military telegraph table provided on your cipher strip to reconstruct the incoming transmission.

- **Transmission Record:** .- .-.. .-.. / -.-. .- -. -. --- -.. ... / ... .. .-.. . -. -.-. . / .---- .---- ----- -----
- **Encrypted Checkword:** -.-. .- ... . / ..-. .. .-. .

Telegraph Cipher Table

A (.-)	J (.---)	S (...)
B (-...)	K (-.-)	T (-)
C (-.-.)	L (.-..)	U (..-)
D (-..)	M (--)	V (...-)
E (.)	N (-.)	W (.--)
F (..-.)	O (---)	X (-..-)
G (--.)	P (.--.)	Y (-.--)
H (....)	Q (--.-)	Z (--..)
I (..)	R (.-.)	



Decoded Header Transmission Text

_____

_____

Authentication Checkword

_____

Signals Intercept & Sector Navigation

Name: _____ Class: _____ Date: _____

Stage 2: Trench Sector Grid Map

Artillery shelling has fragmented communication line conduits across Sector Red-9. To route the runner safely between Observation Post Delta and the Division Switchboard, trace the coordinates that match uncompromised trench sections.

- **Grid Coordinates:** OP Delta is located at Grid Reference [A-3]. Division Switchboard is located at Grid Reference [D-1].
- **Crater Hazards:** Coordinates [B-2], [C-2], and [C-3] are completely destroyed by heavy howitzer fire.
- **Passable Conduits:** [A-3] connects safely to [B-3]; [B-3] connects safely to [B-4]; [B-4] connects to [C-4]; [C-4] connects to [D-4]; [D-4] connects through [D-2] to [D-1].

Map Hazard Warning

Entering any coordinate adjacent to active gas release at [C-1] imposes a 5-minute penalty on runner squad dispatch time.

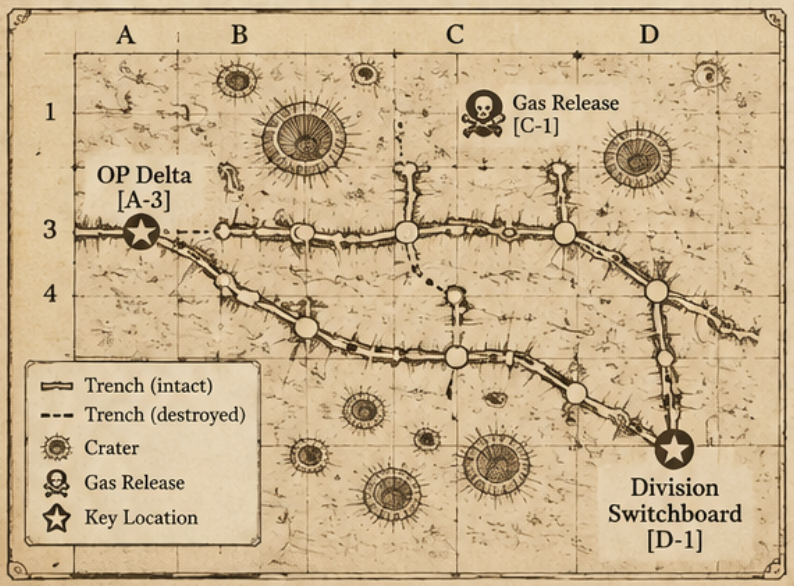

1 Plot Safe Trench Traverse

Draw the continuous runner vector from [A-3] to [D-1] utilizing only verified intact trenches.

2 Sum Sector Distance Markers

Add distance units across each cleared sector (A3-B3 = 120m, B3-B4 = 80m, B4-C4 = 150m, C4-D4 = 90m, D4-D2 = 140m, D2-D1 = 60m).

Total Safe Transit Distance (Meters)

_____

Validated Checkpoint Path Sequence

_____

_____

Relay Circuit & Facilitator Master Key

Name: _____ Class: _____ Date: _____

Stage 3: Field Telephone Switchboard Relay

Inside the fortified redoubt, the D-Mark III field switchboard requires precise line impedance balancing before the magnetos can drive the telegraph alarm across divisional headquarters.

- **Line Terminal 1**: Rated at 25 Ohms line resistance.
- **Line Terminal 2**: Rated at 15 Ohms line resistance.
- **Line Terminal 3**: Variable shunt must balance the total circuit loop to exactly 70 Ohms in series.
- **Master Key Calculation:** Line 1 + Line 2 + Line 3 = 70 Ohms.

Electrical Rule

All terminals connect in series. To close the circuit, find the value of Terminal 3, then convert that integer into the corresponding letter of the alphabet (1=A, 2=B, etc.).



D-Mark III Field Telephone Switchboard

Terminal 3 Resistance Value (Ohms)

_____

Relay Circuit Keycode Letter / Final Number

_____

Mission Solution & Teacher Verification Master

This confidential key enables the instructor to rapidly evaluate student submissions, offer targeted hints, and confirm final mission completion.

- **Stage 1 Verification:** 'ALL CANNONS SILENCE 1100' and Checkword 'CEASE FIRE'.
- **Stage 2 Verification:** Total safe distance equals 640 meters. Path sequence: A3 -> B3 -> B4 -> C4 -> D4 -> D2 -> D1.
- **Stage 3 Verification:** Terminal 3 value is 30 Ohms (70 - 25 - 15 = 30). Letter conversion yields code '30-BELL'.
- **Master Dispatch Formula:** Combine [CEASE FIRE] + [640] + [30] for final dispatch clearance code: **CEASE-FIRE-640-30.**

Debriefing Discussion Prompt

Conclude the exercise by discussing the technological challenges of early 20th-century battlefield communication and why runners were still required despite telegraph wires.



Class Completion Record / Winning Squad Name

_____

Debrief Notes & Historical Connections

_____

_____

THE ROARING TWENTIES SPEAKEASY: LEDGER OF THE VOLSTEAD ACT

Name: _____ Class: _____ Date: _____

Teacher Facilitator Briefing: Operation Volstead Ledger

Facilitator Briefing & Classroom Setup Guide



This historical escape challenge places learners into the roles of federal prohibition agents investigating a covert bootlegging syndicate operating out of a 1920s Chicago jazz venue. Students examine constitutional amendments, analyze encrypted shipping manifests, crack combination lock ciphers, and synthesize economic and political factors that drove both organized crime and public resistance during the Prohibition era.

- Recommended duration: 45 to 60 minutes for student teams of 3 to 5 investigators.
- Print Station 1 (The Speakeasy Entryway) and Station 2 (The Smuggler Manifest) for each team.
- Ensure each group has scratch paper, pencils, and access to the clues embedded on each sheet.
- Station 3 serves as the master debrief and constitutional synthesis ledger.

Facilitator Tip

For added classroom immersion, dim the lighting slightly or play soft instrumental 1920s jazz. Have teams submit their final 4-digit master code to unlock the confiscated ledger before the timer expires.

Investigation Steps

1 Assemble Investigation Squads

Divide the class into small teams. Distribute the Student Clue Ledger and station sheets face down until the session timer begins.

2 Verify Station Checkpoints

Students must solve the lock combination cipher on Page 2 before deciphering the maritime shipping manifest on Page 3.

3 Final Case Submission

Teams correlate constitutional timeline dates with smuggled supply weights to reveal the master raid code.



Are students struggling to extract cipher letters from the speakeasy door code?

Team cannot align cipher shifts
Remind students that the Volstead Act was enacted under the 18th Amendment. Prompt them to test an alphanumeric shift value equal to eighteen minus ten.

Team progresses ahead of time limit
Introduce the extension challenge requiring teams to write a 3-sentence legal brief citing why the 21st Amendment eventually superseded this enforcement.

Name: _____ Class: _____ Date: _____

Investigation Station 1: The Speakeasy Backdoor Lock

Station 1: The Speakeasy Backdoor Lock

Federal agents have traced a suspected distribution point to an alley behind the Green Mill in Chicago. A heavy brass padlock guards the basement entrance, bearing an engraving: "The Law was ratified in 1919, enacted under the 18th Amendment, and enforced by Andrew Volstead." Decipher the coded inscription carved into the door frame to discover the four-digit bypass sequence.

- **Clue A:** The first digit equals the number of constitutional amendments passed between 1913 and 1920 (16th, 17th, 18th, 19th).
- **Clue B:** The second digit is the final digit of the year the 18th Amendment was ratified by the states.
- **Clue C:** The third digit represents the maximum legal percentage of alcohol by volume permitted under strict Volstead exemptions (0.5% rounded up to the nearest whole integer).
- **Clue D:** The fourth digit is the difference between the Amendment that enacted Prohibition and the Amendment that repealed it in 1933.

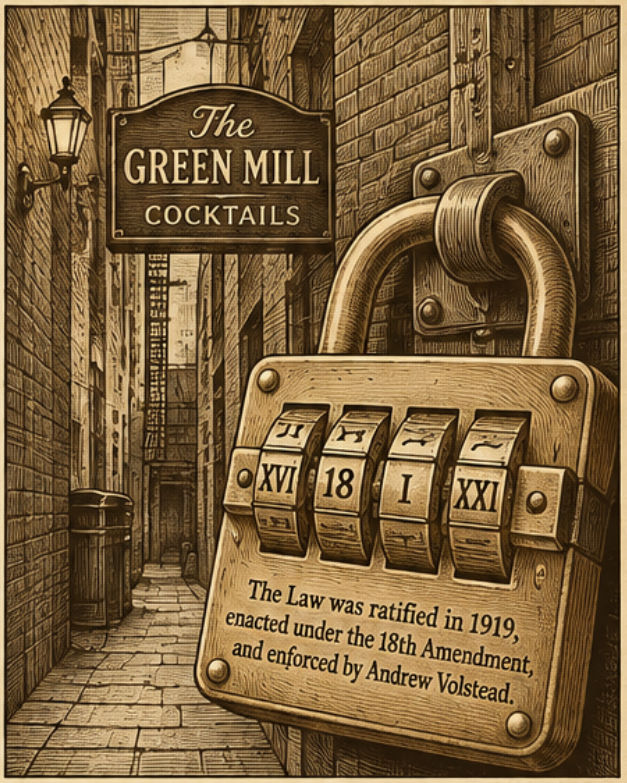

Investigator Note

Review your constitutional timeline. The 18th Amendment prohibited manufacture, sale, and transport of intoxicating liquors, but was repealed in 1933 by the 21st Amendment.

1 Calculate Clue A (Constitutional Surge)

Count the Progressive Era amendments ratified from 1913 through 1920: 16th (Income Tax), 17th (Direct Election of Senators), 18th (Prohibition), and 19th (Women's Suffrage). Total count = 4.



2 Calculate Clue B (Ratification Year)

Nebraska became the 36th state to ratify the 18th Amendment on January 16, 1919. The final unit digit of 1919 = 9.



3 Calculate Clue C (Volstead Threshold)

Under Title II of the National Prohibition Act, any beverage containing 0.5% or more alcohol by volume was deemed intoxicating. Rounded up to the nearest whole integer = 1.



4 Calculate Clue D (Repeal Difference)

Subtract the prohibition amendment number (18) from the repeal amendment number (21).

Calculation: 21 - 18 = 3.



Decoded Door Code [Digit 1, Digit 2, Digit 3, Digit 4]:

_____

Historical Rationale & Amendment Notes:

_____

_____

_____

Name: _____ Class: _____ Date: _____

Investigation Station 2:
The Smuggler's Manifest

Station 2: The Bootlegger's Shipping Manifest

Inside the basement office, agents uncover a partially charred cargo ledger detailing illicit shipments delivered across Lake Michigan from Windsor, Ontario to Chicago docks. Crates are disguised under cover labels such as 'Industrial Solvents', 'Sacramental Wine', 'Malt Tonic', and 'Canned Peaches'. Cross-reference the ledger entries against federal exemptions under the Volstead Act to pinpoint the illegal cargo crates.

- **Manifest Entry Alpha:** 120 crates 'Sacramental Wine' consigned to St. Jude Parish with verified rabbinical/clerical clergy permit #412.
- **Manifest Entry Beta:** 450 barrels 'Industrial Denatured Alcohol' delivered to Northside Paint Works, missing required methanol bittering additive stamps.
- **Manifest Entry Gamma:** 300 barrels 'Malt Tonic' testing at 4.2% alcohol by volume, lacking medicinal prescription paperwork from registered physicians.
- **Manifest Entry Delta:** 200 crates 'Canned Peaches' containing false wooden bottoms concealing 1,200 bottles of Canadian rye whiskey.



Legal Evidence Warning

Section 6 of the Volstead Act permitted sacramental wine and limited medicinal alcohol prescribed by licensed physicians. Cargo without valid federal permits constitutes contraband subject to seizure.

Application Steps

1 Audit Clerical & Medicinal Exemptions

Verify whether Entry Alpha meets exemption criteria. Because documentation is valid, Entry Alpha is lawful cargo and dismissed from seizure.

2 Inspect Industrial Chemical Adulteration

Analyze Entry Beta. Industrial alcohol required chemical denaturing to deter consumption. Missing stamps indicate diversion into illicit speakeasy pipelines.

3 Calculate Total Seizure Weight

Sum the contraband barrels and crates across entries Beta (450), Gamma (300), and Delta (200).

450 + 300 + 200 = 950 seized containers.

Identified Contraband Entries [Circle: Beta / Gamma / Delta]: Beta / Gamma / Delta

Total Number of Unlawful Containers Seized: _____

Syndicate Supply Network Route Summary:

_____

_____

_____

Name: _____

Class: _____

Date: _____

Facilitator Master Key & Debrief Guide

Station 3: Teacher Answer Key & Debrief Master

Facilitator master reference sheet containing verified puzzle solutions, historical background context, and classroom inquiry discussion prompts regarding the enforcement challenges and socioeconomic consequences of National Prohibition.

VERIFIED SOLUTIONS

1 **Station 1 Door Code Solution:**

4 - 9 - 1 - 3

(4 Progressive amendments, 1919 ratification year, 0.5% rounded up to 1, 21 - 18 = 3).



2 **Station 2 Manifest Solution:**

Contraband entries are Beta, Gamma, and Delta.
Total unlawful units seized: 950 containers.



3 **Master Raid Confirmation Cipher:**

4913-950.



4 **Curricular Connections:**

Analyzes the Progressive reform impulse, the 18th and 21st Amendments, unintended rise of organized syndicates, and challenges in federal law enforcement.



Historical Inquiry Discussion

Ask students: Why was the Volstead Act so difficult to enforce in large urban centers like Chicago, New York, and Detroit compared to rural regions? Examine geographic proximity to international borders and public resistance.

Bletchley Park Cryptanalysis Room — Teacher Mission Guide



Name: _____ **Class:** _____ **Date:** _____

Facilitator Mission Briefing & Classroom Deployment Guide

This operational cryptanalysis escape room immerses secondary students into Hut 8 at Bletchley Park during 1941. Working in investigative intelligence sections, student cryptanalysts must reconstruct daily naval Enigma machine settings, decode intercepted radio ciphertext, and plot Atlantic convoy threat vectors before Axis wolfpacks strike.

- **Curricular Focus:** World War II intelligence history, mathematical logic, transposition and substitution ciphers, and cartographic plotting.
- **Team Setup:** Divide the class into intelligence cells of 3 to 5 operatives, equipping each station with Station Packets A through C and scratch paper.
- **Facilitator Role:** Act as Hut 8 Watch Commander; enforce operational radio silence and dispense time-penalty hint cards only upon formal written request.

Classroom Timing Protocol

Allocate exactly 45 minutes of puzzle operations following a 5-minute briefing. Every unearned hint adds a 3-minute operational delay to final cell clearance times.

1 Step 1: Operational Staging

Distribute Clue Sheet 1 (Rotor Selection), Clue Sheet 2 (Plugboard & Steckerbrett Decryption), and Clue Sheet 3 (Naval Grid Telemetry) face-down to each intelligence desk.



2 Step 2: Timed Cipher Run

Start the master classroom stopwatch. Direct teams to complete Phase 1 rotor ordering before attempting Phase 2 wire pairs, as cipher wheels cascade linearly.



3 Step 3: Verification & Debrief

Collect completed Axis interception coordinates, compare student solutions with the verified Hut 8 master ledger, and conduct the historical Ultra debrief.



? What is the cell's current obstacle during decoding?

Team cannot identify correct rotor wheel sequence

↓

Instruct students to verify frequency analysis of German military callsigns: the reflector UKW-B never pairs an alphabet letter with itself.

Decrypted naval grid yields open ocean coordinates far from convoy routes

↓

Direct the cell cartographer to cross-check letter transposition on the Steckerbrett plugboard pairs before plotting latitude degrees.

TOP SECRET —
HUT 8 NAVAL SECTION





Rotor I Rotor II Rotor III



Plugboard

Hut 8 Operative Briefing & Station Log

Hut 8 Operative Briefing & Station Log

TOP SECRET — ROYAL NAVAL ESCORT COMMAND.

An encrypted Kriegsmarine radio dispatch was intercepted by Admiralty listening posts at 0400 hours. Your cell must reconstruct the daily machine configuration using captured German weather trawler documents, decode the enciphered text, and extract the targeting sector of U-boat Wolfpack West.

- ☐ **Rule 1:** Enigma machines never encipher any letter as itself (Self-Reciprocal Invariant).
- ☐ **Rule 2:** Rotors advance right-to-left with specific notch turnovers (Rotor I turns on Q, Rotor II turns on E, Rotor III turns on V).
- ☐ **Rule 3:** Maintain total intelligence compartmentation; sharing decrypted coordinate keys with rival tables constitutes a security breach.

Historical Context: Ultra Security

The British intelligence derived from Bletchley Park was codenamed ***Ultra***. To protect the secret that Enigma was broken, Allied command only acted on intercepts when a plausible alternate reconnaissance source could be feigned.

Operative Intelligence Cell Designation (e.g., Section Hut 8-C):

Assigned Cryptanalysts (Full Names):

Station Log Entry — Cipher Intercept Reception Time & Rotor Initial Positions:

Name: _____ Class: _____ Date: _____

Stage 1: Rotor Wheel Assembly & Offset Decryption

Stage 1 Clue Sheet: Rotor Wheel Assembly & Offset Decryption

Inspect the captured Kriegsmarine monthly key list excerpt below. Axis telegraph operators set their rotors each midnight eccording to a pre-shared codebook, but an error in the operator's test send reveals mechanical turnover patterns.

- **Captured Fragment Alpha:** The daily machine uses Rotors I, II, and IV in an unknown order.
- **Captured Fragment Beta:** The middle rotor turned over its left neighbour immediately when wheel letter 'E' advanced to 'F'.
- **Captured Fragment Gamma:** The fast (rightmost) rotor was verified to not be Rotor I.
- **Deduction Rule:** Rotor turnover notches are I=Q, II=E, III=V, IV=J, V=Z.

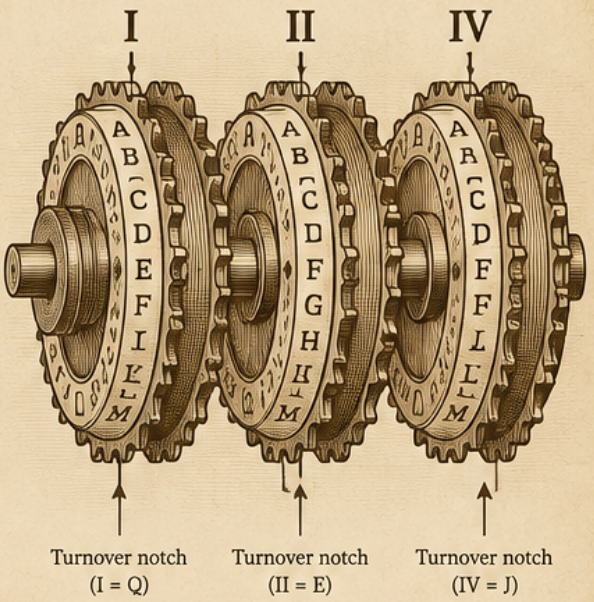

Machine Rule Verification

Because the **middle** rotor triggered a turnover at 'E', the **middle** position MUST **be Rotor II.** Use the elimination clues to order the left and right positions.

1 Rotor Identification

Identify which rotor occupies the Left slot, Middle slot, and Right slot using Fragments Alpha, Beta, and Gamma.

2 Ground Setting Ringstellung Deduction

Apply the ring offsets: Left Rotor offset +02, Middle Rotor offset +05, Right Rotor offset +01. Record the resulting three-letter **initial key.**

Captured Signal Log Excerpt

Kriegsmarine – Monthly Key List (Partial)

Date	Time	Message (cipher text)
12.04.	00:17	QZKJX FVTMN BPLDG
12.04.	06:43	NHTQG XZLVP KJBDM
12.04.	11:26	MZVLT QFJNR DKBPG
12.04.	16:52	TQJMP LZVNB XFGKD

Cipher Text (for Analysis)

QZKJX FVTMN BPLDG NHTQG XZLVP
KJBDM MZVLT QFJNR DKBPG TQJMP

1 Deducted Rotor Order (Left / Middle / Right):

_____

2 Initial Rotor Key Window Setting (3 letters):

_____

3 Mathematical Justification & Elimination Scratchpad:

_____

_____

_____

_____

Name: _____ Class: _____ Date: _____

Stage 2: Steckerbrett Plugboard & Transposition Grid



Stage 2 Clue Sheet: The Steckerbrett Plugboard & Transposition Grid

Before before electrical current entered the Enigma rotor stack, it passed through the Steckerbrett (plugboard), which swapped exactly six pairs of letters. A captured weather report confirms that the standard weather preamble 'WETTER' enciphered into the six-letter ciphertext below.

- Known Plaintext Preamble (Crib): W - E - T - T - E - R
- Raw Electrical Output from Rotors: K - A - X - X - A - D
- Intercepted Ciphertext Broadcast: M - E - Z - Z - E - P
- Steckerbrett Wiring Logic: Letters not swapped on the plugboard pass through unchanged (self-steckered).

Cryptanalysis Technique: Crib Matching

Compare the Raw Electrical Output against the Intercepted Ciphertext. Any letter difference indicates a plugboard wire pair.

For example, if output K appears as M in transmission, K and M are wired together.

1 Pair Matching

Identify all swapped pairs by linking each Rotor Electrical Output character to the corresponding Intercepted Broadcast character.

Rotor Output	K	A	X	X	A	D
Intercepted	M	E	Z	Z	E	P

2 Decryption Matrix Application

Apply your recovered Stecker pairs to decode the secondary intercept phrase: 'P A X X M'.



Identified Steckerbrett Pairs
(format A-B, C-D...):

_____

_____

_____

_____

Decoded Tactical Word
('P A X X M' translated):

_____

Stage 3: Naval Telemetry & Wolfpack Coordinate Plot





Name: _____ Class: _____ Date: _____

Stage 3 Clue Sheet: Naval Telemetry & Wolfpack Coordinate Plot

With the Enigma daily setting and plugboard recovered, decode the final tactical transmission intercepted from Axis Admiral U-boats. The recovered text contains alphanumetric coordinate indicators used on the Kriegsmarine Marinequadratkarte (Naval Grid Chart).

- **Raw Ciphertext Dispatch:** 'HQJ BNW YMT KLL QPR'
- **De-steckered & Deciphered Text Stream:** 'K U R S D R E I V I E R N U L L Q U A D R A T B F Z W E I E I N S'
- **German Number Glossary:** DREI=3, VIER=4, NULL=0, ZWEI=2, EINS=1, KURS=Course, QUADRAT=Grid Square.
- **Target Convoy:** Allied Convoy HX-112 carrying vital food and aircraft parts across the North Atlantic.

Naval Grid Decoding Formula

Transcribe the German words into numerical operational telemetry: identify the attack course heading (3 digits) and the naval quadrant identifier (2 letters + 2 numbers).

1. **Decoded Enemy Heading / Course (Compass Degrees):**

2. **Targeted Marinequadrat Grid Identifier:**

3. **Tactical Action Order for Allied Escort Commander:**

Kriegsmarine Marinequadratkarte
Nordatlantik 1941

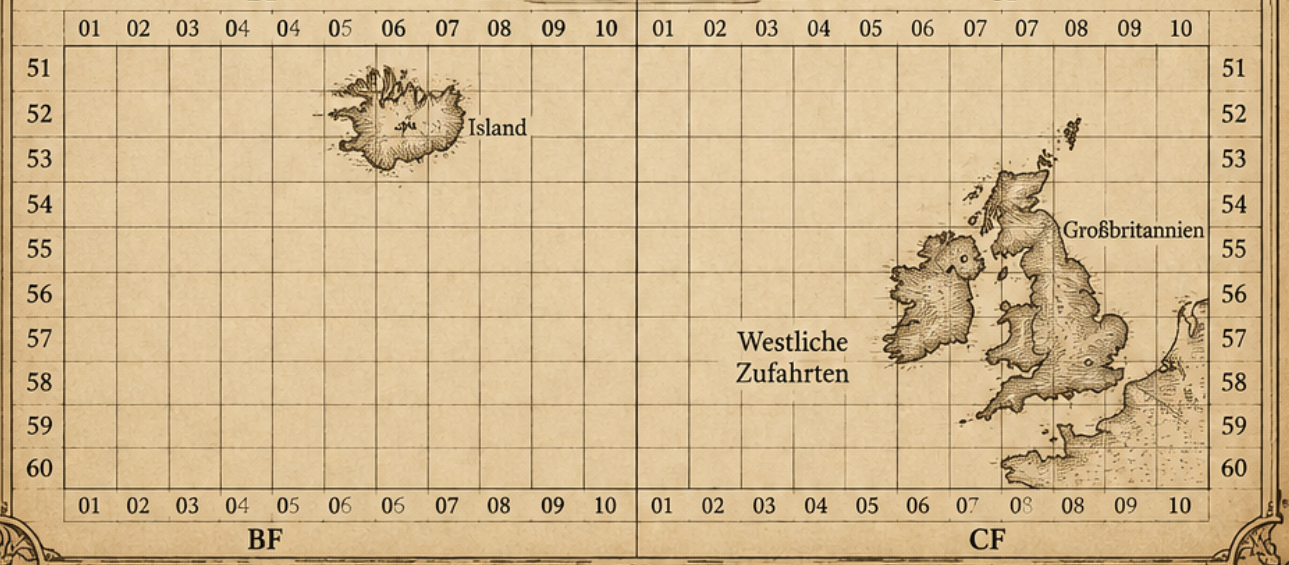

MASTER SOLUTION KEY — RESTRICTED DISTRIBUTION

Name: _____ Class: _____ Date: _____

Hut 8 Master Facilitator Solution Key & Historical Debrief

Master Facilitator Solution Key & Historical Debrief

FOR FACILITATOR EYES ONLY. Use this reference sheet to verify intelligence cell submissions, award mission clearance tokens, and conduct the post-simulation historical analysis.

Stage 1 Solution:

Rotor Order = I (Left), II (Middle), IV (Right).
Turnovers: Middle is II because turnover occurs at E; Right cannot be I, leaving Right as IV and Left as I.
Ring key = B - E - A.

Stage 2 Solution:

Plugboard Pairs = K-M, A-E, X-Z, D-P.
Decoded tactical word 'P A X X M' translates to 'R E T T E' (or tactical root 'RETTE' / save).

Stage 3 Solution:

Decoded Stream = 'KURS 3 4 0 QUADRAT BF 2 1'.
Heading = 340 degrees (North-Northwest).
Grid Square = BF-21 (located South of Iceland in the Western Approaches).

Historical Debrief Prompt:

Discuss Alan Turing and Gordon Welchman's electromechanical Bombe machine, which tested thousands of Enigma rotor combinations simultaneously to make this manual process viable at scale.

Facilitator Evaluation Rubric

Award **Full Clearance** if completed within 45 minutes with exact coordinates (Heading 340, Grid BF-21).
Award **Qualified Clearance** if completed with up to two hint penalties.

Cell Clearance Evaluation Notes & Awarded Time:

_____

_____

THE BOMBE MACHINE
A HISTORICAL DEBRIEF



Key Facts

- Developed by Alan Turing and Gordon Welchman.
- Used electromechanical methods to test thousands of Enigma rotor combinations simultaneously.
- Significantly reduced the time required to find the correct settings compared to manual methods.
- Helped make large-scale decryption possible during the war.

Why It Mattered

The Bombe machine turned a complex, time-consuming manual process into an efficient, automated search. It enabled the Allies to decrypt more Enigma messages, providing critical intelligence and a strategic advantage.



Name: _____ Class: _____

Date: _____

OPERATION COLD WAR DEAD DROP



Mission Dossier: Operation Stasi Dead Drop

Berlin, October 1961. The border between East and West Berlin has hardened into barbed wire and concrete barricades. A high-ranking informant codenamed 'Nightingale' holds intelligence detailing border guard shift rotations and safe corridor openings. Your unit has forty-five minutes to examine recovered intelligence artifacts: decrypting three microdot film rolls, mapping transit routes across closed ghost stations on the U-Bahn blueprint, and validating genuine visa stamps on an official transit manifest. Secure the clearance code to extract Nightingale safely through Checkpoint Charlie before sector patrol changes at midnight.

- Operate in counter-intelligence teams of 3 to 5 operatives.
- Analyze historical clues in sequence across Dossiers Alpha, Beta, and Gamma.
- Input three clearance keys into the final extraction protocol grid.

Historical Operating Context

Following August 13, 1961, transit between Soviet East Berlin and the Allied sectors was strictly militarized. Checkpoint Charlie (Allied Checkpoint C) served as the primary crossing point on Friedrichstraße for foreign diplomats, military personnel, and accredited Western visitors.

Field Team Identification & Section Operatives

_____

Mission Start Time / Authorized Time Allowance

_____

Operative Protocol: Intelligence Briefing & Setup

Review these mandatory handling rules before opening puzzle envelopes. Each intelligence module yields one numerical clearance coordinate required for Nightingale's transit pass.

- **Dossier Alpha:** Microdot Film Roll Decryption yields Coordinate X (01-99).
- **Dossier Beta:** Divided-City Subway Blueprint yields Coordinate Y (01-99).
- **Dossier Gamma:** Diplomatic Passport Stamp Verification yields Coordinate Z (01-99).

1 Stage 1: Microdot Inspection



Examine the photographic emulsion film frames. Count the total frequency of authentic Stasi division cipher marks versus decoy scratches to establish Coordinate X.

2 Stage 2: Ghost Station Triangulation



Trace the active western U-Bahn line passing underneath East Berlin territory without stopping, identifying the exact junction code for Coordinate Y.

3 Stage 3: Passport Seal Cross-Check



Compare seal watermarks, consular signatures, and issuance serial dates against the Soviet Sector Military Command roster to isolate Coordinate Z.

4 Stage 4: Clearance Code Submission



Assemble coordinates into the master formula [X + Y + Z = Clearance Code] and deliver to the station facilitator.

Dossiers Alpha & Beta: Microdot and Subway Intelligence

Name: _____ Class: _____ Date: _____

Clue Sheet Alpha: The Microdot Film Roll

Field agents recovered a hidden 35mm negative strip concealed inside the spine of an antique travel guide. Magnification reveals five distinct microdots photographed alongside technical schematics. Decode the optical matrix below to authenticate the genuine cipher roll.

- **Microdot 01:** Scratched emulsion shows 14 radio mast grid nodes.
- **Microdot 02:** Clear focal point displays 23 surveillance camera relays.
- **Microdot 03:** Decoy frame displays false transmitter blueprint (Discard).
- **Microdot 04:** Authentic cipher contains 19 frequency crystals.
- **Microdot 05:** Overexposed border contains 11 active wiretap relays.

35mm Negative Strip

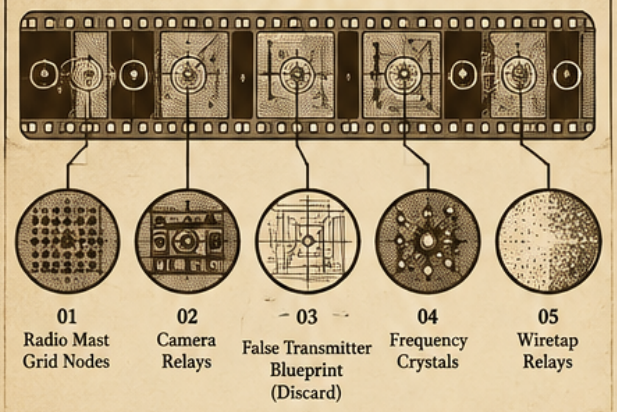

Decryption Rule

Sum the components of all authenticated microdots (01, 02, and 04 and 05). Decoy frame 03 contains an invalid Stasi stamp and must be excluded. Subtract the decoy number (8) from your sum to obtain Coordinate X.

1. **Authenticated Nodes Sum Calculation**

_____

_____

2. **Derived Coordinate X Value**

_____

Clue Sheet Beta: Divided-City Subway Blueprint

Underground Berlin lines U6 and U8 cross directly under East Berlin territory. Trains run slowly through darkened 'Geisterbahnhöfe' (Ghost Stations) guarded by armed border troops. Agent Nightingale left a safe route marked along transit grid intersections.

- **Station Nordbahnhof:** Sealed entrance, 2 armed sentries logged.
- **Station Unter den Linden:** 4 track guards active; detour south required.
- **Station Stadtmitte:** Clearance corridor open via secondary maintenance tunnel.
- **Station Französische Straße:** Blocked tunnel; tripwire acoustic sensor active.

Berlin U-Bahn – Divided Tunnels



Divided tunnels under East Berlin

Station Overview

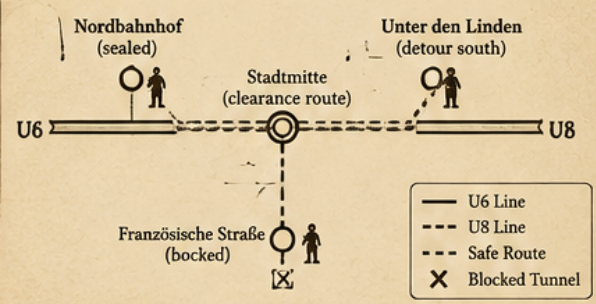

Transit Rule for Coordinate Y

Count the total number of unblocked platform pillars along the Stadtmitte clearance route (16 pillars) and multiply by the active western transit line number (Line 6). Then divide by the number of operational western border checkpoints (4). The result is Coordinate Y.

1. **Subway Route Triangulation Workspace**

_____

_____

2. **Derived Coordinate Y Value**

_____

Dossier Gamma & Extraction Terminal

Name: _____ Class: _____ Date: _____

Clue Sheet Gamma: Diplomatic Passport Stamp Verification

Four foreign diplomatic travel documents were collected at the Friedrichstraße checkpoint crossing booth. Only one contains genuine security stamps and dates conforming to October 1961 Allied Command sector travel directives.

- **Document A (Swedish Envoy):** Dated 14 October 1961; circular ink seal displays 12 stars; missing consular counter-signature.
- **Document B (Swiss Trade Attache):** Dated 18 October 1961; oval ink seal displays official 16-point rosette; certified by Allied Liaison Officer #37.
- **Document C (Austrian Journalist):** Dated 02 August 1961; issued prior to border wall construction; voided transit visa.
- **Document D (Finnish Cultural Delegate):** Dated 21 October 1961; square seal; incorrect Soviet sector commandant title.



Coordinate Z Formulation

Identify the only valid document (Document B). Take the rosette point count (16) and add the officer identification code (37). The resulting sum provides Coordinate Z.

Document Verification Rationale	Derived Coordinate Z Value
_____	_____

Name: _____ Class: _____ Date: _____

Checkpoint Charlie Final Clearance Protocol

Consolidate the intelligence coordinates derived across Dossiers Alpha, Beta, and Gamma into the master transit pass equation. If your calculated clearance code aligns with Allied Field Command instructions, Nightingale successfully enters the American Sector.

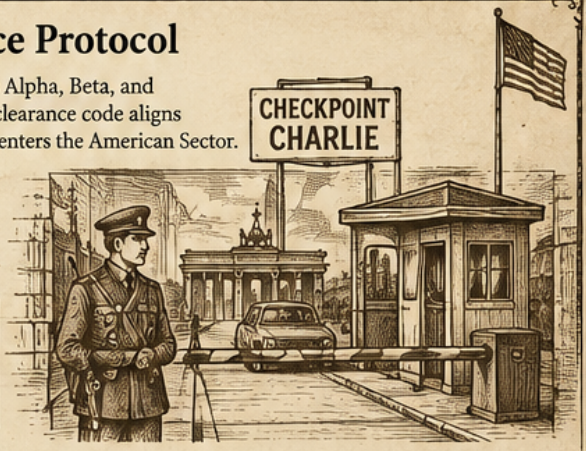

- Coordinate X (Microdot Emulsion Sum minus Decoy)
- Coordinate Y (Subway Blueprint Track Formula)
- Coordinate Z (Authenticated Diplomatic Pass Sum)

Border Security Warning

Border guards inspect identity documents precisely at 23:59. An incorrect sum alerts counter-surveillance, causing the corridor to close immediately.

Coordinate X Entry	Coordinate Y Entry	Coordinate Z Entry	Master Clearance Code [X + Y + Z]
_____	_____	_____	_____

Does your team clearance code match the duty officer roster threshold?

Sum is exactly 176

↓

Transmit clearance signal green: Nightingale crosses Friedrichstraße into the American Sector safely.

Sum is not 176

↓

Abort crossing immediately: Re-verify microdot counts, subway track math, and passport stamp values.

Facilitator Setup Guide & Solution Key

Name: _____ Class: _____ Date: _____

Facilitator Guide: Escape Room Administration

This guide provides educators with timing, classroom grouping, staging guidance, and differentiated hint structures for administering the Checkpoint Charlie espionage escape challenge.

Curriculum Alignment

Reinforces historical inquiry into the Berlin Crisis, Cold War geopolitical divisions, intelligence tradecraft, and human geography of divided Berlin post-August 1961.

- **Target Group Size:** 3 to 4 secondary school history students per active station.
- **Estimated Completion Time:** 40 to 50 minutes.
- **Recommended Staging:** Enclose Dossiers Alpha, Beta, and Gamma in manila envelopes labeled with red stamp markers.



Facilitator Steps

1. **Preparation** (10 Mins)
   Print worksheet dossiers for each student team. Place Clue Sheets Alpha, Beta, and Gamma into separate station folders or envelopes.
2. **Mission Launch** (5 Mins)
   Read the Mission Dossier narrative aloud to set historical atmosphere and explain scoring rules.
3. **Active Investigation** (30 Mins)
   Circulate during teamwork, providing Tier 1 or Tier 2 verbal hints if teams experience calculation bottlenecks.
4. **Debriefing & Synthesis** (10 Mins)
   Conclude by discussing why Berlin became the central flashpoint of espionage and ideological competition between 1945 and 1989.



Comprehensive Solution Key & Verification Index

Name: _____ Class: _____ Date: _____

Detailed historical solutions and arithmetic derivations for educator evaluation and immediate scoring.

1 Dossier Alpha

14 + 23 + 19 + 11 = 67; 67 − 8 (decoy) = 59.
Coordinate X = 59.

2 Dossier Beta

(16 unblocked pillars * Line 6) = 96;
96 / 4 checkpoints = 24.
Coordinate Y = 24.

3 Dossier Gamma

Document B is authentic; 16 rosette points + Officer 37 = 53.
Coordinate Z = 53.

4 Clearance Code Master Sum

59 + 24 + 53 = 176.

Rapid Verification Summary

Master Code: 176.
Agent Nightingale safely cleared across Checkpoint Charlie.



Facilitator Evaluation Notes & Group Debrief Observations

_____

_____

_____

_____

_____

APOLLO 11 FLIGHT CONTROLLER: MISSION OPERATIONS

Name: _____ Class: _____ Date: _____

Flight Controller Briefing & Mission Architecture

Mission Operations Briefing & Setup Guide

On July 20, 1969, Apollo 11's Lunar Module Eagle commenced powered descent toward the lunar surface. At 33,500 feet above the terrain, computer master alarms 1202 and 1201 began sounding in the cockpit and down telemetry lines into Mission Control Houston. As flight controllers, your team must decode mission telemetry, evaluate program alarm thresholds, recalculate descent propulsion burn margins, and calibrate the landing trajectory before fuel reaches the critical bingo limit. Facilitators should organize learners into three console teams: Guidance (GUIDO), Control (EECOM), and Retrofire/Telemetry (RETRO). Distribute Clue Packets Alpha, Beta, and Gamma sequentially as each checkpoint clearance is confirmed.

- Recommended duration: 45 to 60 minutes for upper primary and lower secondary classrooms.
- Print double-sided student telemetry worksheets and provide scratch paper for trajectory calculations.
- Stations operate cooperatively: all three telemetry vectors must align to achieve lunar touch-down authorization.



Facilitator Protocol

Do not disclose the master abort criterion in advance. Teams must independently calculate descent fuel margins and radar cycle load using the reference matrices provided.

1 Establish Flight Consoles



Divide the class into flight control teams. Assign roles: GUIDO (radar telemetry & landing coordinates), EECOM (propulsion & descent propellant mass), and RETRO (radar computational cycle overload).

2 Distribute Primary Telemetry Packets



Hand out Puzzle Station 1: The AGC 1202 Executive Overload Matrix. Teams have twelve minutes to determine whether to abort or proceed with descent.

3 Monitor Telemetry Milestones



Once Station 1 produces the four-digit program clearance vector, release Puzzle Station 2: Propellant Mass Delta-V telemetry.

4 Final Terminal Guidance Clearance



Teams combine results from Station 1 and Station 2 into Puzzle Station 3 to chart the manual avoidance vector around West Crater for touchdown confirmation.

Name: _____ Class: _____ Date: _____

Station 1: AGC 1202 Overload Telemetry

Station 1: Apollo Guidance Computer (AGC) 1202 Overload Matrix

The AGC operates on a cooperative executive operating system handling jobs by assigned computational priority. Radar pulses from the rendezvous radar are stealing 15 percent of the computer core cycles unexpectedly. Analyze the core memory stack below to determine whether core program cycles are dropping critical guidance commands (Priority 10 or higher). If non-critical radar cycles (Priority 1 to 5) are being dropped while guidance routines (Priority 15 to 30) remain intact, the executive rule states GO. Calculate the sum of active guidance priorities to obtain Terminal Code Alpha.

- Memory Bank 01: Radar Strobe Interlock — Priority 04 (Status: Dropped by Executive Buffer)
- Memory Bank 02: P63 Descent Engine Throttle Control — Priority 20 (Status: Active)
- Memory Bank 03: Rendezvous Range Shaft Angle — Priority 03 (Status: Dropped by Executive Buffer)
- Memory Bank 04: Inertial Measurement Unit (IMU) Attitude State — Priority 25 (Status: Active)
- Memory Bank 05: Landing Radar Altitude Verification — Priority 15 (Status: Active)

AGC DSKY DISPLAY



1202 Alarm Rule

A 1202 alarm indicates memory executive buffer overload. If the alarm does not recur continuously and descent guidance algorithms remain active, call GO for powered descent.

Total Active Guidance Priority Sum
(Terminal Code Alpha) _____

Executive Evaluation Callout
(Record GO or ABORT with mathematical justification)
_____
_____
_____

Does the AGC executive drop critical throttle or attitude guidance cycles?

- Critical guidance routines dropped (Priority >= 10 interrupted)
  - Issue immediate ABORT STAGE signal. Fire ascent propulsion system and return to lunar orbit.
- Only low-priority rendezvous radar tasks dropped (Priority < 10 dropped)
  - Issue GO callout. AGC is correctly shedding non-essential background cycles.

Station 2: Descent Propulsion & Propellant Telemetry

Name: _____ Class: _____ Date: _____

Station 2: Descent Propulsion Telemetry & Propellant Bingo Clock

Eagle has entered the terminal deceleration phase (P64). Fuel consumption rates have spiked due to manual pitch-over maneuvers commanded by Mission Commander Armstrong to clear a boulder field. Calculate remaining usable propellant from telemetry readings. At touchdown, Houston regulations mandate a minimum of 20 seconds of fuel remaining before immediate abort initiation. Calculate whether the current burn rate allows landing before fuel starvation.

- **Current Fuel Remaining:** 680 lbs of Aerozine 50 / Nitrogen Tetroxide
- **Descent Engine Mass Flow Rate at 60% Throttle:** 17 lbs per second
- **Estimated Altitude Above Surface:** 340 feet
- **Descent Velocity:** 12 feet per second vertical, 20 feet per second horizontal forward
- **Bingo Callout Threshold:** Propellant margin under 20 seconds remaining

Fuel Margin Warning

Slosh dynamics inside descent propellant tanks create sensor unporting. Rely on corrected gauge telemetry to prevent false abort signals.

Apollo Lunar Module Descent Stage

Propulsion System & Fuel Tanks

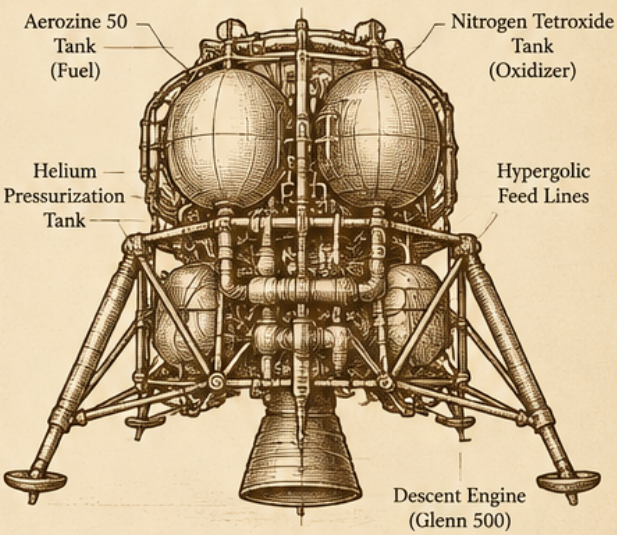

Hypergolic Piping Schematic

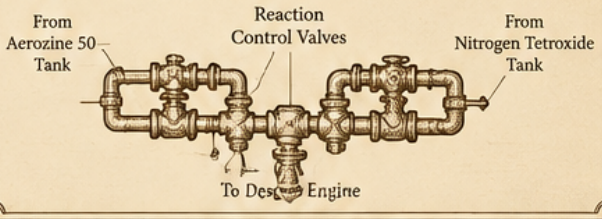

1 Step 1: Calculate Total Burn Time Remaining

Divide current remaining propellant (680 lbs) by the descent engine consumption rate (17 lbs/sec). Record total engine seconds available.

2 Step 2: Calculate Required Descent Seconds

Divide current radar altitude (340 feet) by vertical descent velocity (12 feet/sec). Round up to the nearest whole integer second.

3 Step 3: Determine Touchdown Fuel Buffer

Subtract required descent time from total engine burn time. Compare the resulting seconds against the mandatory 20-second abort limit to produce Terminal Code Beta.

Total Engine Seconds Available (Burn Time)

_____

_____

Touchdown Fuel Margin Seconds Remaining (Terminal Code Beta)

_____

_____

Telemetry Readings

Parameter	Value
Fuel Remaining (Aerozine 50 / N_2O_6)	680 lbs
Engine Mass Flow Rate (60% Throttle)	17 lbs/sec
Altitude Above Surface	340 feet
Vertical Velocity	12 ft/sec
Horizontal Velocity (forward)	20 ft/sec

Quick Calculations

1. Total Burn Time: 680 ÷ 17 = _____ sec
2. Required Descent Time: 340 ÷ 12 = _____ sec
3. Fuel Margin: _____ − _____ = _____ sec
4. Terminal Code Beta (≥ 20 sec?): _____

Result:

☐ Safe to Land ☐ Abort Required

Name: _____ Class: _____ Date: _____

Station 3:
Terminal Landing Coordinates & Avoidance Matrix

Station 3: Terminal Landing Coordinates & Avoidance Matrix

Eagle's landing radar and optical tracking indicate that the automatic guidance system is steering directly into the boulder-strewn apron of West Crater (Target Zone Baker). Armstrong has switched to semi-manual attitude control (P66). To determine the safe touchdown coordinate in the Sea of Tranquility, flight controllers must cross-reference grid offset coordinates against surface hazard elevation ratings. The safe touchdown point requires an obstacle slope under 5 degrees and a boulder diameter under 1.0 meter.

- ◯ **Site Alpha-1:**
  Latitude 0.6740° N, Longitude 23.4720° E — Boulder field: 3.2m diameter, Slope: 14° (UNSAFE)
- ◯ **Site Baker-2:**
  Latitude 0.6740° N, Longitude 23.4735° E — Crater rim edge: 1.8m boulders, Slope: 9° (UNSAFE)
- ◯ **Site Charlie-3:**
  Latitude 0.6741° N, Longitude 23.4710° E — Smooth mare plain: 0.3m boulders, Slope: 2.5° (OPTIMAL)
- ◯ **Site Delta-4:**
  Latitude 0.6738° N, Longitude 23.4700° E — Ridge depression: 1.1m boulders, Slope: 6° (MARGINAL)

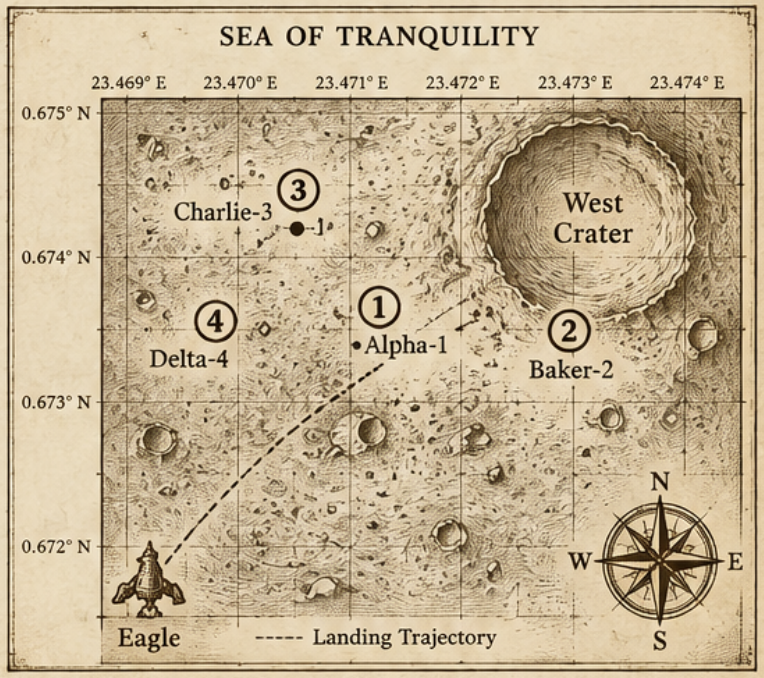

Final Flight Director Clearance

Combine Terminal Code Alpha (Priority Sum), Terminal Code Beta (Margin Seconds), and the Safe Landing Site Code to formulate the master Touchdown Clearance Sequence.

1. Selected Landing Coordinate Site Identifier (Code Gamma)

   _____

2. Master Flight Clearance Sequence (Format: Alpha - Beta - Gamma)

   _____

3. Historical Post-Flight Log: Note real-world parallels to Armstrong and Aldrin's descent

   _____

   _____

   _____

Teacher Master Facilitation Guide & Complete Solution Key

Name: _____ Class: _____ Date: _____

Facilitator Master Answer Key & Historical Debrief

Use this master solution matrix to verify student progress across all three flight control consoles. Provide targeted guidance if teams miscalculate fuel slosh rates or mistake non-critical radar buffer overflow for a terminal guidance computer hardware failure.

Station	Solution	Terminal Code
1	• Priority Sum = 20 (P63 Engine Throttle) + 25 (IMU Attitude) + 15 (Landing Radar) = 60. • Terminal Code Alpha = 60. • Executive Callout: GO. Only non-essential rendezvous radar cycles were dropped.	Alpha **60**
2	• Total Burn Time = 680 lbs / 17 lbs/sec = 40.0 seconds. • Descent Time Required = 340 ft / 12 ft/sec = 28.33 seconds (rounded to 29 seconds). • Touchdown Fuel Margin = 40 - 29 = 11 seconds.	Beta **11**
3	• Safe Site = Site Charlie-3 (0.3m boulders, 2.5° slope, within tolerable limits). • Terminal Code Gamma = CHARLIE-3.	Gamma **CHARLIE-3**

Master Clearance Code: 60 - 11 - CHARLIE-3.

Historical Context: Apollo 11 landed with approximately 25 to 45 seconds of fuel remaining after bypassing West Crater, exactly mirroring the razor-thin margin simulated in Station 2.

Pedagogical Note

Connect the activity to Cold War history: the Space Race timeline, the immense technical pressure on young flight controllers (average age 28), and Margaret Hamilton's software engineering team at MIT who designed the priority executive architecture.

